Contare le figure

Nome:

Conta il numero delle forme in ogni quadrato.

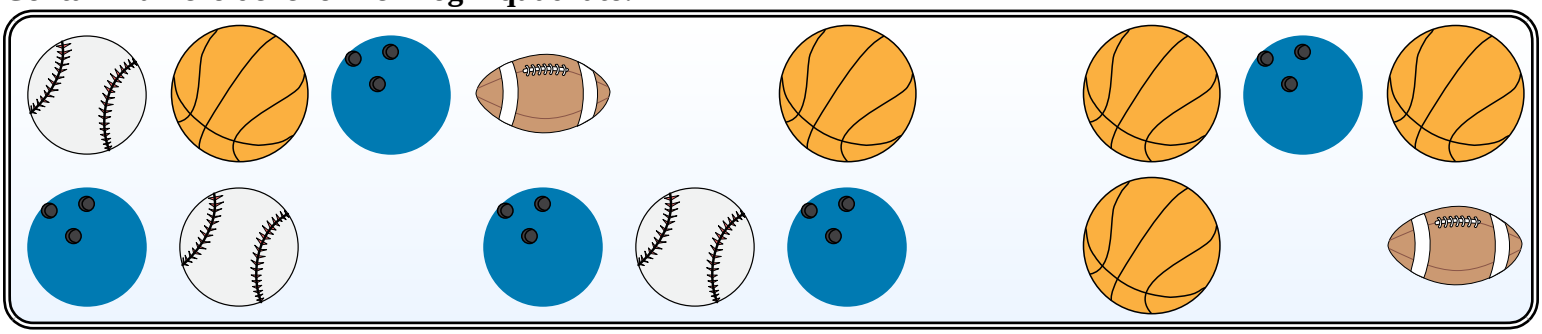

Es) = 3

1) = _____

2) = _____

3) = _____



4) = _____

5) = _____

6) = _____

7) = _____



8) = _____

9) = _____

10) = _____

11) = _____

1-10	91	82	73	64	55	45	36	27	18	9
11	0									

Contare le figure

Nome: **Soluzioni**

Conta il numero delle forme in ogni quadrato.

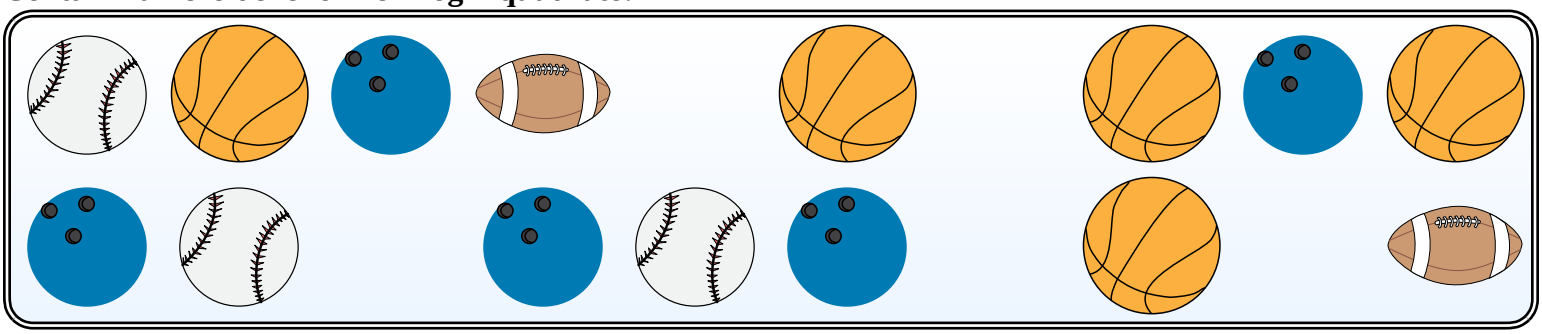

Es) = 3

1) = 5

2) = 5

3) = 2



4) = 4

5) = 2

6) = 6

7) = 2



8) = 3

9) = 4

10) = 4

11) = 3

1-10	91	82	73	64	55	45	36	27	18	9
11	0									