Trovare l'ora di inizio con una linea numerica Nome:

Risolvi ogni problema.

1) Inizio: _____
Elapsed: 2 ore e 20 minuti
Fine: 9:25

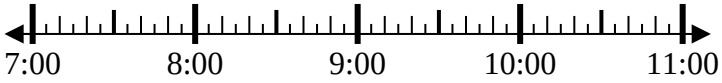

2) Inizio: _____
Elapsed: 2 ore e 20 minuti
Fine: 7:45

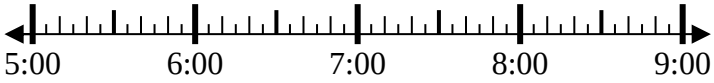

3) Inizio: _____
Elapsed: 1 ora e 35 minuti
Fine: 5:50

4) Inizio: _____
Elapsed: 2 ore e 40 minuti
Fine: 2:45

5) Inizio: _____
Elapsed: 1 ora e 45 minuti
Fine: 11:50

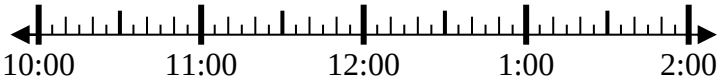

6) Inizio: _____
Elapsed: 2 ore e 15 minuti
Fine: 2:00

7) Inizio: _____
Elapsed: 1 ora e 40 minuti
Fine: 7:05

8) Inizio: _____
Elapsed: 1 ora e 15 minuti
Fine: 2:40

Risposte

1. _____
2. _____
3. _____
4. _____
5. _____
6. _____
7. _____
8. _____

1-8	88	75	63	50	38	25	13	0

Trovare l'ora di inizio con una linea numerica

Nome: **Soluzioni**

Risolvi ogni problema.

1) Inizio: 7:05
Elapsed: 2 ore e 20 minuti
Fine: 9:25

2) Inizio: 5:25
Elapsed: 2 ore e 20 minuti
Fine: 7:45

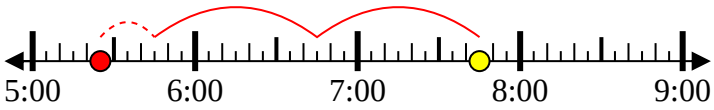

3) Inizio: 4:15
Elapsed: 1 ora e 35 minuti
Fine: 5:50

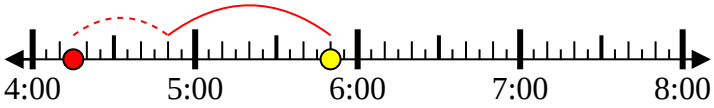

4) Inizio: 12:05
Elapsed: 2 ore e 40 minuti
Fine: 2:45

5) Inizio: 10:05
Elapsed: 1 ora e 45 minuti
Fine: 11:50

6) Inizio: 11:45
Elapsed: 2 ore e 15 minuti
Fine: 2:00

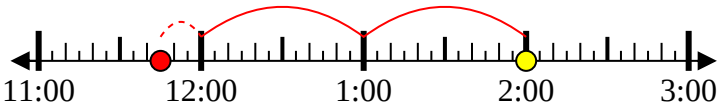

7) Inizio: 5:25
Elapsed: 1 ora e 40 minuti
Fine: 7:05

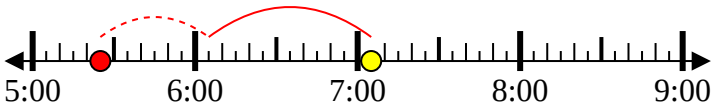

8) Inizio: 1:25
Elapsed: 1 ora e 15 minuti
Fine: 2:40

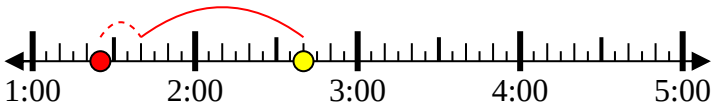

Risposte

1. **7:05**
2. **5:25**
3. **4:15**
4. **12:05**
5. **10:05**
6. **11:45**
7. **5:25**
8. **1:25**

1-8	88	75	63	50	38	25	13	0