Trovare l'ora di fine con una linea dei numeri

Nome:

Risolvi ogni problema.

1) Inizio: 11:45
Elapsed: 2 ore e 35 minuti
Fine: _____

2) Inizio: 7:20
Elapsed: 2 ore e 45 minuti
Fine: _____

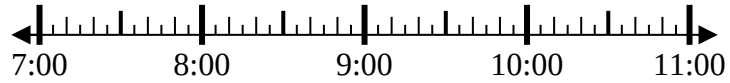

3) Inizio: 11:50
Elapsed: 1 ora e 35 minuti
Fine: _____

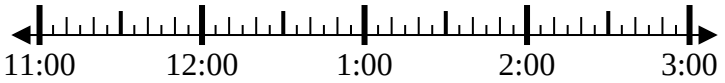

4) Inizio: 3:15
Elapsed: 2 ore e 15 minuti
Fine: _____

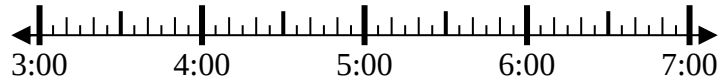

5) Inizio: 4:35
Elapsed: 1 ora e 15 minuti
Fine: _____

6) Inizio: 8:25
Elapsed: 1 ora e 30 minuti
Fine: _____

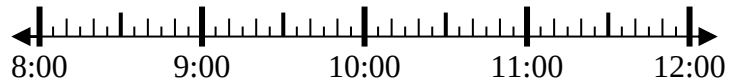

7) Inizio: 8:50
Elapsed: 2 ore e 20 minuti
Fine: _____

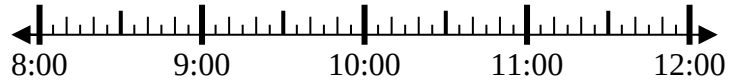

8) Inizio: 10:05
Elapsed: 1 ora e 25 minuti
Fine: _____

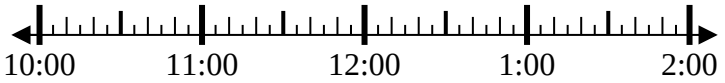

Risposte

1. _____
2. _____
3. _____
4. _____
5. _____
6. _____
7. _____
8. _____

1-8	88	75	63	50	38	25	13	0

Trovare l'ora di fine con una linea dei numeri Nome: **Soluzioni**

Risolvi ogni problema.

1) Inizio: 11:45
Elapsed: 2 ore e 35 minuti
Fine: 2:20

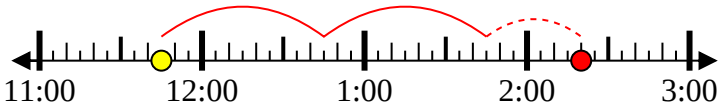

2) Inizio: 7:20
Elapsed: 2 ore e 45 minuti
Fine: 10:05

3) Inizio: 11:50
Elapsed: 1 ora e 35 minuti
Fine: 1:25

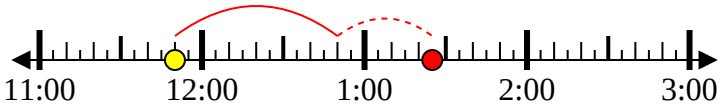

4) Inizio: 3:15
Elapsed: 2 ore e 15 minuti
Fine: 5:30

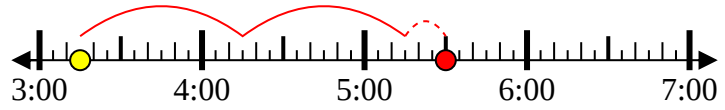

5) Inizio: 4:35
Elapsed: 1 ora e 15 minuti
Fine: 5:50

6) Inizio: 8:25
Elapsed: 1 ora e 30 minuti
Fine: 9:55

7) Inizio: 8:50
Elapsed: 2 ore e 20 minuti
Fine: 11:10

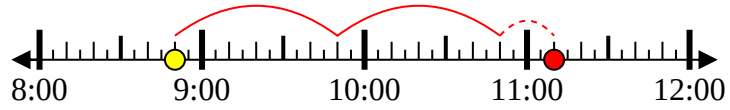

8) Inizio: 10:05
Elapsed: 1 ora e 25 minuti
Fine: 11:30

Risposte

1. 2:20
2. 10:05
3. 1:25
4. 5:30
5. 5:50
6. 9:55
7. 11:10
8. 11:30