Trovare il tempo trascorso con una linea dei numeri Nome:

Risolvi ogni problema.

1) Inizio: 10:50

Elapsed: _____

Fine: 1:20

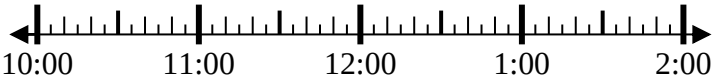

2) Inizio: 5:10

Elapsed: _____

Fine: 6:35

3) Inizio: 11:40

Elapsed: _____

Fine: 1:15

4) Inizio: 4:20

Elapsed: _____

Fine: 6:35

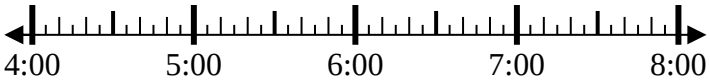

5) Inizio: 5:15

Elapsed: _____

Fine: 7:40

6) Inizio: 10:20

Elapsed: _____

Fine: 12:55

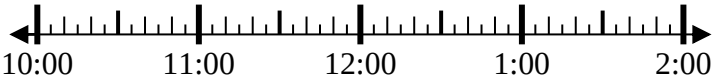

7) Inizio: 12:45

Elapsed: _____

Fine: 3:35

8) Inizio: 10:40

Elapsed: _____

Fine: 12:10

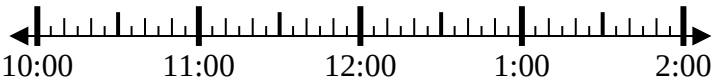

Risposte

1. _____
2. _____
3. _____
4. _____
5. _____
6. _____
7. _____
8. _____

1-8	88	75	63	50	38	25	13	0

Trovare il tempo trascorso con una linea dei numeri Nome: **Soluzioni**

Risolvi ogni problema.

1) Inizio: 10:50

Elapsed: 2 ore e 30 minuti

Fine: 1:20

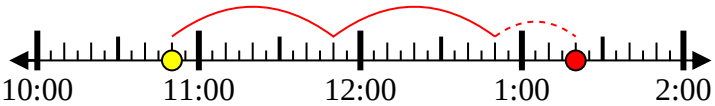

2) Inizio: 5:10

Elapsed: 1 ora e 25 minuti

Fine: 6:35

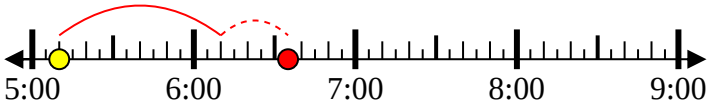

3) Inizio: 11:40

Elapsed: 1 ora e 35 minuti

Fine: 1:15

4) Inizio: 4:20

Elapsed: 2 ore e 15 minuti

Fine: 6:35

5) Inizio: 5:15

Elapsed: 2 ore e 25 minuti

Fine: 7:40

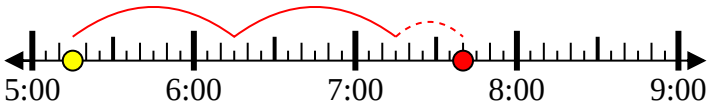

6) Inizio: 10:20

Elapsed: 2 ore e 35 minuti

Fine: 12:55

7) Inizio: 12:45

Elapsed: 2 ore e 50 minuti

Fine: 3:35

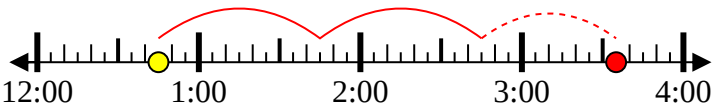

8) Inizio: 10:40

Elapsed: 1 ora e 30 minuti

Fine: 12:10

Risposte

1. **2 ore e 30 minuti**
2. **1 ora e 25 minuti**
3. **1 ora e 35 minuti**
4. **2 ore e 15 minuti**
5. **2 ore e 25 minuti**
6. **2 ore e 35 minuti**
7. **2 ore e 50 minuti**
8. **1 ora e 30 minuti**

1-8	88	75	63	50	38	25	13	0