Disegna la lancetta delle ore e dei minuti sull'orologio in modo che rappresenti l'ora indicata.

1) 11:55

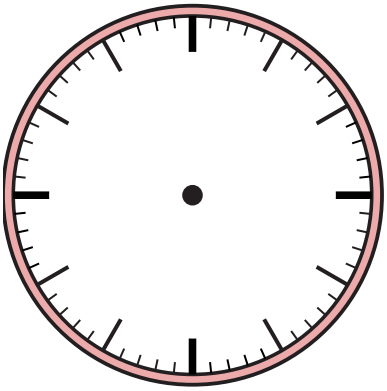

2) 7:15

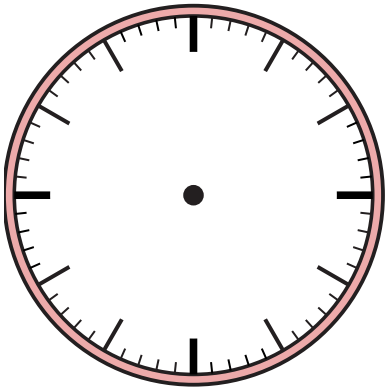

3) 8:15

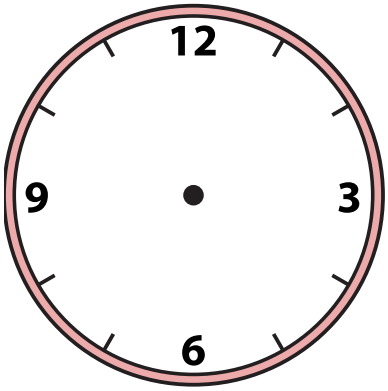

4) 10:17

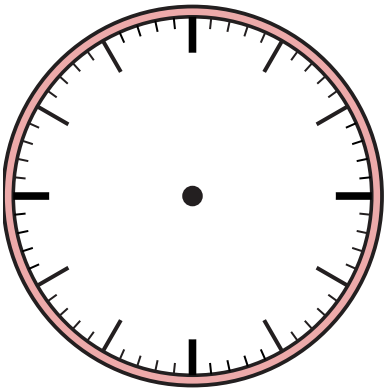

5) 8:29

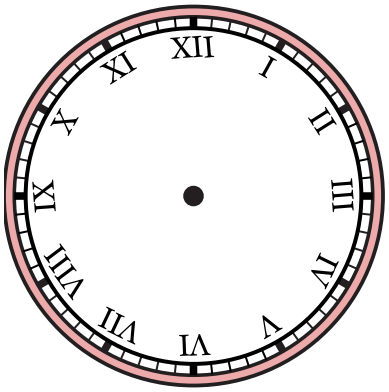

6) 2:09

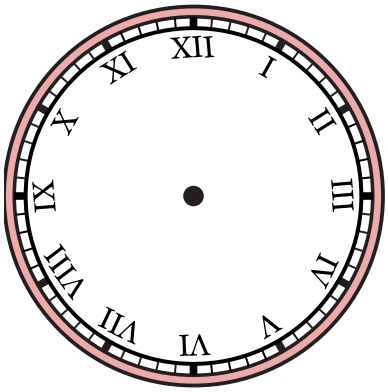

7) 12:43

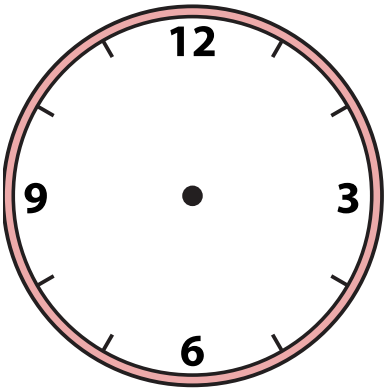

8) 4:16

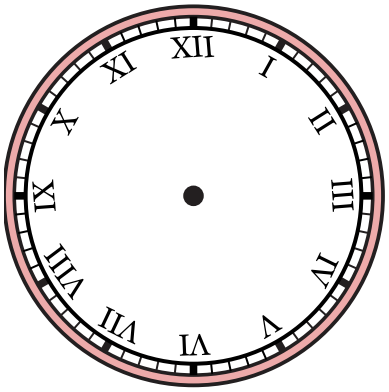

9) 12:50

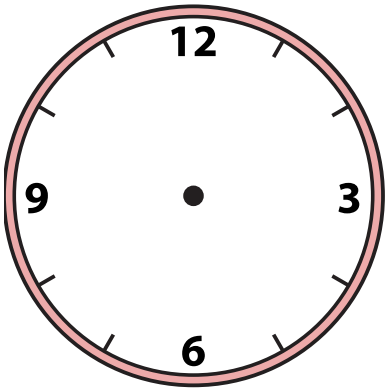

1-9	89	78	67	56	44	33	22	11	0

Disegna la lancetta delle ore e dei minuti sull'orologio in modo che rappresenti l'ora indicata.

1) 11:55

2) 7:15



3) 8:15



4) 10:17



5) 8:29



6) 2:09



7) 12:43



8) 4:16

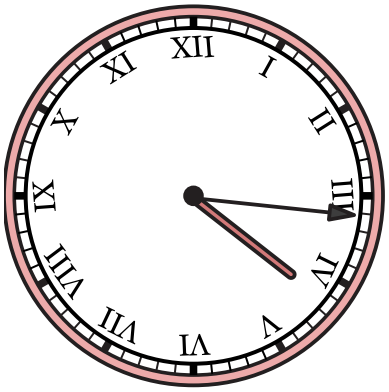

9) 12:50



1-9	89	78	67	56	44	33	22	11	0