Disegna la lancetta delle ore e dei minuti sull'orologio in modo che rappresenti l'ora indicata.

1) 12:00

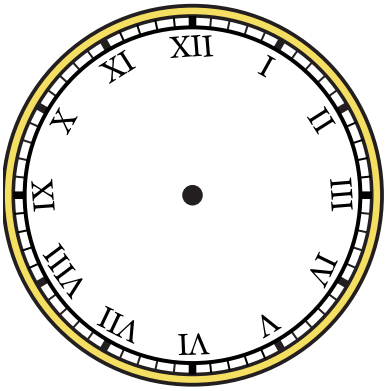

2) 9:15

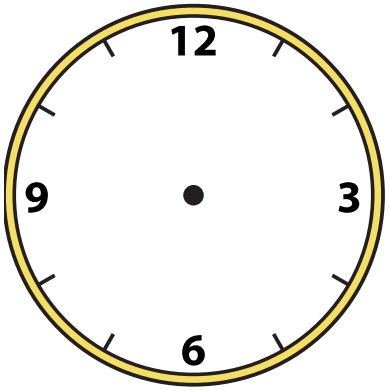

3) 8:00

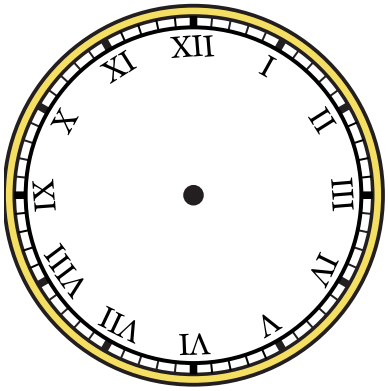

4) 2:00



5) 10:15



6) 4:30

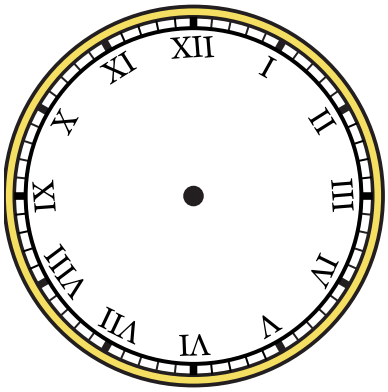

7) 5:30

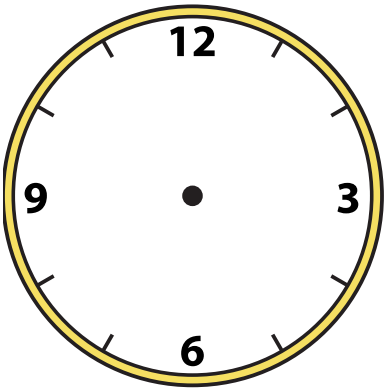

8) 11:30



9) 9:45

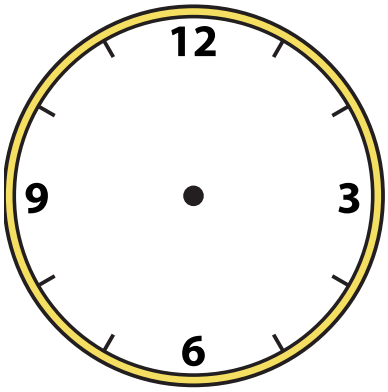

1-9	89	78	67	56	44	33	22	11	0

Disegna la lancetta delle ore e dei minuti sull'orologio in modo che rappresenti l'ora indicata.

1) 12:00

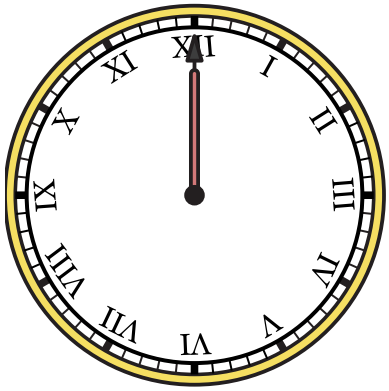

2) 9:15



3) 8:00



4) 2:00



5) 10:15



6) 4:30



7) 5:30



8) 11:30

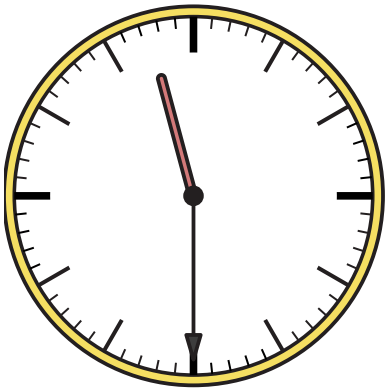

9) 9:45

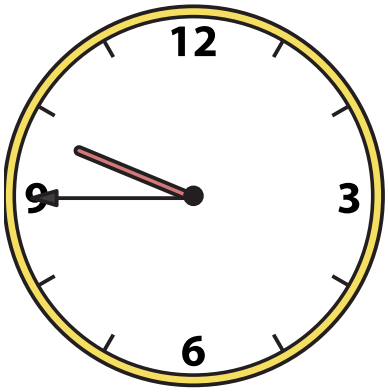

1-9	89	78	67	56	44	33	22	11	0