Collega i termometri alle temperature Nome:

Indica quale lettera risponde correttamente ad ogni domanda.

1) Quale termometro rappresenta correttamente la temperatura di 78°?

2) Quale termometro rappresenta correttamente la temperatura di 27°?

3) Quale termometro rappresenta correttamente la temperatura di 49°?

4) Quale termometro rappresenta correttamente la temperatura di 18°?

5) Quale termometro rappresenta correttamente la temperatura di 20°?

6) Quale termometro rappresenta correttamente la temperatura di 59°?

7) Quale termometro rappresenta correttamente la temperatura di 75°?

8) Quale termometro rappresenta correttamente la temperatura di 25°?

9) Quale termometro rappresenta correttamente la temperatura di 115°?

10) Quale termometro rappresenta correttamente la temperatura di 53°?

A.

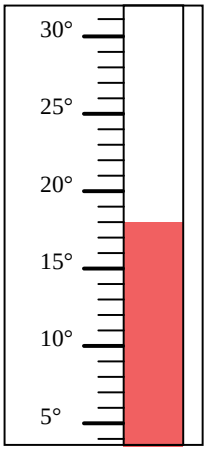

B.

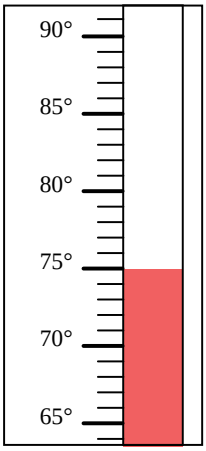

C.

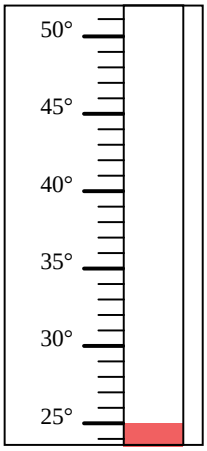

D.

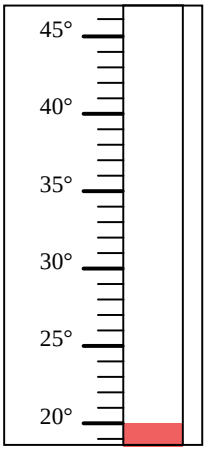

E.

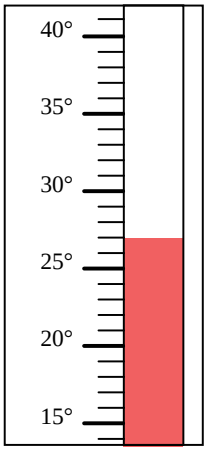

F.

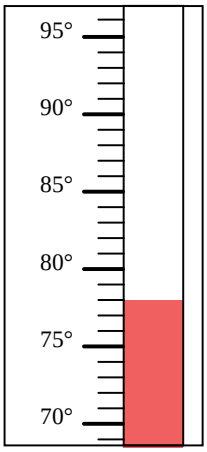

G.

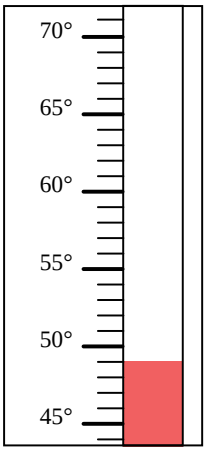

H.

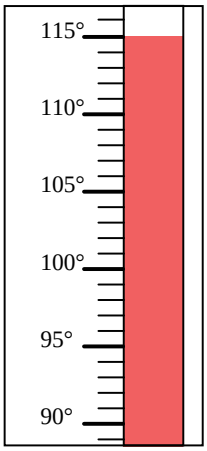

I.

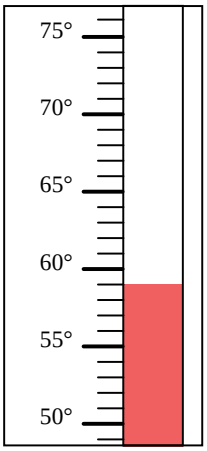

J.

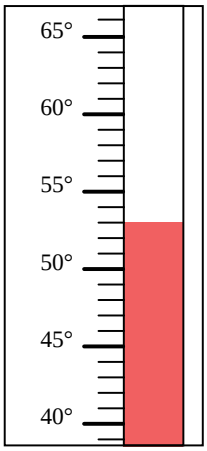

Risposte

1. _____
2. _____
3. _____
4. _____
5. _____
6. _____
7. _____
8. _____
9. _____
10. _____

1-10	90	80	70	60	50	40	30	20	10	0

Collega i termometri alle temperature

Nome: **Soluzioni**

Indica quale lettera risponde correttamente ad ogni domanda.

1) Quale termometro rappresenta correttamente la temperatura di 78°?

2) Quale termometro rappresenta correttamente la temperatura di 27°?

3) Quale termometro rappresenta correttamente la temperatura di 49°?

4) Quale termometro rappresenta correttamente la temperatura di 18°?

5) Quale termometro rappresenta correttamente la temperatura di 20°?

6) Quale termometro rappresenta correttamente la temperatura di 59°?

7) Quale termometro rappresenta correttamente la temperatura di 75°?

8) Quale termometro rappresenta correttamente la temperatura di 25°?

9) Quale termometro rappresenta correttamente la temperatura di 115°?

10) Quale termometro rappresenta correttamente la temperatura di 53°?

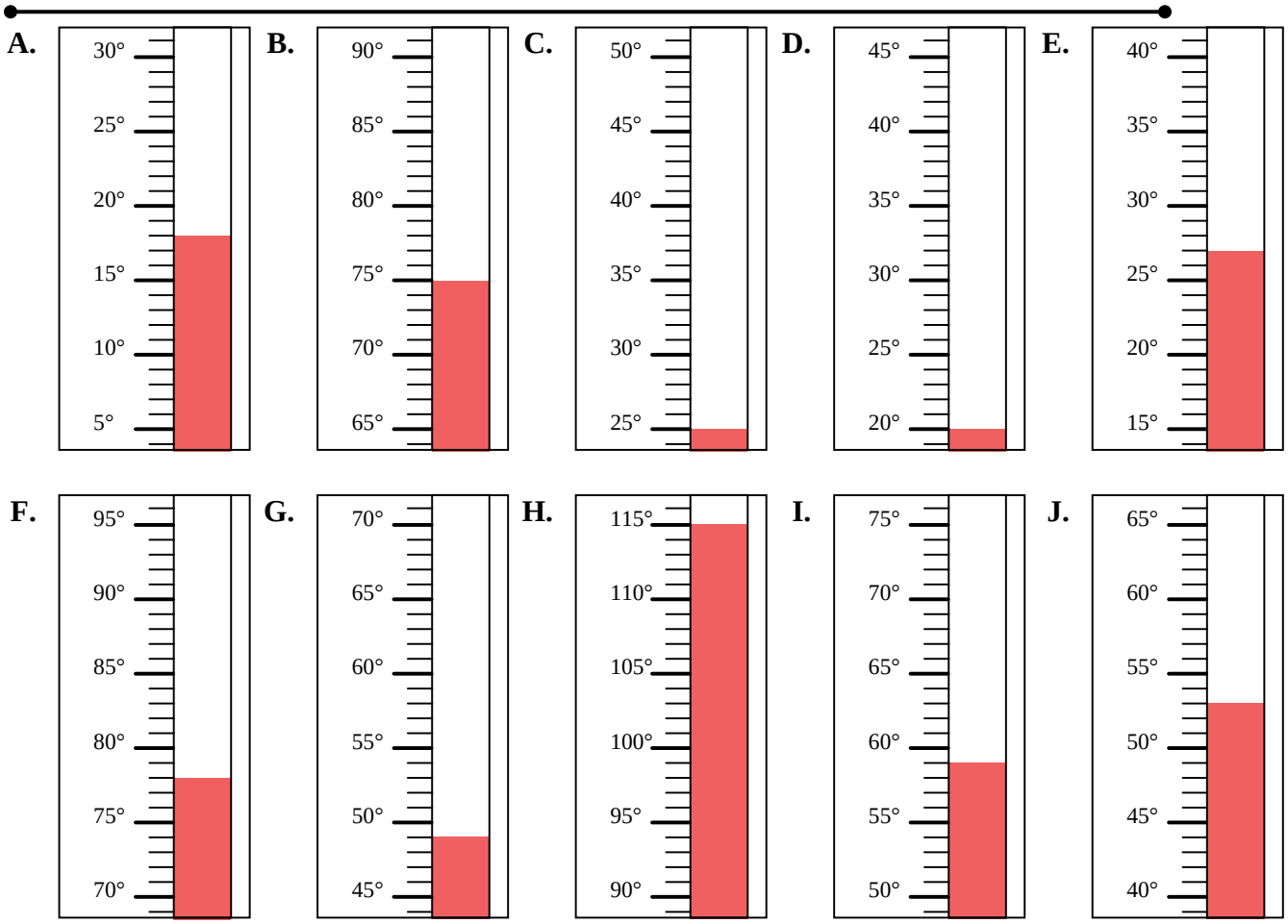

Risposte

1. F
2. E
3. G
4. A
5. D
6. I
7. B
8. C
9. H
10. J

1-10	90	80	70	60	50	40	30	20	10	0