Determina le trasformazioni delle forme

Nome:

Indica se la forma è stata traslata (spostata), ruotata (girata) o specchiata (capovolta).

1)

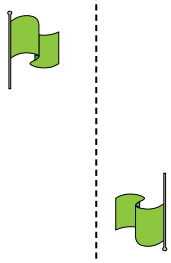

2)

3)

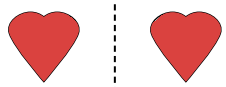

4)

5)

6)

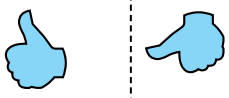

7)



8)

9)

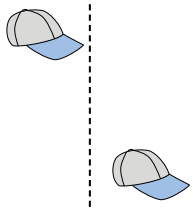

10)

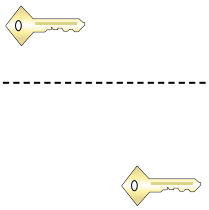

11)



12)

13)

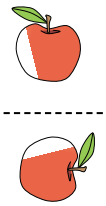

14)



15)



Risposte

1. _____
2. _____
3. _____
4. _____
5. _____
6. _____
7. _____
8. _____
9. _____
10. _____
11. _____
12. _____
13. _____
14. _____
15. _____

1-10	93	87	80	73	67	60	53	47	40	33
11-15	27	20	13	7	0					

Determina le trasformazioni delle forme

Nome: **Soluzioni**

Indica se la forma è stata traslata (spostata), ruotata (girata) o specchiata (capovolta).

1)

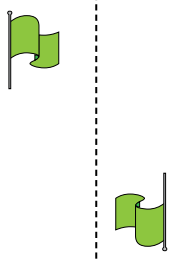

2)

3)

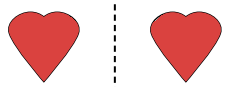

4)

5)

6)

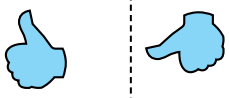

7)



8)

9)

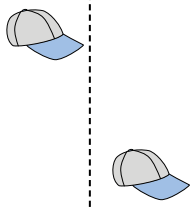

10)

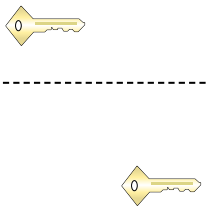

11)



12)

13)

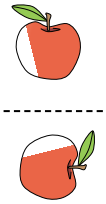

14)

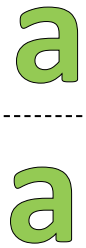

15)



Risposte

1. girata
2. capovolta
3. capovolta
4. capovolta
5. spostata
6. girata
7. spostata
8. capovolta
9. spostata
10. spostata
11. capovolta
12. girata
13. girata
14. spostata
15. girata

1-10	93	87	80	73	67	60	53	47	40	33
11-15	27	20	13	7	0					