Ruota ogni forma. Rispondi con le nuove coordinate

θ = Ângulo de rotação

Fórmula de rotación
x1 = x×cos(θ) - y×sin(θ)
y1 = x×sin(θ) + y×cos(θ)

En el ejemplo de la derecha, la forma está en las coordenadas (1,4).
Vamos encontrar as coordenadas se girarmos a forma em 60°.

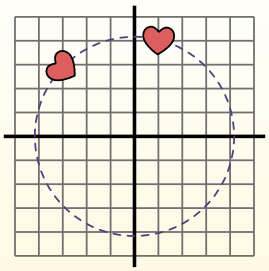

1. x1 = 1×cos(60) - 4×sin(60)
y1 = 1×sin(60) + 4×cos(60)

2. x1 = 1×0.5 - 4×0.87
y1 = 1×0.87 + 4×0.5

3. x1 = 0.5 - 3.48
y1 = 0.87 + 2

4. x1 = -2.98
y1 = 2.87

5. Al observar la forma, podemos ver que girado 60 ° está en (-2.98, 2.87).

1) Ruota la forma 203° attorno al punto (0,0).



2) Ruota la forma -120° attorno al punto (0,0).

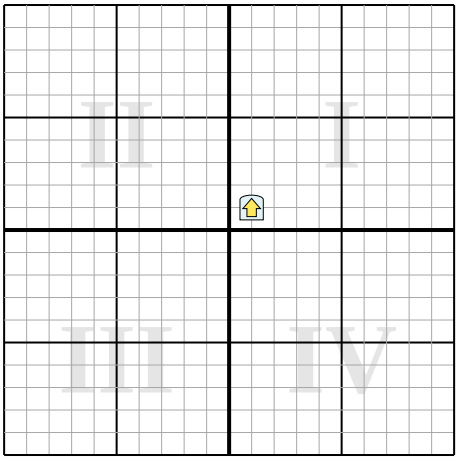

3) Ruota la forma 183° attorno al punto (0,0).



4) Ruota la forma -35° attorno al punto (0,0).

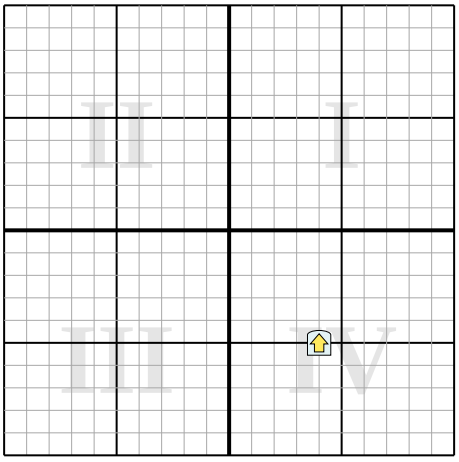

Risposte

1. _____
2. _____
3. _____
4. _____

1-4	75	50	25	0

Ruota ogni forma. Rispondi con le nuove coordinate

θ = Ângulo de rotação

Fórmula de rotación
x1 = x×cos(θ) - y×sin(θ)
y1 = x×sin(θ) + y×cos(θ)

En el ejemplo de la derecha, la forma está en las coordenadas (1,4).
Vamos encontrar as coordenadas se girarmos a forma em 60°.

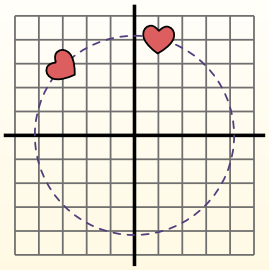

1. x1 = 1×cos(60) - 4×sin(60)
y1 = 1×sin(60) + 4×cos(60)

2. x1 = 1×0.5 - 4×0.87
y1 = 1×0.87 + 4×0.5

3. x1 = 0.5 - 3.48
y1 = 0.87 + 2

4. x1 = -2.98
y1 = 2.87

5. Al observar la forma, podemos ver que girado 60 ° está en (-2.98, 2.87).

1) Ruota la forma 203° attorno al punto (0,0).

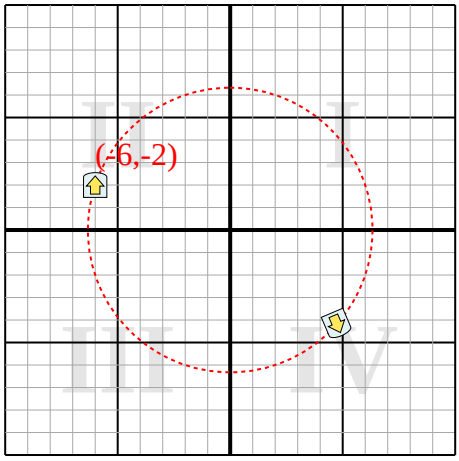

2) Ruota la forma -120° attorno al punto (0,0).

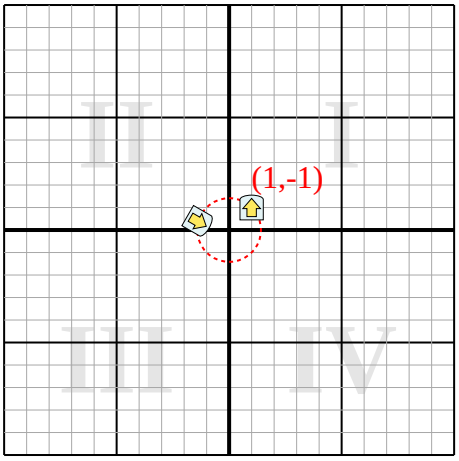

3) Ruota la forma 183° attorno al punto (0,0).

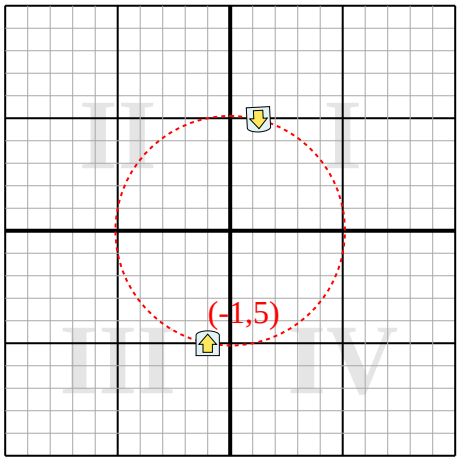

4) Ruota la forma -35° attorno al punto (0,0).

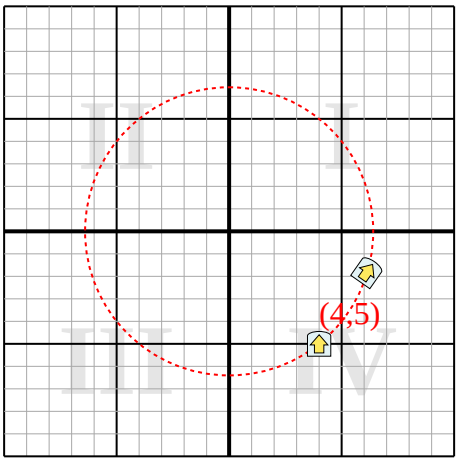

Risposte

1. **(4,7,-4,2)**
2. **(-1,4,0,4)**
3. **(1,3,4,9)**
4. **(6,1,-1,8)**

1-4	75	50	25	0