Mostrare la distanza con una linea numerica Nome:

Usa le linee dei numeri per mostrare ogni espressione e risolvere.

Es) Inizia da -4 e aggiungi 14

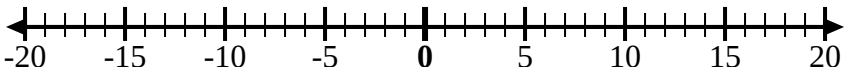

1) Inizia da 4 e aggiungi -13

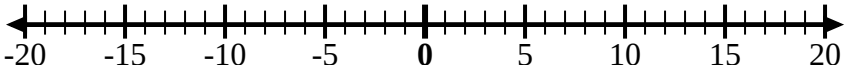

2) Inizia da -6 e aggiungi 7

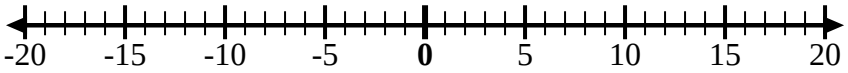

3) Inizia da -1 e aggiungi 3

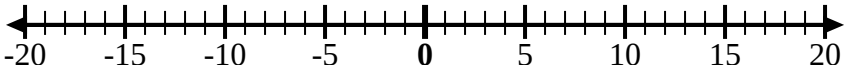

4) Inizia da -8 e aggiungi -2

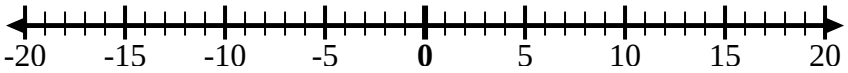

5) Inizia da 5 e aggiungi -5

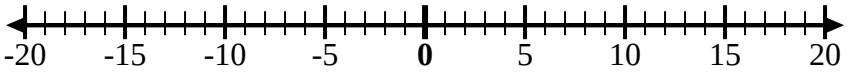

6) Inizia da -3 e aggiungi 2

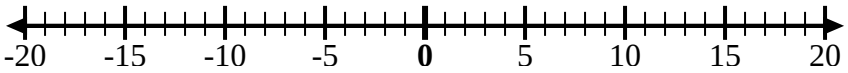

7) Inizia da -7 e aggiungi -2

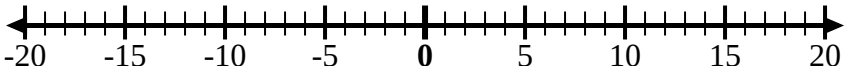

8) Inizia da -2 e aggiungi 8

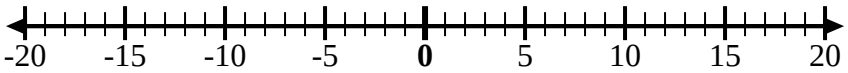

9) Inizia da 1 e aggiungi -10

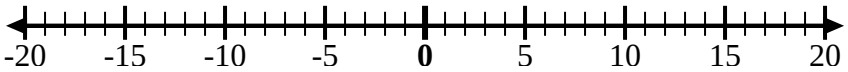

10) Inizia da -2 e aggiungi -7

11) Inizia da -6 e aggiungi -4

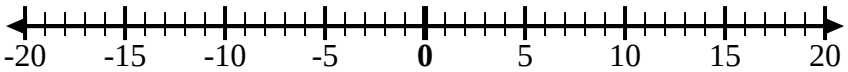

12) Inizia da -4 e aggiungi 9

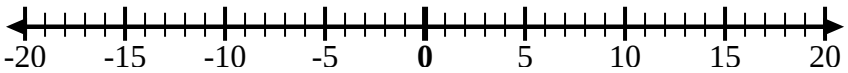

Risposte

Es. **-4 + 14 = 10**

1. _____
2. _____
3. _____
4. _____
5. _____
6. _____
7. _____
8. _____
9. _____
10. _____
11. _____
12. _____

Mostrare la distanza con una linea numerica Nome: **Soluzioni**

Usa le linee dei numeri per mostrare ogni espressione e risolvere.

Es) Inizia da -4 e aggiungi 14

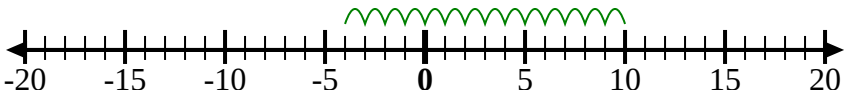

1) Inizia da 4 e aggiungi -13

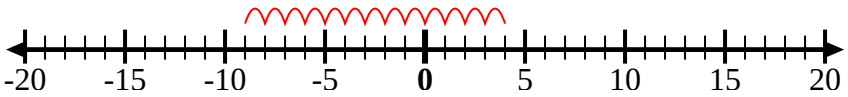

2) Inizia da -6 e aggiungi 7

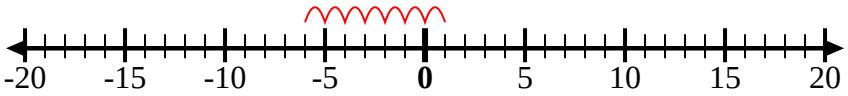

3) Inizia da -1 e aggiungi 3

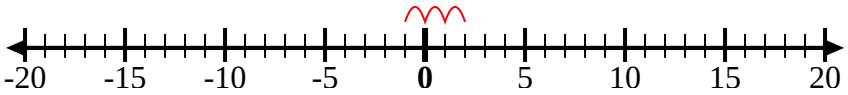

4) Inizia da -8 e aggiungi -2

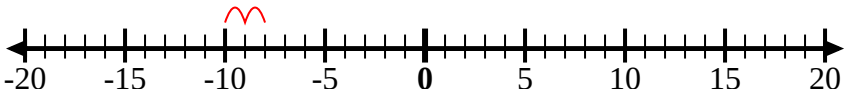

5) Inizia da 5 e aggiungi -5

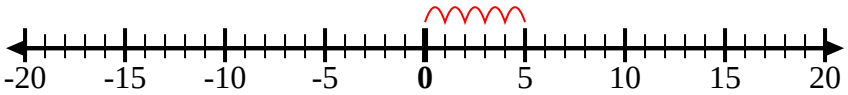

6) Inizia da -3 e aggiungi 2

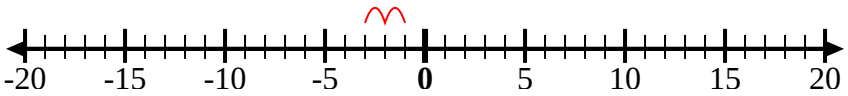

7) Inizia da -7 e aggiungi -2

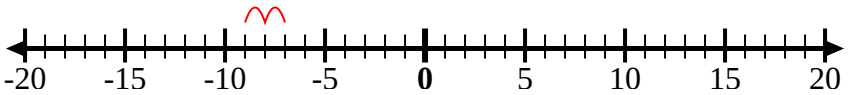

8) Inizia da -2 e aggiungi 8

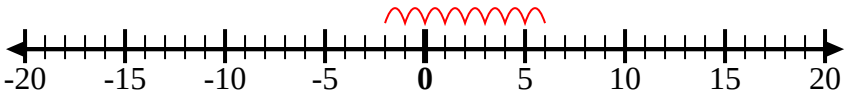

9) Inizia da 1 e aggiungi -10

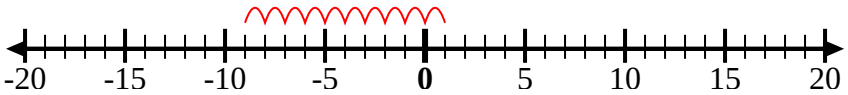

10) Inizia da -2 e aggiungi -7

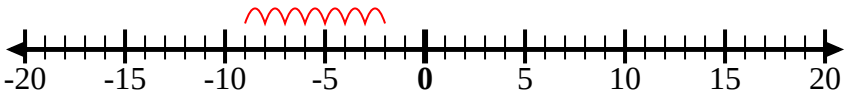

11) Inizia da -6 e aggiungi -4

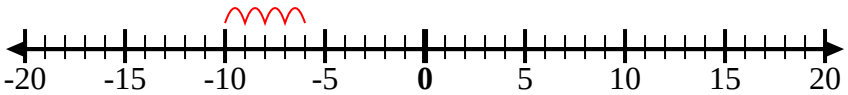

12) Inizia da -4 e aggiungi 9

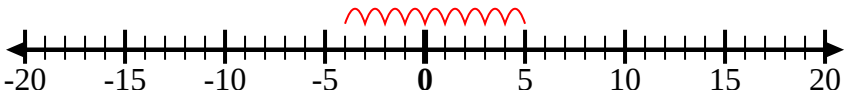

Risposte

Es. **-4 + 14 = 10**

1. **4 + -13 = -9**
2. **-6 + 7 = 1**
3. **-1 + 3 = 2**
4. **-8 + -2 = -10**
5. **5 + -5 = 0**
6. **-3 + 2 = -1**
7. **-7 + -2 = -9**
8. **-2 + 8 = 6**
9. **1 + -10 = -9**
10. **-2 + -7 = -9**
11. **-6 + -4 = -10**
12. **-4 + 9 = 5**

1-10	92	83	75	67	58	50	42	33	25	17
11-12	8	0								