Addizioni e sotrazioni con i numeri negativi Nome:

Risolvi ogni operazione. Usa la linea numerata se necessario.

1) (-4) - (-1) = _____

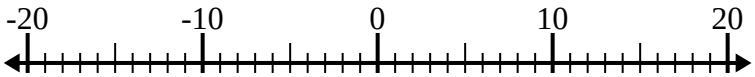

2) (-11) + 14 = _____

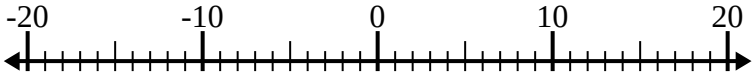

3) (-8) - 12 = _____

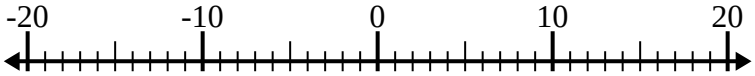

4) 4 + (-5) = _____

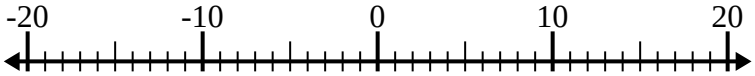

5) 11 - (-3) = _____

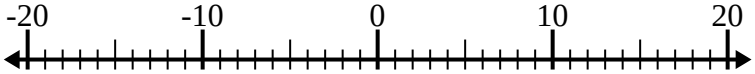

6) (-13) - 6 = _____

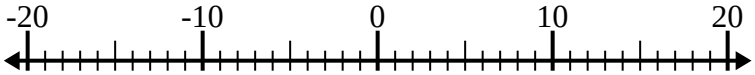

7) 12 + (-8) = _____

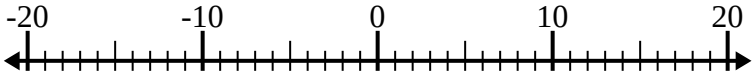

8) (-7) - (-12) = _____

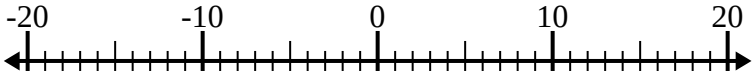

9) (-3) + (-1) = _____

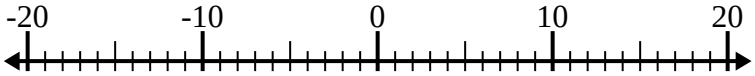

10) (-5) + 2 = _____

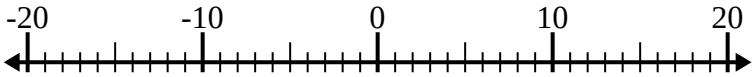

Risposte

1. _____
2. _____
3. _____
4. _____
5. _____
6. _____
7. _____
8. _____
9. _____
10. _____

1-10	90	80	70	60	50	40	30	20	10	0

Addizioni e sotrazioni con i numeri negativi Nome: **Soluzioni**

Risolvi ogni operazione. Usa la linea numerata se necessario.

1) (-4) - (-1) = -3

2) (-11) + 14 = 3

3) (-8) - 12 = -20

4) 4 + (-5) = -1

5) 11 - (-3) = 14

6) (-13) - 6 = -19

7) 12 + (-8) = 4

8) (-7) - (-12) = 5

9) (-3) + (-1) = -4

10) (-5) + 2 = -3

Risposte

1. -3
2. 3
3. -20
4. -1
5. 14
6. -19
7. 4
8. 5
9. -4
10. -3

1-10	90	80	70	60	50	40	30	20	10	0