Riscrivi le moltiplicazioni (graficamente)

Nome:

Scrivi ogni blocco sotto forma di moltiplicazione e calcola il risultato.

Es)

1)

2)



3)

4)



5)

6)



7)



8)

9)

10)

11)



Risposte

Es. 9 × 3 = 27

1. _____
2. _____
3. _____
4. _____
5. _____
6. _____
7. _____
8. _____
9. _____
10. _____
11. _____

Riscrivi le moltiplicazioni (graficamente) Nome: **Soluzioni**

Scrivi ogni blocco sotto forma di moltiplicazione e calcola il risultato.

Es)

1)

2)



3)

4)



5)

6)



7)



8)

9)

10)

11)



Risposte

Es. **9 × 3 = 27**

1. **8 × 4 = 32**
2. **9 × 9 = 81**
3. **4 × 2 = 8**
4. **8 × 10 = 80**
5. **8 × 9 = 72**
6. **7 × 6 = 42**
7. **9 × 10 = 90**
8. **3 × 9 = 27**
9. **3 × 4 = 12**
10. **2 × 4 = 8**
11. **8 × 5 = 40**

1-10	91	82	73	64	55	45	36	27	18	9
11	0									