Riscrivi le moltiplicazioni (graficamente) Nome:

**Scrivi ogni blocco sotto forma di moltiplicazione e calcola il risultato.**

**Es)**



**1)**



**2)**

**3)**

**4)**

**5)**



**6)**

**7)**



**8)**



**9)**



**10)**



**11)**



## Risposte

Es. **6 × 7 = 42**

1. _____
2. _____
3. _____
4. _____
5. _____
6. _____
7. _____
8. _____
9. _____
10. _____
11. _____



| | | | | | | | | | | |
|---|---|---|---|---|---|---|---|---|---|---|
| 1-10 | 91 | 82 | 73 | 64 | 55 | 45 | 36 | 27 | 18 | 9 |
| 11 | 0 | | | | | | | | | |

Riscrivi le moltiplicazioni (graficamente) Nome: **Soluzioni**

**Scrivi ogni blocco sotto forma di moltiplicazione e calcola il risultato.**

**Es)**



**1)**



**2)**

**3)**

**4)**

**5)**



**6)**

**7)**



**8)**



**9)**



**10)**



**11)**



## Risposte

Es. **6 × 7 = 42**

1. **7 × 10 = 70**
2. **3 × 4 = 12**
3. **3 × 7 = 21**
4. **5 × 4 = 20**
5. **7 × 4 = 28**
6. **4 × 9 = 36**
7. **4 × 10 = 40**
8. **2 × 8 = 16**
9. **8 × 9 = 72**
10. **4 × 4 = 16**
11. **7 × 9 = 63**



| | | | | | | | | | | |
|---|---|---|---|---|---|---|---|---|---|---|
| 1-10 | 91 | 82 | 73 | 64 | 55 | 45 | 36 | 27 | 18 | 9 |
| 11 | 0 | | | | | | | | | |