Riscrivi le moltiplicazioni (graficamente) Nome:

Scrivi ogni blocco sotto forma di moltiplicazione e calcola il risultato.

Es)



1)



2)

3)

4)

5)



6)

7)



8)



9)



10)



11)



Risposte

Es. **6 × 7 = 42**

1. _____
2. _____
3. _____
4. _____
5. _____
6. _____
7. _____
8. _____
9. _____
10. _____
11. _____

1-10	91	82	73	64	55	45	36	27	18	9
11	0									

Riscrivi le moltiplicazioni (graficamente) Nome: **Soluzioni**

Scrivi ogni blocco sotto forma di moltiplicazione e calcola il risultato.

Es)



1)



2)

3)

4)

5)



6)

7)



8)



9)



10)



11)



Risposte

Es. **6 × 7 = 42**

1. **7 × 10 = 70**
2. **3 × 4 = 12**
3. **3 × 7 = 21**
4. **5 × 4 = 20**
5. **7 × 4 = 28**
6. **4 × 9 = 36**
7. **4 × 10 = 40**
8. **2 × 8 = 16**
9. **8 × 9 = 72**
10. **4 × 4 = 16**
11. **7 × 9 = 63**

1-10	91	82	73	64	55	45	36	27	18	9
11	0									