Riscrivi le moltiplicazioni (graficamente) Nome:

**Scrivi ogni blocco sotto forma di moltiplicazione e calcola il risultato.**

**Es)**

**1)**

**2)**



**3)**

**4)**



**5)**

**6)**

**7)**

**8)**

**9)**



**10)**

**11)**



## Risposte

Es. **5 × 8 = 40**

1. _____
2. _____
3. _____
4. _____
5. _____
6. _____
7. _____
8. _____
9. _____
10. _____
11. _____



| | | | | | | | | | | |
|---|---|---|---|---|---|---|---|---|---|---|
| 1-10 | 91 | 82 | 73 | 64 | 55 | 45 | 36 | 27 | 18 | 9 |
| 11 | 0 | | | | | | | | | |

Riscrivi le moltiplicazioni (graficamente) Nome: **Soluzioni**

**Scrivi ogni blocco sotto forma di moltiplicazione e calcola il risultato.**

**Es)**

**1)**

**2)**



**3)**

**4)**



**5)**

**6)**

**7)**

**8)**

**9)**

**10)**

**11)**



## Risposte

Es. **5 × 8 = 40**

1. **10 × 5 = 50**
2. **4 × 5 = 20**
3. **2 × 8 = 16**
4. **3 × 9 = 27**
5. **7 × 2 = 14**
6. **4 × 4 = 16**
7. **2 × 2 = 4**
8. **8 × 2 = 16**
9. **7 × 3 = 21**
10. **4 × 2 = 8**
11. **10 × 2 = 20**



| | | | | | | | | | | |
|---|---|---|---|---|---|---|---|---|---|---|
| 1-10 | 91 | 82 | 73 | 64 | 55 | 45 | 36 | 27 | 18 | 9 |
| 11 | 0 | | | | | | | | | |