Riscrivi le moltiplicazioni (graficamente) Nome:

Scrivi ogni blocco sotto forma di moltiplicazione e calcola il risultato.

Es)

1)

2)



3)

4)



5)

6)

7)

8)

9)



10)

11)



Risposte

Es. **5 × 8 = 40**

1. _____
2. _____
3. _____
4. _____
5. _____
6. _____
7. _____
8. _____
9. _____
10. _____
11. _____

1-10	91	82	73	64	55	45	36	27	18	9
11	0									

Riscrivi le moltiplicazioni (graficamente) Nome: **Soluzioni**

Scrivi ogni blocco sotto forma di moltiplicazione e calcola il risultato.

Es)

1)

2)



3)

4)



5)

6)

7)

8)

9)

10)

11)



Risposte

Es. **5 × 8 = 40**

1. **10 × 5 = 50**
2. **4 × 5 = 20**
3. **2 × 8 = 16**
4. **3 × 9 = 27**
5. **7 × 2 = 14**
6. **4 × 4 = 16**
7. **2 × 2 = 4**
8. **8 × 2 = 16**
9. **7 × 3 = 21**
10. **4 × 2 = 8**
11. **10 × 2 = 20**

1-10	91	82	73	64	55	45	36	27	18	9
11	0									