Moltiplicazioni con la linea numerata

Nome:

Usa la linea numerata per risolvere ogni operazione.

1) $4 \times 8 =$

$8 \times 4 =$

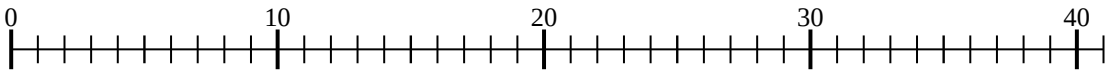

2) $3 \times 2 =$

$2 \times 3 =$

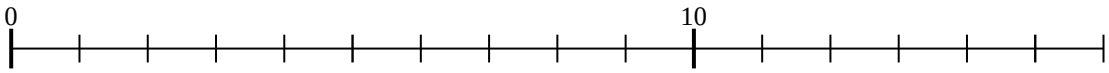

3) $4 \times 9 =$

$9 \times 4 =$

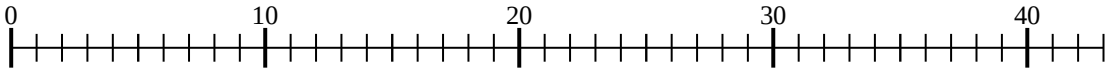

4) $3 \times 10 =$

$10 \times 3 =$

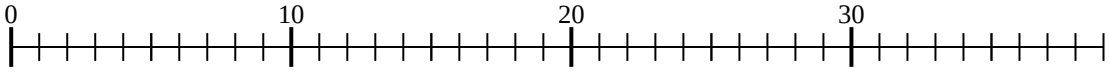

5) $5 \times 10 =$

$10 \times 5 =$

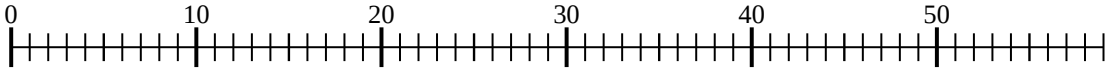

6) $5 \times 7 =$

$7 \times 5 =$

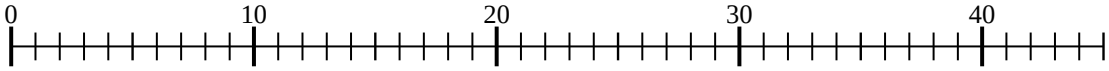

7) $2 \times 6 =$

$6 \times 2 =$

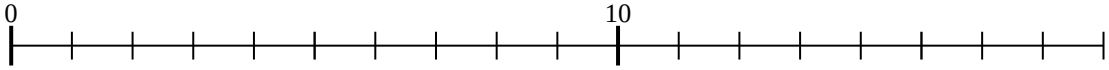

8) $5 \times 5 =$

$5 \times 5 =$

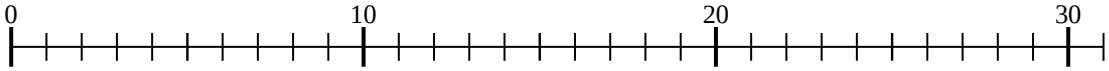

9) $5 \times 4 =$

$4 \times 5 =$

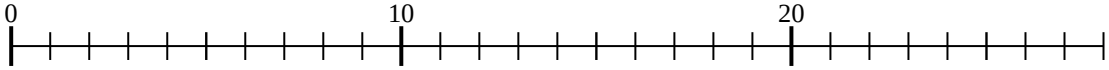

10) $3 \times 3 =$

$3 \times 3 =$

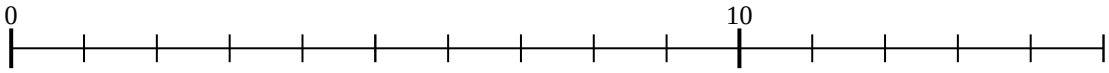

11) $2 \times 10 =$

$10 \times 2 =$

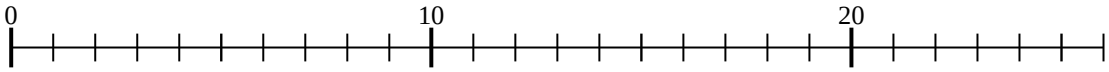

Risposte

1. _____
2. _____
3. _____
4. _____
5. _____
6. _____
7. _____
8. _____
9. _____
10. _____
11. _____

Moltiplicazioni con la linea numerata Nome: **Soluzioni**

Usa la linea numerata per risolvere ogni operazione.

1) 4 × 8 =
8 × 4 =

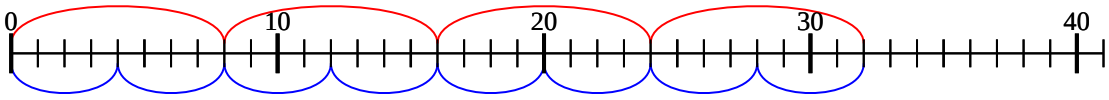

2) 3 × 2 =
2 × 3 =

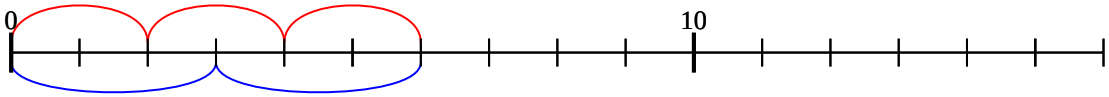

3) 4 × 9 =
9 × 4 =

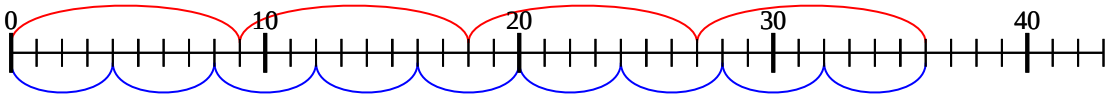

4) 3 × 10 =
10 × 3 =

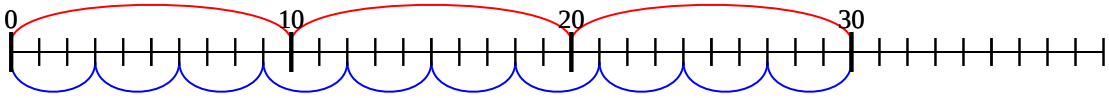

5) 5 × 10 =
10 × 5 =

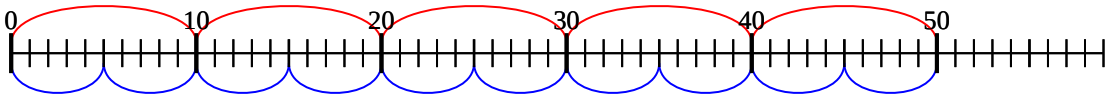

6) 5 × 7 =
7 × 5 =

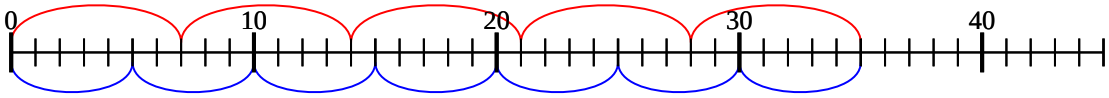

7) 2 × 6 =
6 × 2 =

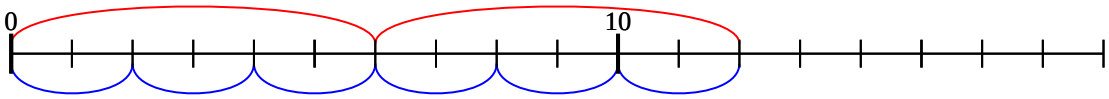

8) 5 × 5 =
5 × 5 =

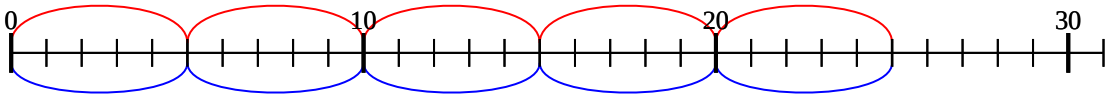

9) 5 × 4 =
4 × 5 =

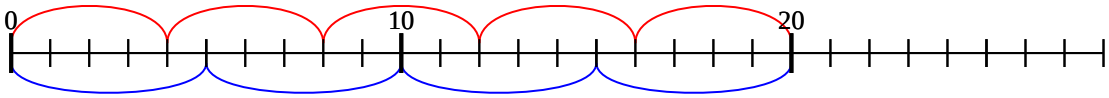

10) 3 × 3 =
3 × 3 =

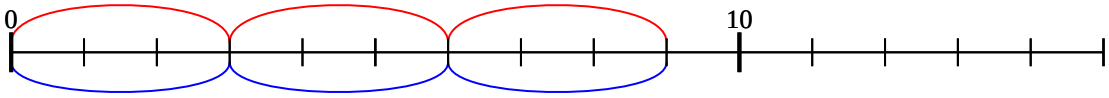

11) 2 × 10 =
10 × 2 =

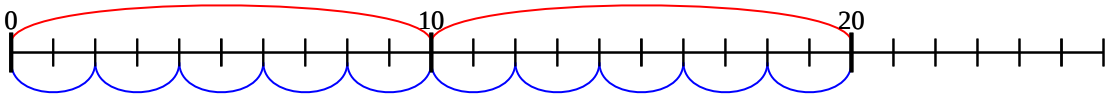

Risposte

1. **32**
2. **6**
3. **36**
4. **30**
5. **50**
6. **35**
7. **12**
8. **25**
9. **20**
10. **9**
11. **20**