Moltiplicazioni con la linea numerata

Nome:

Usa la linea numerata per risolvere ogni operazione.

1) $2 \times 4 =$

$4 \times 2 =$

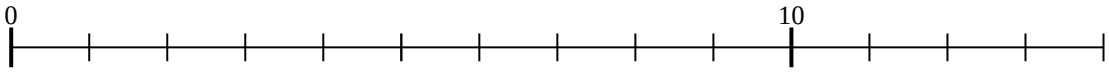

2) $2 \times 6 =$

$6 \times 2 =$

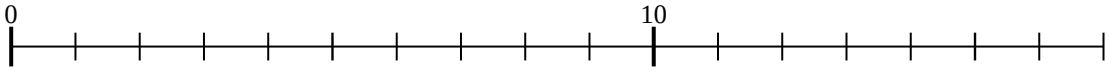

3) $2 \times 9 =$

$9 \times 2 =$

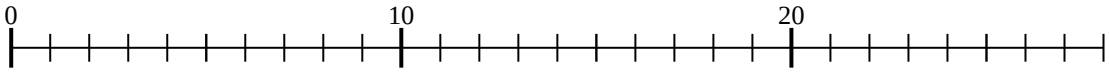

4) $4 \times 3 =$

$3 \times 4 =$

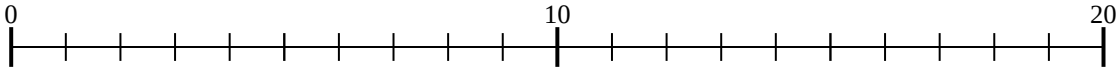

5) $5 \times 10 =$

$10 \times 5 =$

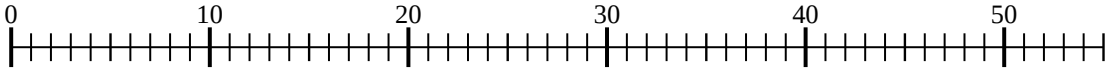

6) $3 \times 8 =$

$8 \times 3 =$

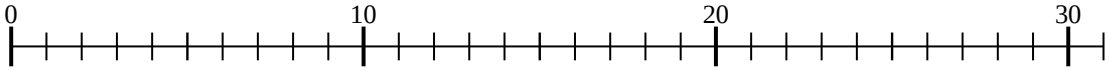

7) $5 \times 4 =$

$4 \times 5 =$

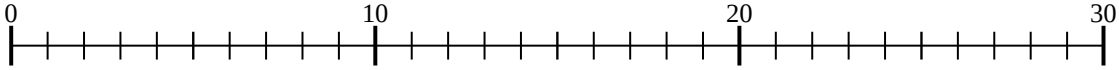

8) $4 \times 6 =$

$6 \times 4 =$

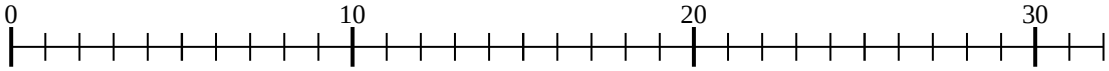

9) $4 \times 2 =$

$2 \times 4 =$

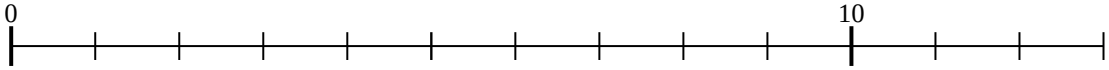

10) $2 \times 10 =$

$10 \times 2 =$

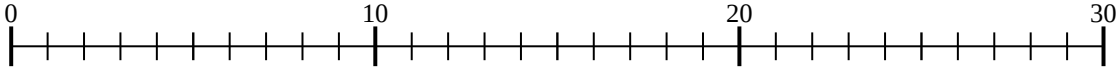

11) $5 \times 9 =$

$9 \times 5 =$

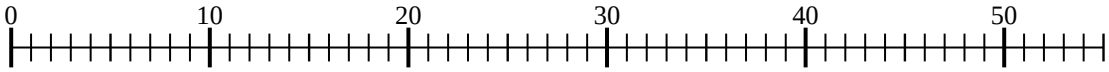

Risposte

1. _____
2. _____
3. _____
4. _____
5. _____
6. _____
7. _____
8. _____
9. _____
10. _____
11. _____

1-10	91	82	73	64	55	45	36	27	18	9
11	0									

Moltiplicazioni con la linea numerata Nome: **Soluzioni**

Usa la linea numerata per risolvere ogni operazione.

1) 2 × 4 =
4 × 2 =

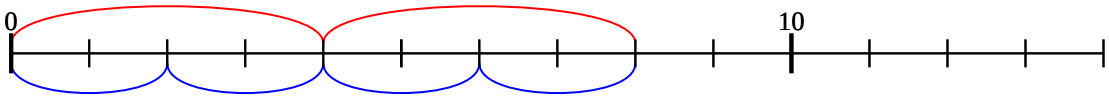

2) 2 × 6 =
6 × 2 =

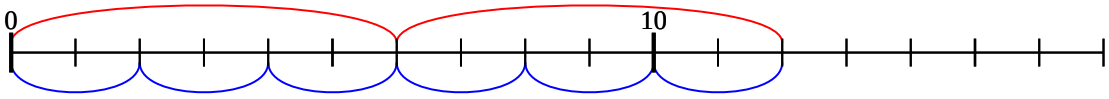

3) 2 × 9 =
9 × 2 =

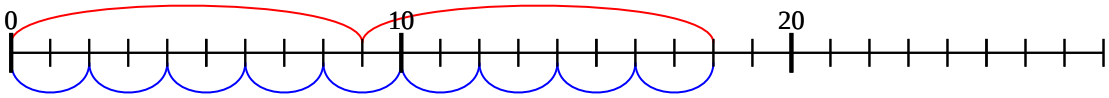

4) 4 × 3 =
3 × 4 =

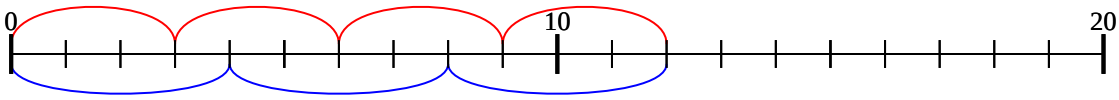

5) 5 × 10 =
10 × 5 =

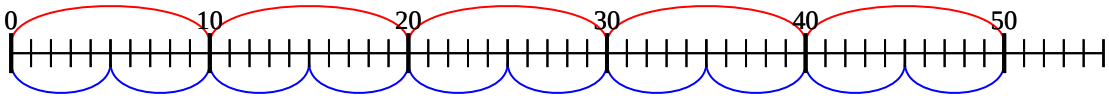

6) 3 × 8 =
8 × 3 =

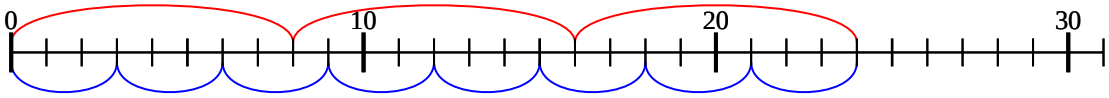

7) 5 × 4 =
4 × 5 =

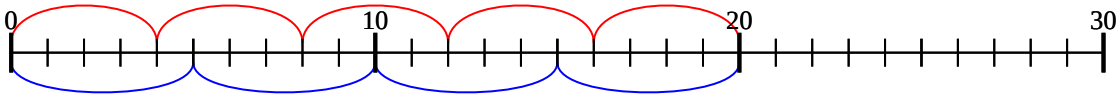

8) 4 × 6 =
6 × 4 =

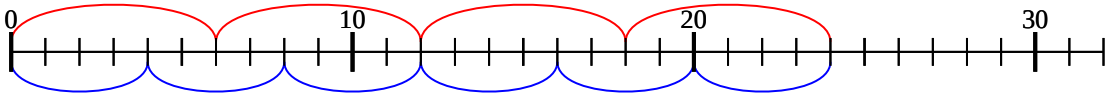

9) 4 × 2 =
2 × 4 =

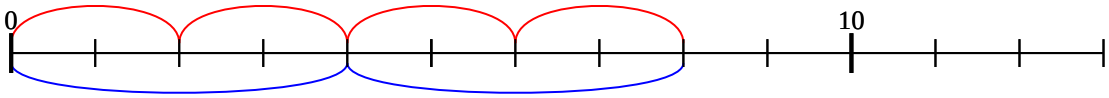

10) 2 × 10 =
10 × 2 =

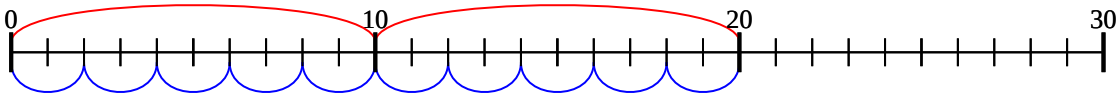

11) 5 × 9 =
9 × 5 =

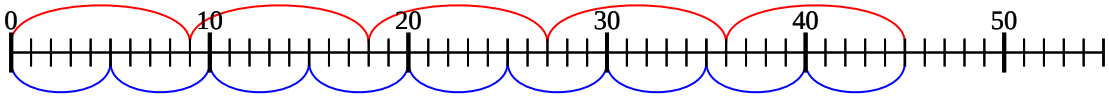

Risposte

1. **8**
2. **12**
3. **18**
4. **12**
5. **50**
6. **24**
7. **20**
8. **24**
9. **8**
10. **20**
11. **45**