Moltiplicazioni con la linea numerata Nome:

Usa la linea numerata per risolvere ogni operazione.

1) 3 × 3 =

3 × 3 =

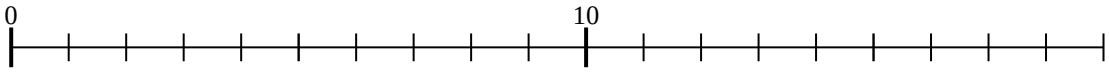

2) 2 × 5 =

5 × 2 =

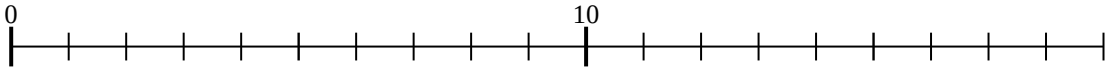

3) 4 × 8 =

8 × 4 =

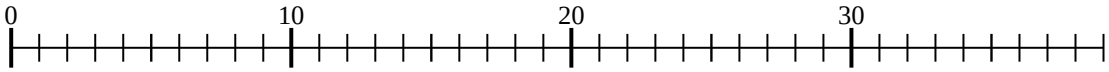

4) 4 × 2 =

2 × 4 =

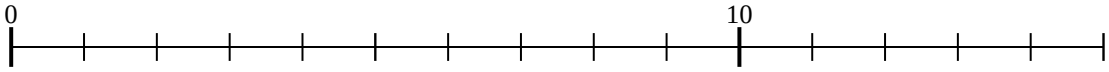

5) 4 × 6 =

6 × 4 =

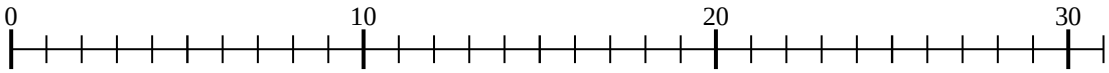

6) 3 × 7 =

7 × 3 =

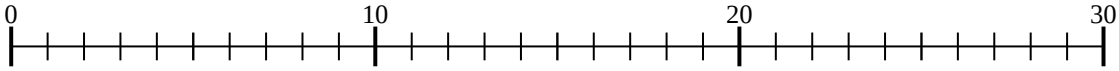

7) 2 × 2 =

2 × 2 =

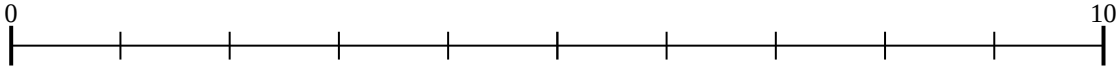

8) 5 × 6 =

6 × 5 =

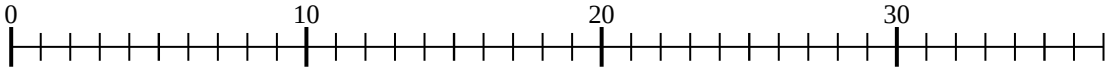

9) 5 × 4 =

4 × 5 =

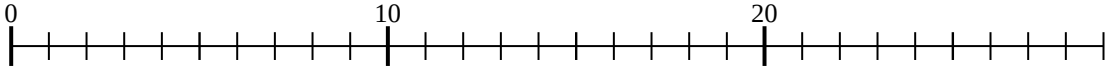

10) 5 × 3 =

3 × 5 =

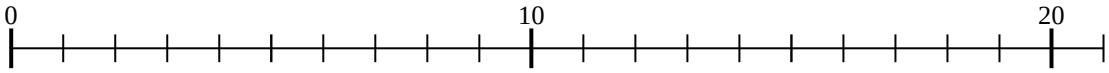

11) 3 × 4 =

4 × 3 =

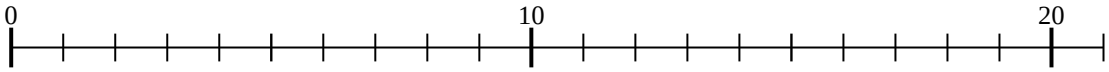

Risposte

1. _____
2. _____
3. _____
4. _____
5. _____
6. _____
7. _____
8. _____
9. _____
10. _____
11. _____

1-10	91	82	73	64	55	45	36	27	18	9
11	0									

Moltiplicazioni con la linea numerata

Nome: **Soluzioni**

Usa la linea numerata per risolvere ogni operazione.

1) 3 × 3 =

3 × 3 =

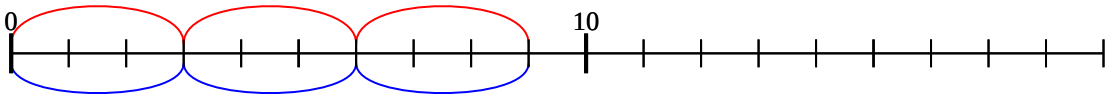

2) 2 × 5 =

5 × 2 =

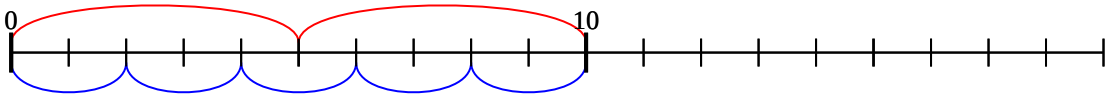

3) 4 × 8 =

8 × 4 =

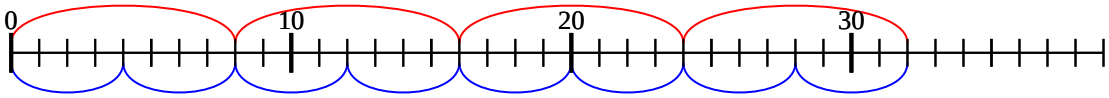

4) 4 × 2 =

2 × 4 =

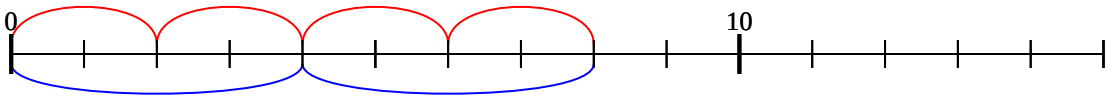

5) 4 × 6 =

6 × 4 =

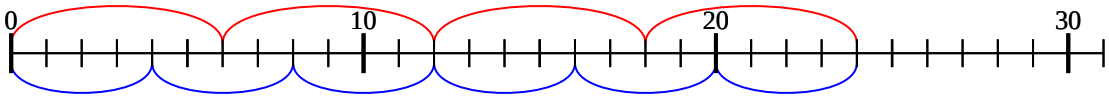

6) 3 × 7 =

7 × 3 =

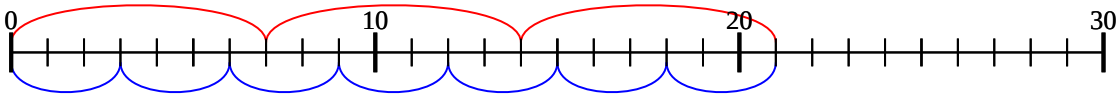

7) 2 × 2 =

2 × 2 =

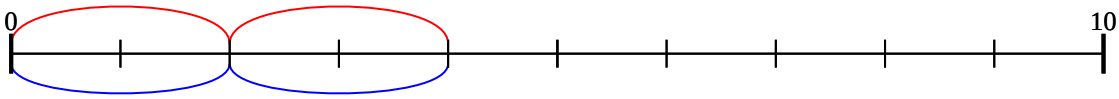

8) 5 × 6 =

6 × 5 =

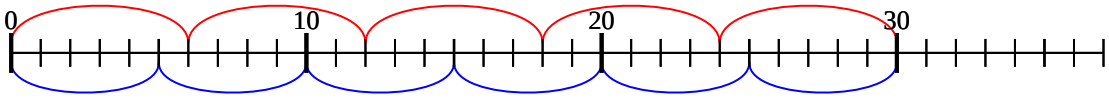

9) 5 × 4 =

4 × 5 =

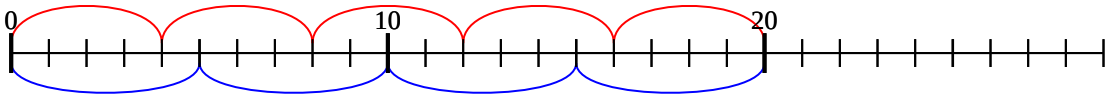

10) 5 × 3 =

3 × 5 =

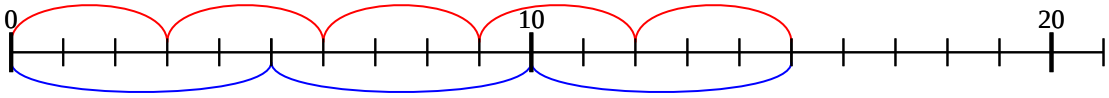

11) 3 × 4 =

4 × 3 =

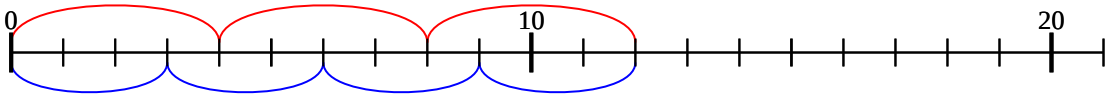

Risposte

1. **9**
2. **10**
3. **32**
4. **8**
5. **24**
6. **21**
7. **4**
8. **30**
9. **20**
10. **15**
11. **12**

1-10	91	82	73	64	55	45	36	27	18	9
11	0									