# Moltiplicazioni con la linea numerata

Nome:

**Usa la linea numerata per risolvere ogni operazione.**

**1)** 3 × 5 =
5 × 3 =

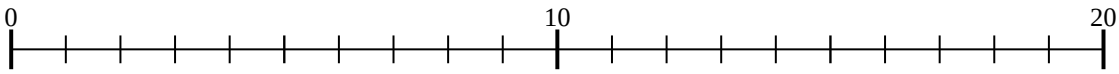


**2)** 4 × 7 =
7 × 4 =

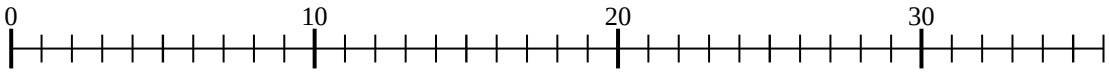


**3)** 2 × 8 =
8 × 2 =

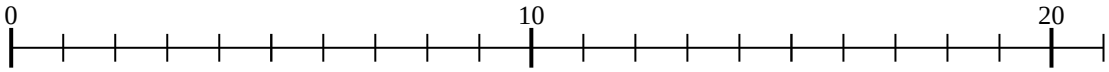


**4)** 4 × 9 =
9 × 4 =

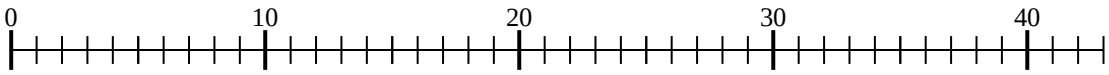


**5)** 4 × 2 =
2 × 4 =

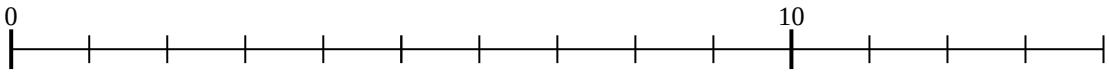


**6)** 4 × 4 =
4 × 4 =

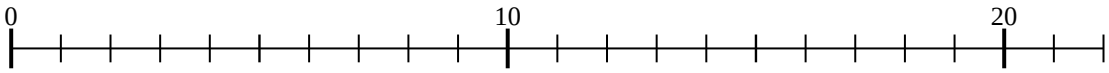


**7)** 3 × 2 =
2 × 3 =

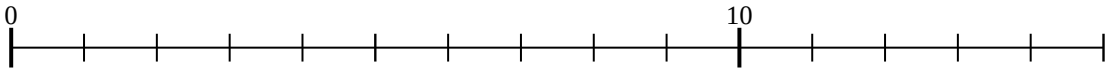


**8)** 2 × 5 =
5 × 2 =

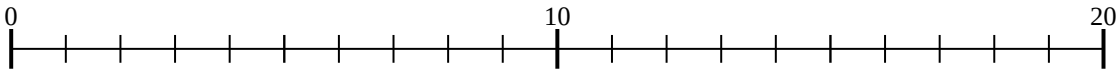


**9)** 2 × 3 =
3 × 2 =

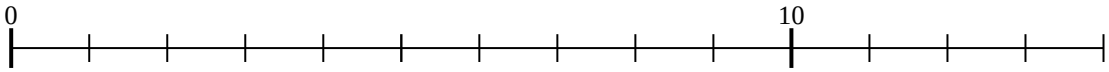


**10)** 5 × 7 =
7 × 5 =

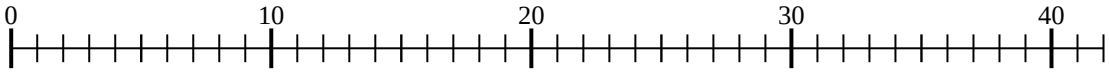


**11)** 5 × 2 =
2 × 5 =

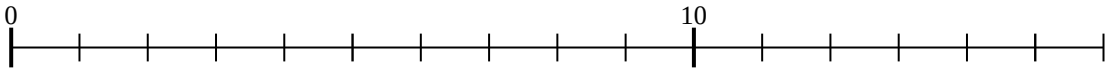


**Risposte**

1. _____
2. _____
3. _____
4. _____
5. _____
6. _____
7. _____
8. _____
9. _____
10. _____
11. _____



| | | | | | | | | | | |
|---|---|---|---|---|---|---|---|---|---|---|
| 1-10 | 91 | 82 | 73 | 64 | 55 | 45 | 36 | 27 | 18 | 9 |
| 11 | 0 | | | | | | | | | |

Moltiplicazioni con la linea numerata Nome: **Soluzioni**

**Usa la linea numerata per risolvere ogni operazione.**

**1)** 3 × 5 =
5 × 3 =

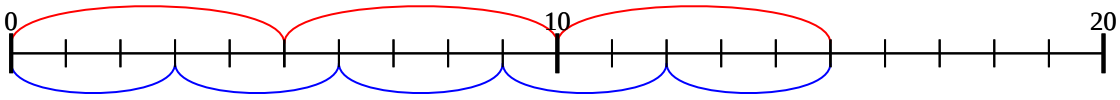


**2)** 4 × 7 =
7 × 4 =

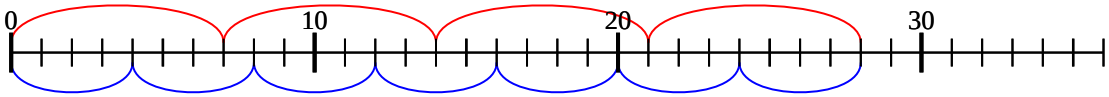


**3)** 2 × 8 =
8 × 2 =

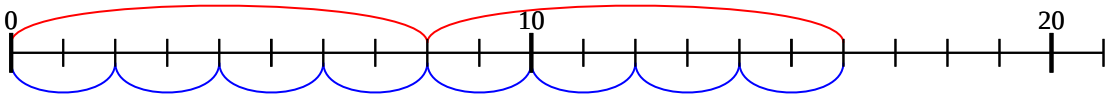


**4)** 4 × 9 =
9 × 4 =

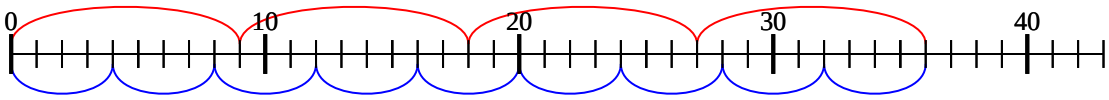


**5)** 4 × 2 =
2 × 4 =

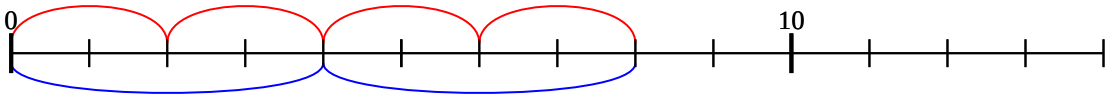


**6)** 4 × 4 =
4 × 4 =

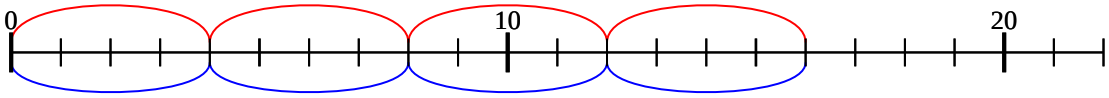


**7)** 3 × 2 =
2 × 3 =

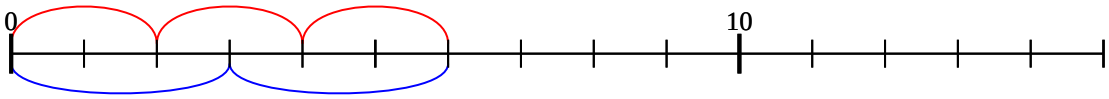


**8)** 2 × 5 =
5 × 2 =

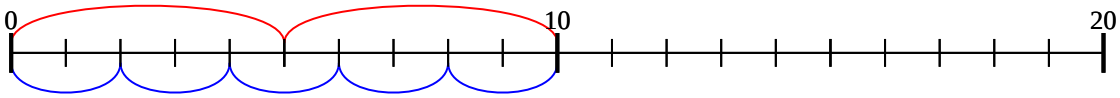


**9)** 2 × 3 =
3 × 2 =

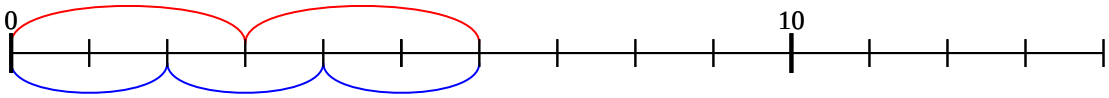


**10)** 5 × 7 =
7 × 5 =

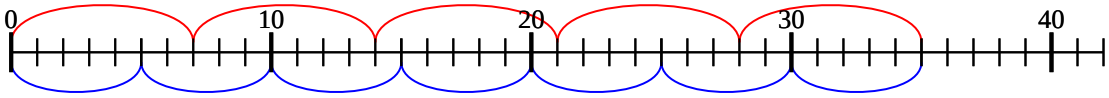


**11)** 5 × 2 =
2 × 5 =

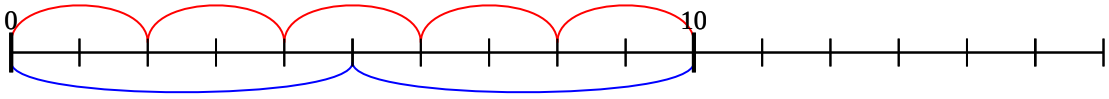


**Risposte**

1. **15**
2. **28**
3. **16**
4. **36**
5. **8**
6. **16**
7. **6**
8. **10**
9. **6**
10. **35**
11. **10**



| | | | | | | | | | | |
|---|---|---|---|---|---|---|---|---|---|---|
| 1-10 | 91 | 82 | 73 | 64 | 55 | 45 | 36 | 27 | 18 | 9 |
| 11 | 0 | | | | | | | | | |