Moltiplicazioni con la linea numerata

Nome:

Usa la linea numerata per risolvere ogni operazione.

1) 3 × 5 =
5 × 3 =

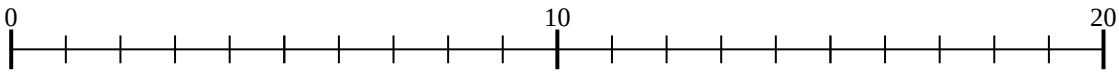

2) 4 × 7 =
7 × 4 =

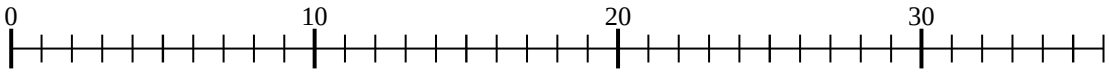

3) 2 × 8 =
8 × 2 =

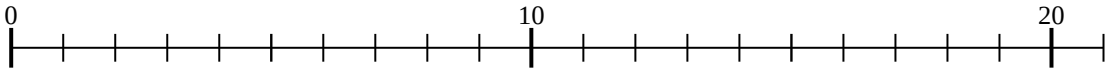

4) 4 × 9 =
9 × 4 =

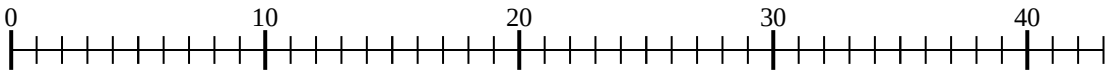

5) 4 × 2 =
2 × 4 =

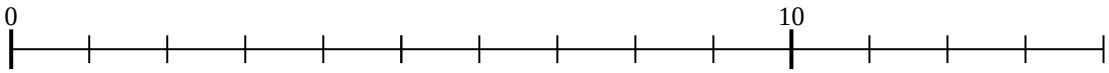

6) 4 × 4 =
4 × 4 =

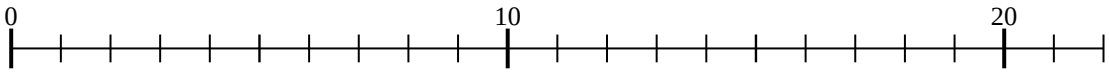

7) 3 × 2 =
2 × 3 =

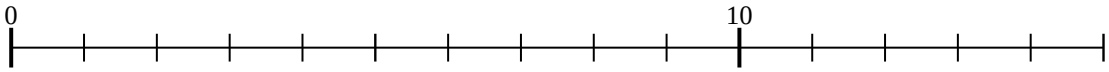

8) 2 × 5 =
5 × 2 =

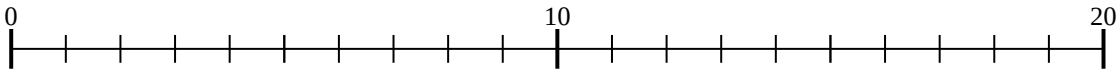

9) 2 × 3 =
3 × 2 =

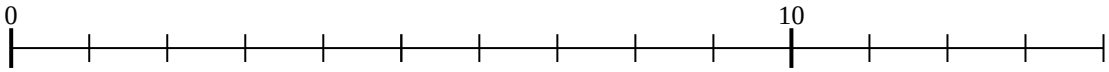

10) 5 × 7 =
7 × 5 =

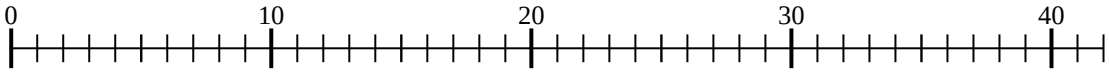

11) 5 × 2 =
2 × 5 =

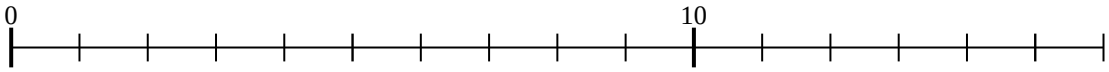

Risposte

1. _____
2. _____
3. _____
4. _____
5. _____
6. _____
7. _____
8. _____
9. _____
10. _____
11. _____

1-10	91	82	73	64	55	45	36	27	18	9
11	0									

Moltiplicazioni con la linea numerata Nome: **Soluzioni**

Usa la linea numerata per risolvere ogni operazione.

1) 3 × 5 =
5 × 3 =

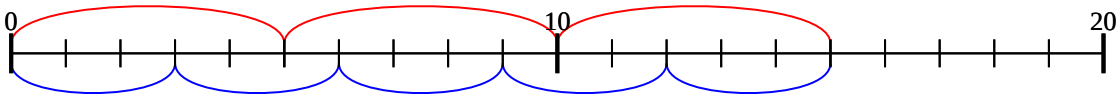

2) 4 × 7 =
7 × 4 =

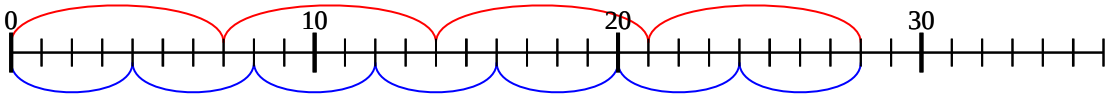

3) 2 × 8 =
8 × 2 =

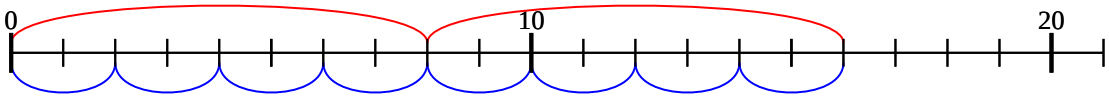

4) 4 × 9 =
9 × 4 =

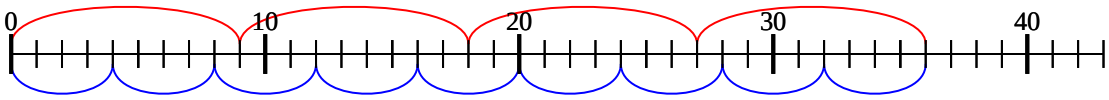

5) 4 × 2 =
2 × 4 =

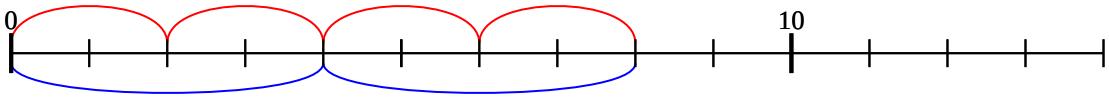

6) 4 × 4 =
4 × 4 =

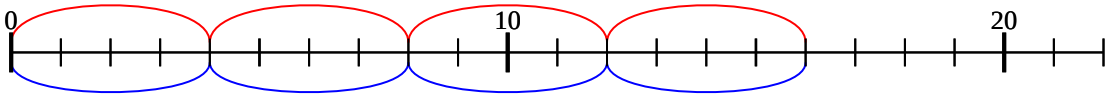

7) 3 × 2 =
2 × 3 =

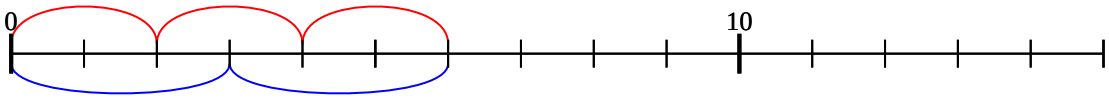

8) 2 × 5 =
5 × 2 =

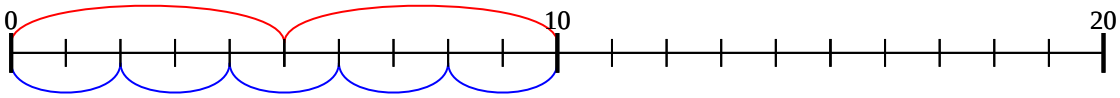

9) 2 × 3 =
3 × 2 =

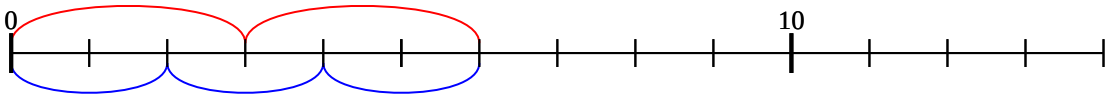

10) 5 × 7 =
7 × 5 =

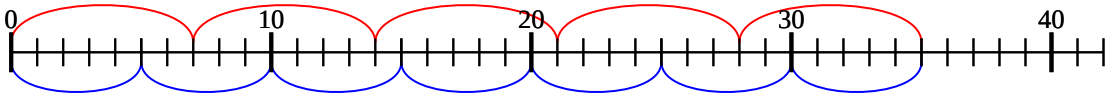

11) 5 × 2 =
2 × 5 =

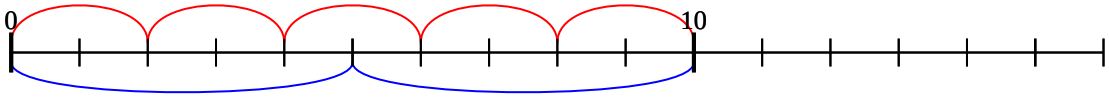

Risposte

1. **15**
2. **28**
3. **16**
4. **36**
5. **8**
6. **16**
7. **6**
8. **10**
9. **6**
10. **35**
11. **10**

1-10	91	82	73	64	55	45	36	27	18	9
11	0									