Moltiplicazioni con la linea numerata

Nome:

Usa la linea numerata per risolvere ogni operazione.

1) 3 × 3 =

3 × 3 =

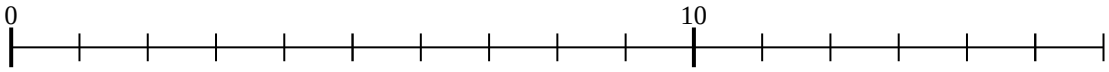

2) 3 × 2 =

2 × 3 =

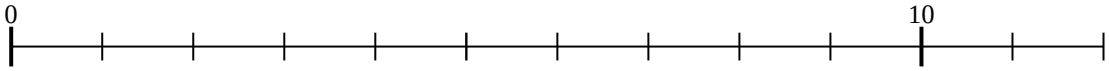

3) 3 × 4 =

4 × 3 =

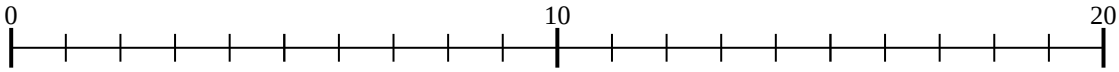

4) 3 × 5 =

5 × 3 =

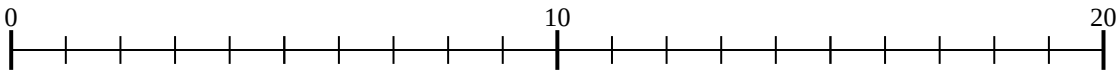

5) 4 × 7 =

7 × 4 =

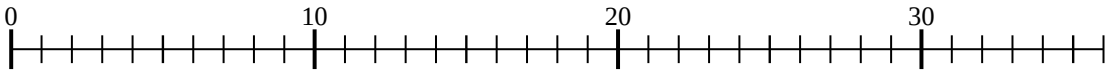

6) 4 × 10 =

10 × 4 =

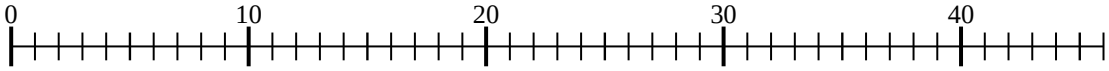

7) 4 × 6 =

6 × 4 =

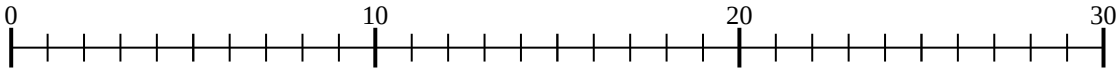

8) 3 × 10 =

10 × 3 =

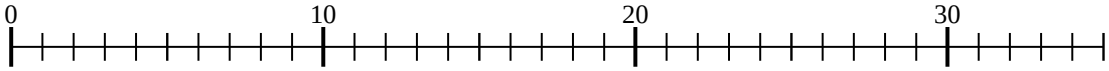

9) 5 × 6 =

6 × 5 =

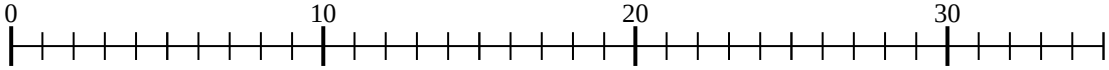

10) 4 × 3 =

3 × 4 =

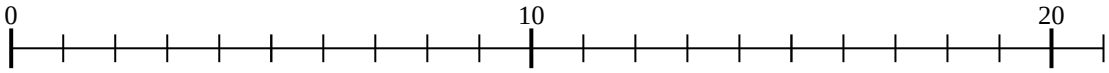

11) 3 × 6 =

6 × 3 =

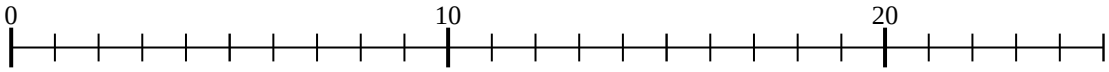

Risposte

1. _____
2. _____
3. _____
4. _____
5. _____
6. _____
7. _____
8. _____
9. _____
10. _____
11. _____

1-10	91	82	73	64	55	45	36	27	18	9
11	0									

Moltiplicazioni con la linea numerata Nome: **Soluzioni**

Usa la linea numerata per risolvere ogni operazione.

1) 3 × 3 =
3 × 3 =

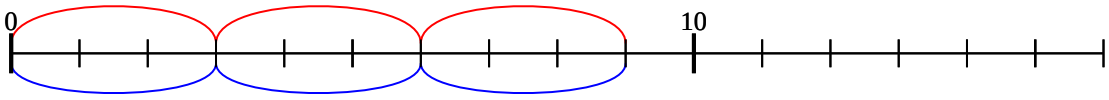

2) 3 × 2 =
2 × 3 =

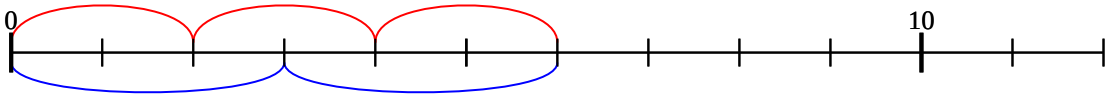

3) 3 × 4 =
4 × 3 =

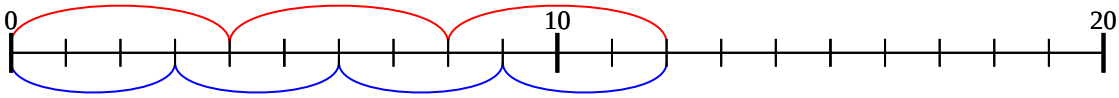

4) 3 × 5 =
5 × 3 =

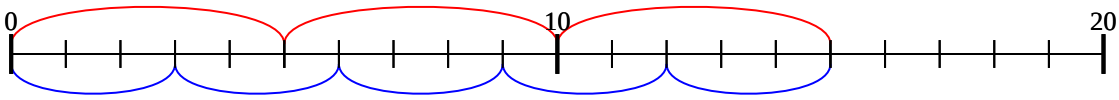

5) 4 × 7 =
7 × 4 =

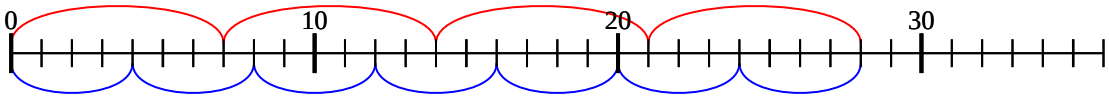

6) 4 × 10 =
10 × 4 =

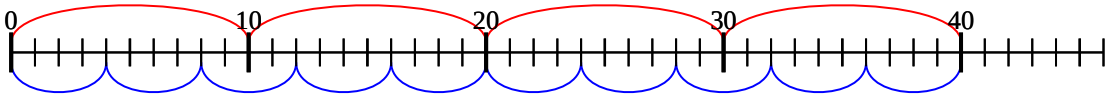

7) 4 × 6 =
6 × 4 =

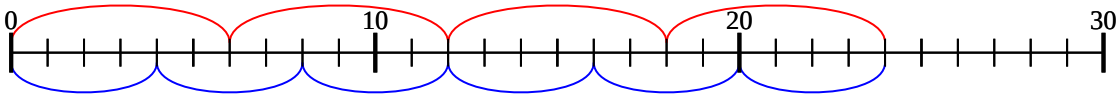

8) 3 × 10 =
10 × 3 =

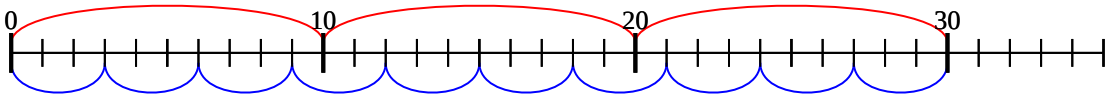

9) 5 × 6 =
6 × 5 =

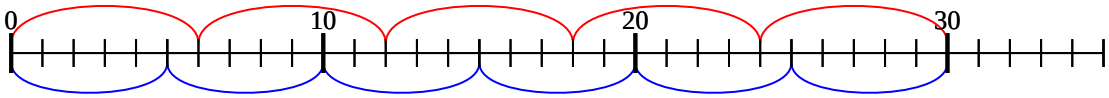

10) 4 × 3 =
3 × 4 =

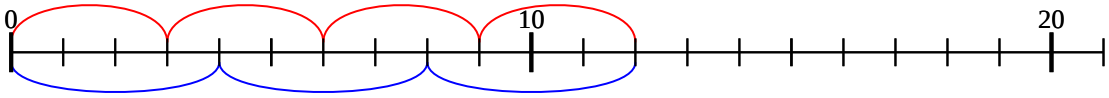

11) 3 × 6 =
6 × 3 =

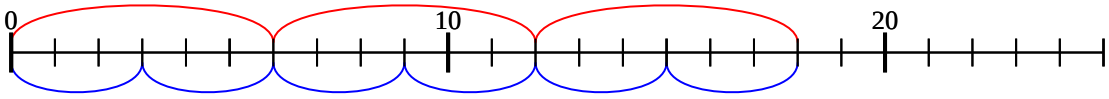

Risposte

1. **9**
2. **6**
3. **12**
4. **15**
5. **28**
6. **40**
7. **24**
8. **30**
9. **30**
10. **12**
11. **18**

1-10	91	82	73	64	55	45	36	27	18	9
11	0									