Moltiplicazioni con la linea numerata

Nome:

Usa la linea numerata per risolvere ogni operazione.

1) 4 × 10 =
10 × 4 =

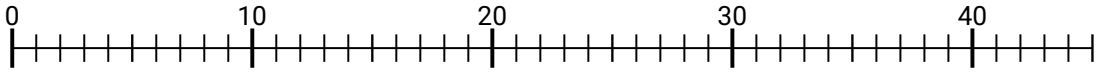

2) 5 × 9 =
9 × 5 =

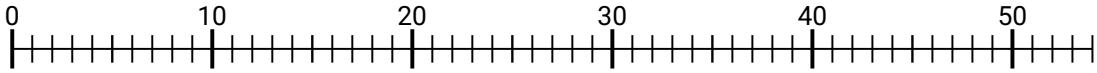

3) 3 × 3 =
3 × 3 =

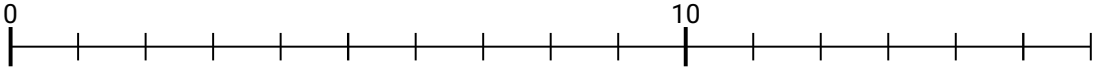

4) 4 × 5 =
5 × 4 =

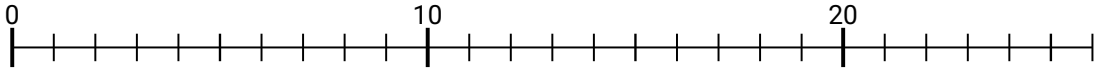

5) 4 × 8 =
8 × 4 =

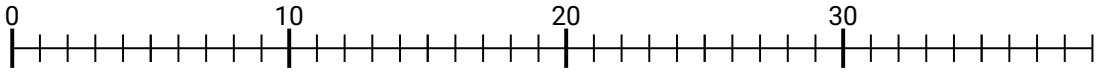

6) 3 × 10 =
10 × 3 =

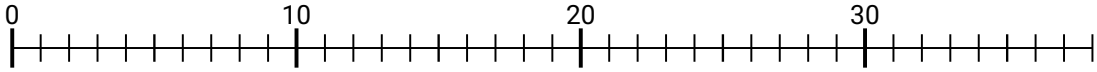

7) 2 × 6 =
6 × 2 =

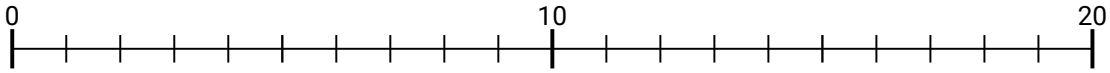

8) 4 × 9 =
9 × 4 =

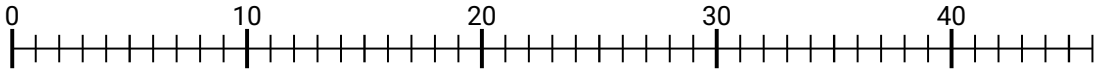

9) 2 × 3 =
3 × 2 =

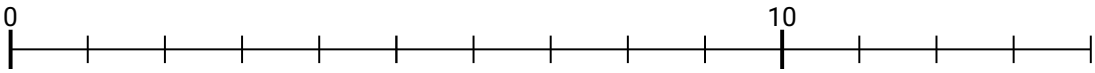

10) 4 × 4 =
4 × 4 =

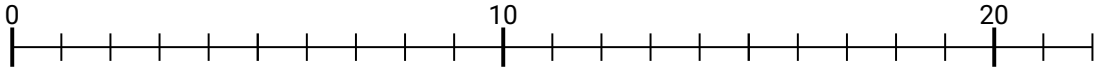

11) 5 × 8 =
8 × 5 =

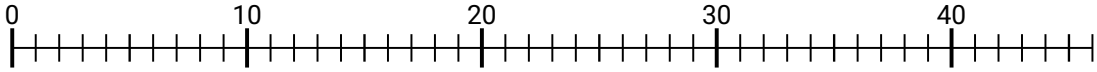

Risposte

1. _____
2. _____
3. _____
4. _____
5. _____
6. _____
7. _____
8. _____
9. _____
10. _____
11. _____

Moltiplicazioni con la linea numerata

Nome: **Soluzioni**

Usa la linea numerata per risolvere ogni operazione.

1) 4 × 10 =
10 × 4 =

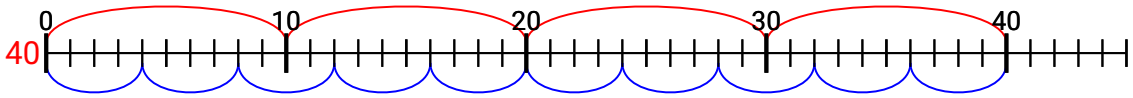

2) 5 × 9 =
9 × 5 =

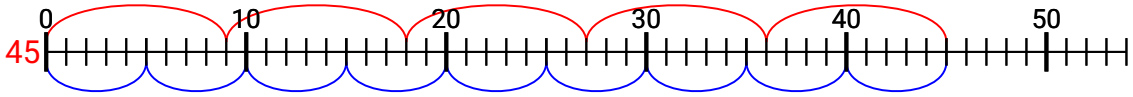

3) 3 × 3 =
3 × 3 =

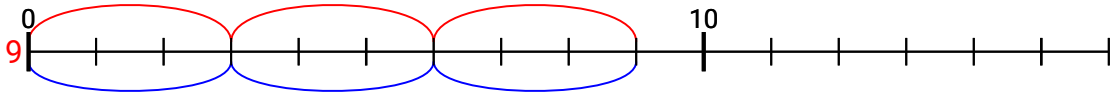

4) 4 × 5 =
5 × 4 =

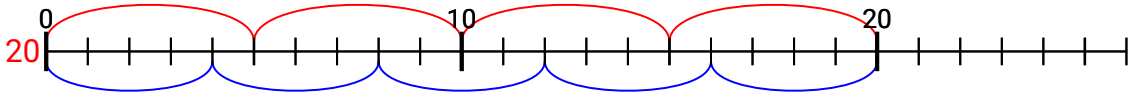

5) 4 × 8 =
8 × 4 =

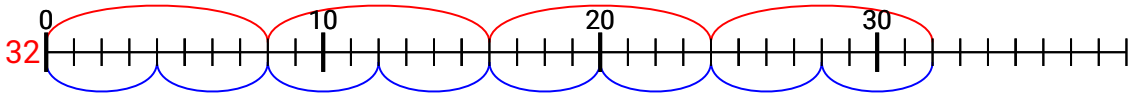

6) 3 × 10 =
10 × 3 =

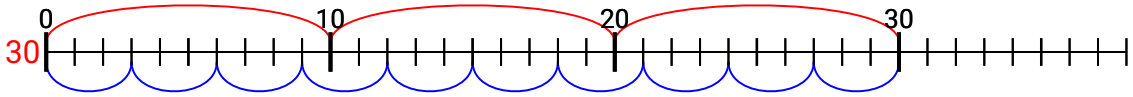

7) 2 × 6 =
6 × 2 =

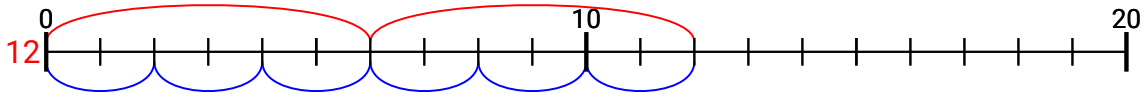

8) 4 × 9 =
9 × 4 =

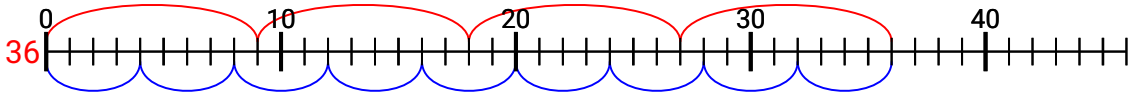

9) 2 × 3 =
3 × 2 =

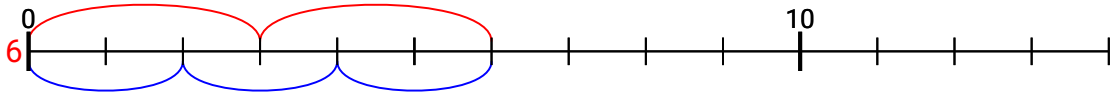

10) 4 × 4 =
4 × 4 =

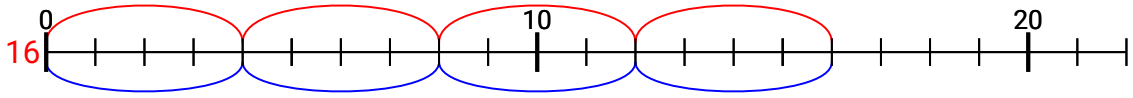

11) 5 × 8 =
8 × 5 =

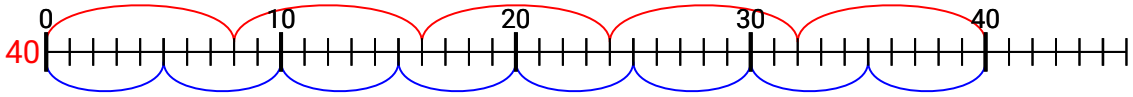

Risposte

1. 40
2. 45
3. 9
4. 20
5. 32
6. 30
7. 12
8. 36
9. 6
10. 16
11. 40