Misurazione e visualizzazione dei dati Nome:

Misura ogni punta ARTICOLO per punta, quindi posiziona i risultati nel grafico a linee.

Es)



1)

2)



3)

4)

5)

6)

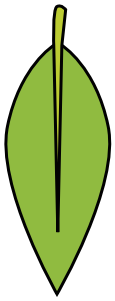

7)

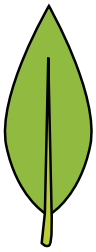

8)



9)

10)

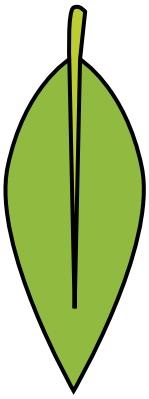

11)

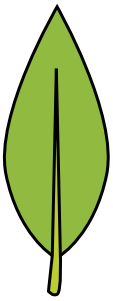

Line Plot

$\frac{1}{4}$	$\frac{1}{2}$	$\frac{3}{4}$	1	$1\frac{1}{4}$	$1\frac{1}{2}$	$1\frac{3}{4}$	2

Risposte

Es. $1\frac{3}{4}$

1. _____
2. _____
3. _____
4. _____
5. _____
6. _____
7. _____
8. _____
9. _____
10. _____
11. _____

1-10	91	82	73	64	55	45	36	27	18	9
11	0									

Misurazione e visualizzazione dei dati Nome: **Soluzioni**

Misura ogni punta ARTICOLO per punta, quindi posiziona i risultati nel grafico a linee.

Es)



1)

2)



3)

4)

5)

6)

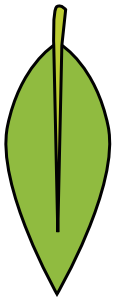

7)

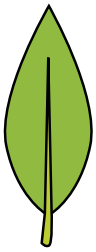

8)



9)

10)

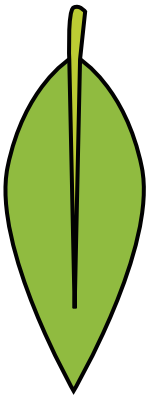

11)

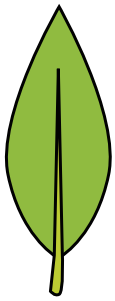

Line Plot

	X				X	X	X
X	X	X	X	X	X	X	X
¼	½	¾	1	1 ¼	1 ½	1 ¾	2

Risposte

Es.	1 ¾
1.	¼
2.	2
3.	1
4.	½
5.	¾
6.	1 ½
7.	1 ¼
8.	1 ¾
9.	½
10.	2
11.	1 ½

1-10	91	82	73	64	55	45	36	27	18	9
11	0									

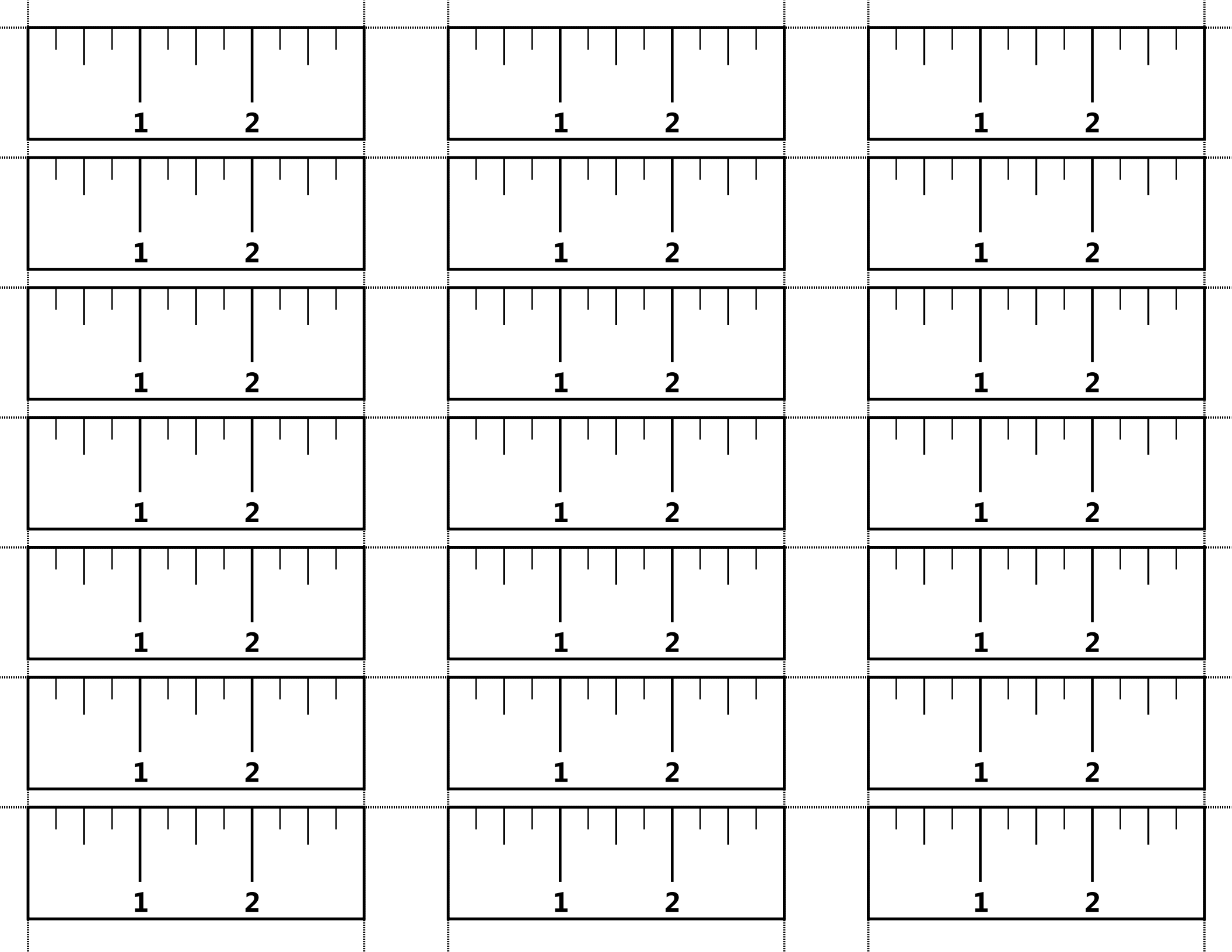
1
2