Linee di corrispondenza Nome:

Abbina la descrizione in alto con l'immagine visiva in basso.

1) $\overleftrightarrow{AB}$ intersecting $\angle BCD$ at point B

2) $\overrightarrow{AC}$ parallel to $\overrightarrow{EB}$

3) $\overleftrightarrow{AB}$ parallel to $\overleftrightarrow{CD}$

4) Acute $\angle BED$

5) $\overleftrightarrow{AC}$ intersected by $\overline{BD}$

6) Right $\angle ADE$

7) Acute $\angle ABC$ intersecting $\overleftrightarrow{AD}$

8) $\overleftrightarrow{BD}$ intersecting $\angle ACE$

9) $\overleftrightarrow{AC}$ perpendicular to $\overleftrightarrow{AD}$

10) $\angle DEC$ intersected by $\overleftrightarrow{AC}$

11) $\overrightarrow{BA}$ intersecting $\overleftrightarrow{AD}$

12) $\overleftrightarrow{AE}$ intersecting $\overleftrightarrow{DB}$

A.

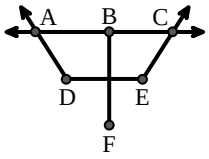

B.

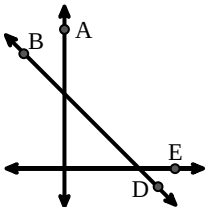

C.

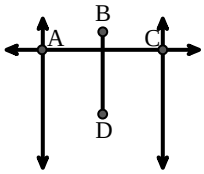

D.

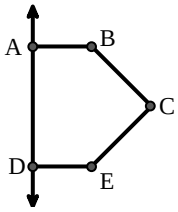

E.

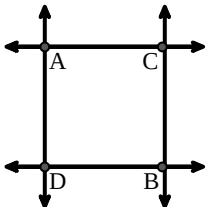

F.

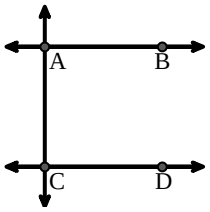

G.

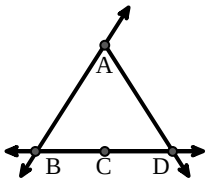

H.

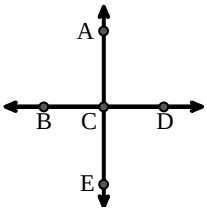

I.

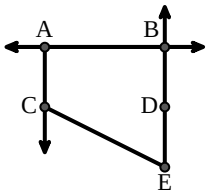

J.

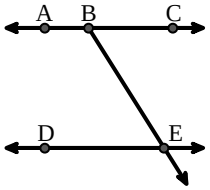

K.

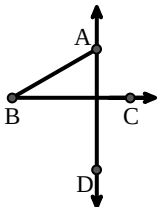

L.

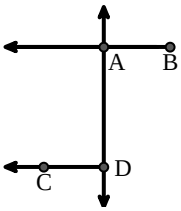

Risposte

1. _____
2. _____
3. _____
4. _____
5. _____
6. _____
7. _____
8. _____
9. _____
10. _____
11. _____
12. _____

1-10	92	83	75	67	58	50	42	33	25	17
11-12	8	0								

Abbina la descrizione in alto con l'immagine visiva in basso.

1) $\overleftrightarrow{AB}$ intersecting $\angle BCD$ at point B

2) $\overrightarrow{AC}$ parallel to $\overrightarrow{EB}$

3) $\overleftrightarrow{AB}$ parallel to $\overleftrightarrow{CD}$

4) Acute $\angle BED$

5) $\overleftrightarrow{AC}$ intersected by $\overline{BD}$

6) Right $\angle ADE$

7) Acute $\angle ABC$ intersecting $\overleftrightarrow{AD}$

8) $\overleftrightarrow{BD}$ intersecting $\angle ACE$

9) $\overleftrightarrow{AC}$ perpendicular to $\overleftrightarrow{AD}$

10) $\angle DEC$ intersected by $\overleftrightarrow{AC}$

11) $\overrightarrow{BA}$ intersecting $\overleftrightarrow{AD}$

12) $\overleftrightarrow{AE}$ intersecting $\overleftrightarrow{DB}$

A.

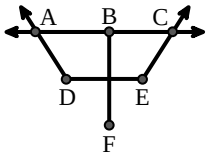

B.

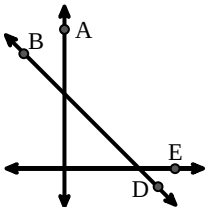

C.

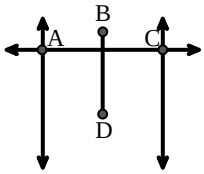

D.

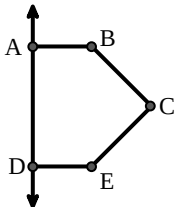

E.

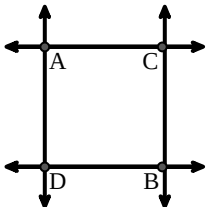

F.

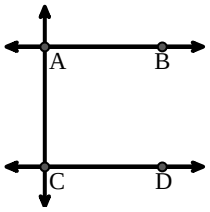

G.

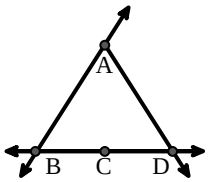

H.

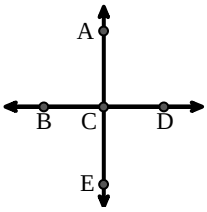

I.

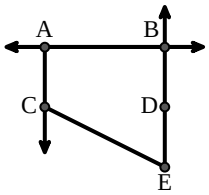

J.

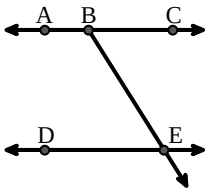

K.

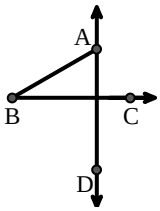

L.

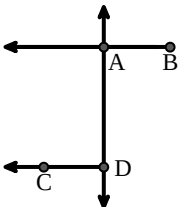

Risposte

1. G
2. I
3. F
4. J
5. C
6. D
7. K
8. B
9. E
10. A
11. L
12. H

1-10	92	83	75	67	58	50	42	33	25	17
11-12	8	0								