Trova la distanza sulla griglia

Nome:

**Trova la distanza tra i due punti.**

**Es)**

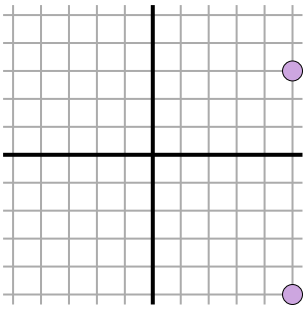

**1)**

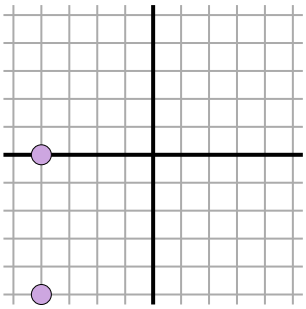

**2)**

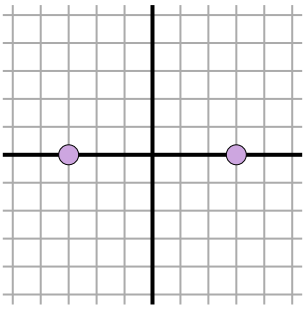

**3)**

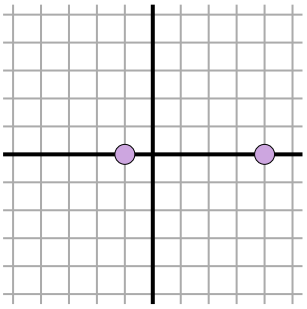

**4)**

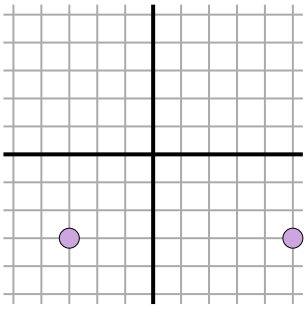

**5)**

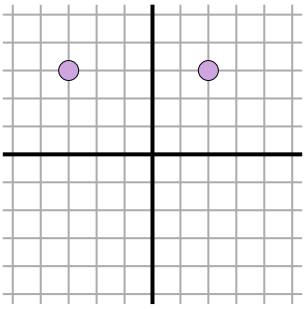

**6)**

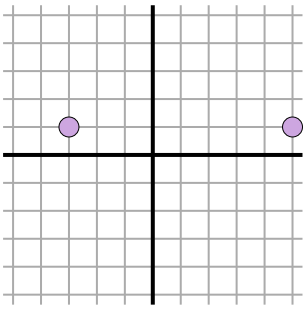

**7)**

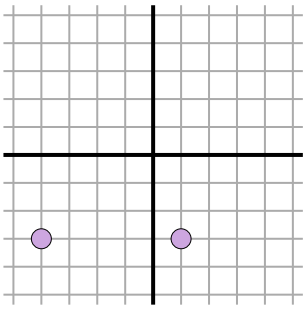

**8)**

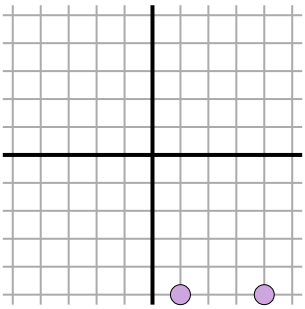

**9)**

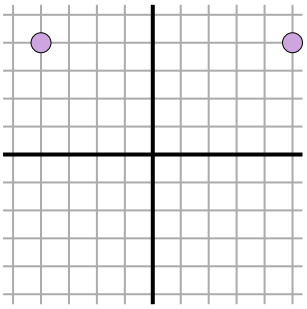

**10)**

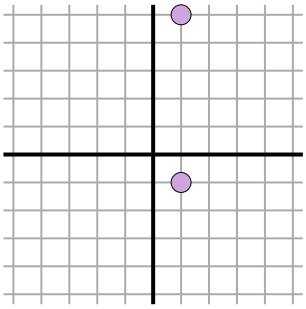

**11)**

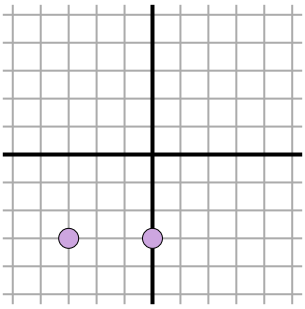

## Risposte

Es. 8

1. _____
2. _____
3. _____
4. _____
5. _____
6. _____
7. _____
8. _____
9. _____
10. _____
11. _____



| | | | | | | | | | | |
|---|---|---|---|---|---|---|---|---|---|---|
| 1-10 | 91 | 82 | 73 | 64 | 55 | 45 | 36 | 27 | 18 | 9 |
| 11 | 0 | | | | | | | | | |

Trova la distanza sulla griglia

Nome: **Soluzioni**

**Trova la distanza tra i due punti.**

**Es)**

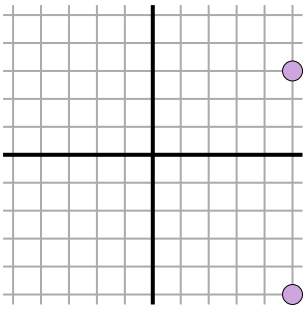

$\sqrt{(5-5)^2 + (-5-3)^2}$

$\sqrt{(0) + (64)}$

**1)**

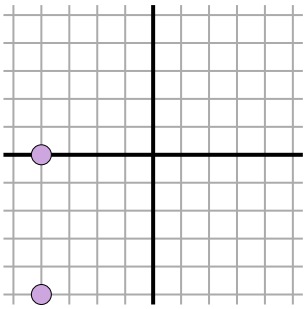

$\sqrt{(-4--4)^2 + (0--5)^2}$

$\sqrt{(0) + (25)}$

**2)**

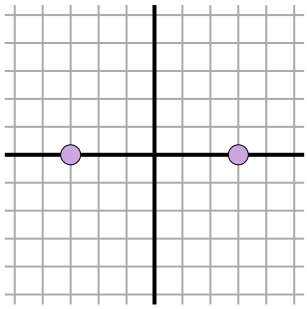

$\sqrt{(-3-3)^2 + (0-0)^2}$

$\sqrt{(36) + (0)}$

**3)**

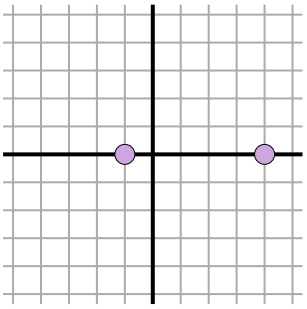

$\sqrt{(4--1)^2 + (0-0)^2}$

$\sqrt{(25) + (0)}$

**4)**

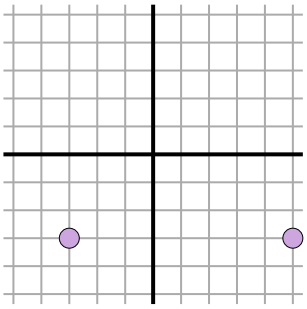

$\sqrt{(5--3)^2 + (-3--3)^2}$

$\sqrt{(64) + (0)}$

**5)**

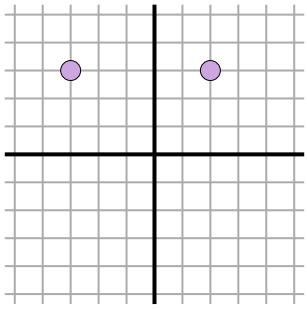

$\sqrt{(-3-2)^2 + (3-3)^2}$

$\sqrt{(25) + (0)}$

**6)**

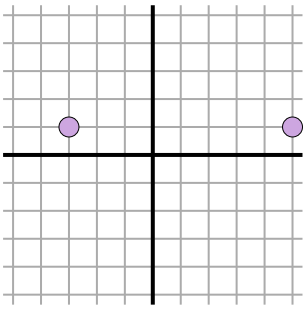

$\sqrt{(5--3)^2 + (1-1)^2}$

$\sqrt{(64) + (0)}$

**7)**

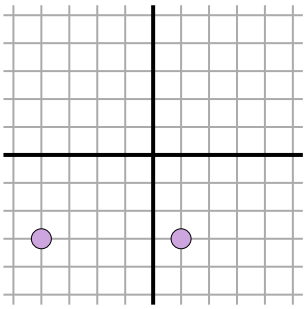

$\sqrt{(-4-1)^2 + (-3--3)^2}$

$\sqrt{(25) + (0)}$

**8)**

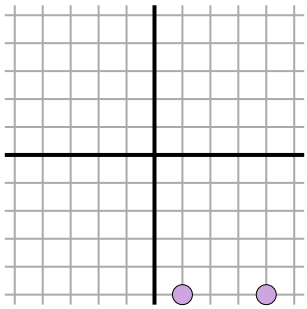

$\sqrt{(1-4)^2 + (-5--5)^2}$

$\sqrt{(9) + (0)}$

**9)**

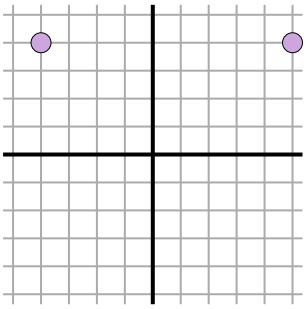

$\sqrt{(-4-5)^2 + (4-4)^2}$

$\sqrt{(81) + (0)}$

**10)**

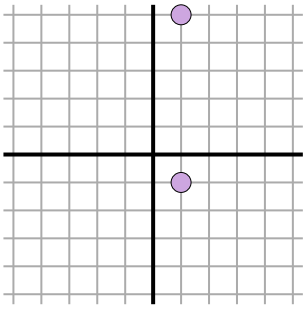

$\sqrt{(1-1)^2 + (-1-5)^2}$

$\sqrt{(0) + (36)}$

**11)**

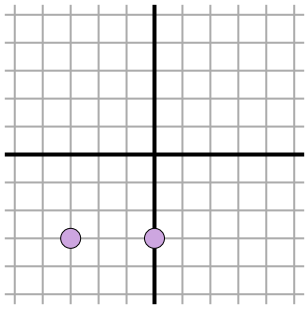

$\sqrt{(-3-0)^2 + (-3--3)^2}$

$\sqrt{(9) + (0)}$

**Risposte**

| | |
|---|---|
| Es. | 8 |
| 1. | 5 |
| 2. | 6 |
| 3. | 5 |
| 4. | 8 |
| 5. | 5 |
| 6. | 8 |
| 7. | 5 |
| 8. | 3 |
| 9. | 9 |
| 10. | 6 |
| 11. | 3 |