Trova la distanza sulla griglia

Nome:

Trova la distanza tra i due punti.

Es)

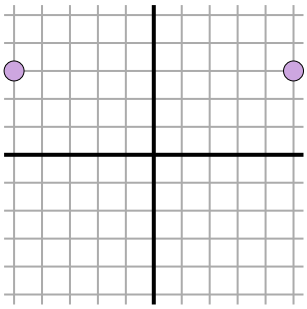

1)

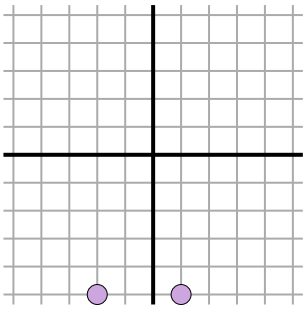

2)

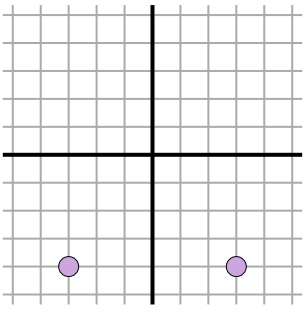

3)

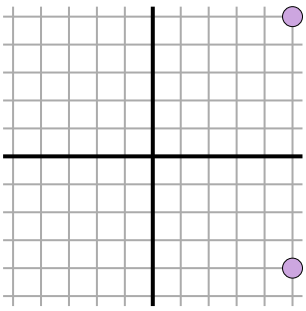

4)

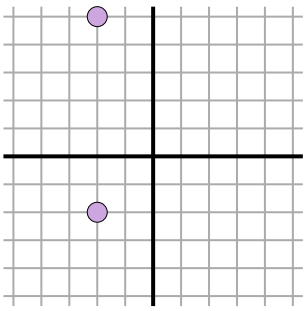

5)

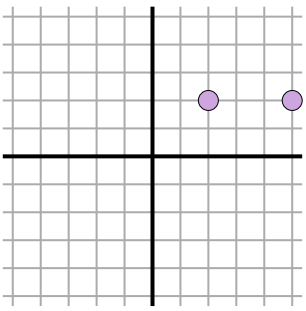

6)

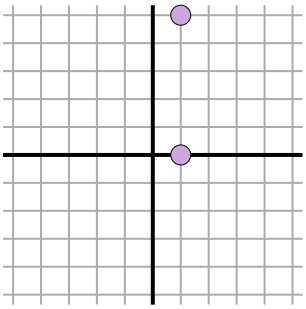

7)

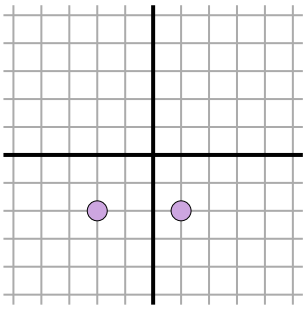

8)

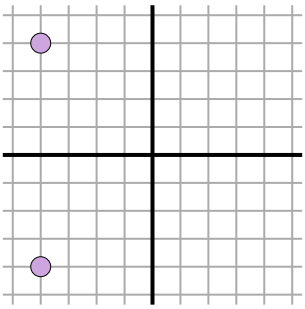

9)

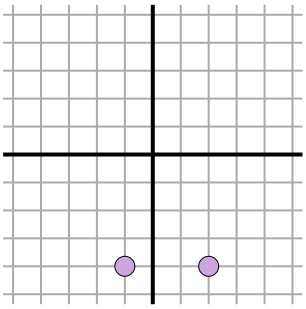

10)

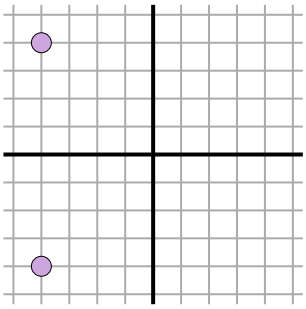

11)

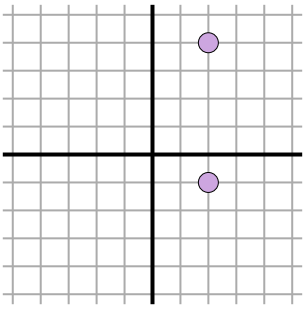

Risposte

Es. 10

1. _____
2. _____
3. _____
4. _____
5. _____
6. _____
7. _____
8. _____
9. _____
10. _____
11. _____

1-10	91	82	73	64	55	45	36	27	18	9
11	0									

Trova la distanza sulla griglia

Nome: **Soluzioni**

Trova la distanza tra i due punti.

Es)

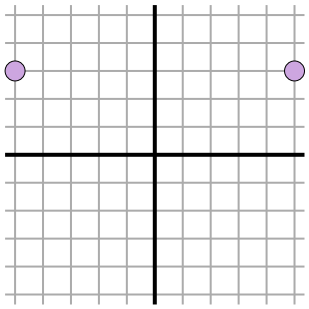

$\sqrt{(-5-5)^2 + (3-3)^2}$

$\sqrt{(100) + (0)}$

1)

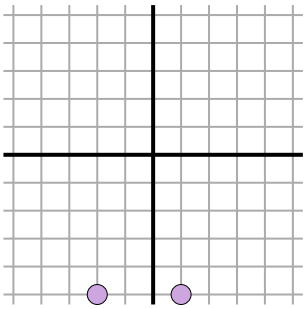

$\sqrt{(1--2)^2 + (-5--5)^2}$

$\sqrt{(9) + (0)}$

2)

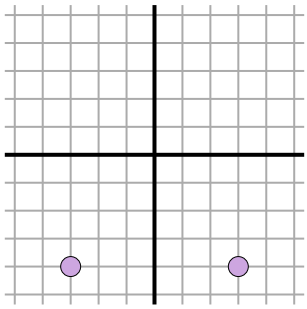

$\sqrt{(-3-3)^2 + (-4--4)^2}$

$\sqrt{(36) + (0)}$

3)

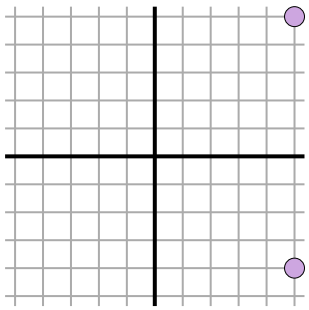

$\sqrt{(5-5)^2 + (5--4)^2}$

$\sqrt{(0) + (81)}$

4)

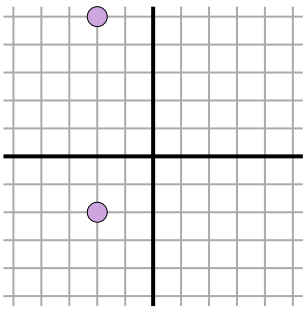

$\sqrt{(-2--2)^2 + (5--2)^2}$

$\sqrt{(0) + (49)}$

5)

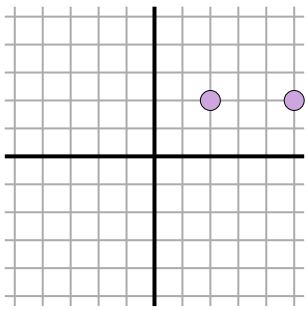

$\sqrt{(5-2)^2 + (2-2)^2}$

$\sqrt{(9) + (0)}$

6)

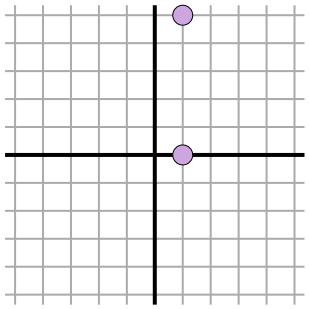

$\sqrt{(1-1)^2 + (0-5)^2}$

$\sqrt{(0) + (25)}$

7)

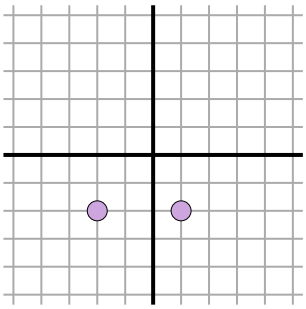

$\sqrt{(1--2)^2 + (-2--2)^2}$

$\sqrt{(9) + (0)}$

8)

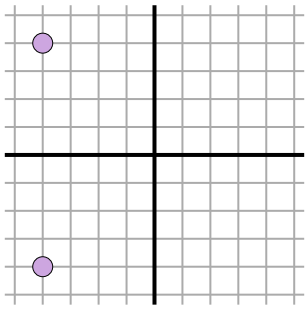

$\sqrt{(-4--4)^2 + (-4-4)^2}$

$\sqrt{(0) + (64)}$

9)

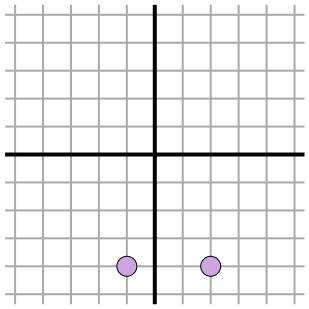

$\sqrt{(-1-2)^2 + (-4--4)^2}$

$\sqrt{(9) + (0)}$

10)

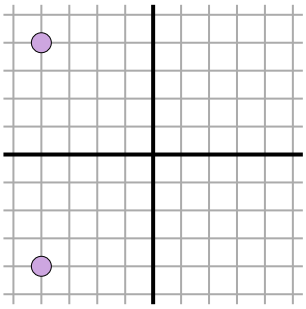

$\sqrt{(-4--4)^2 + (4--4)^2}$

$\sqrt{(0) + (64)}$

11)

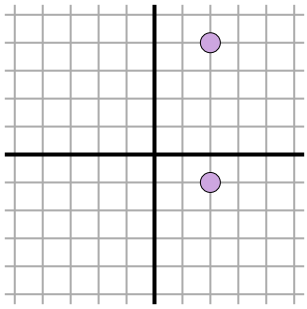

$\sqrt{(2-2)^2 + (4--1)^2}$

$\sqrt{(0) + (25)}$

Risposte

Es.	10
1.	3
2.	6
3.	9
4.	7
5.	3
6.	5
7.	3
8.	8
9.	3
10.	8
11.	5

1-10	91	82	73	64	55	45	36	27	18	9
11	0									