Trova la distante sulla griglia

Nome:

Trova la distanza tra i punti. Arrotonda il risultato alla decina più vicina.

Es)

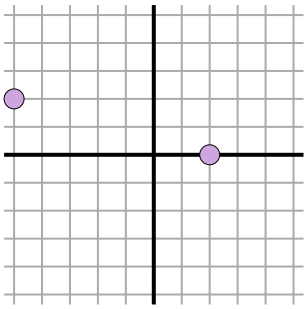

1)

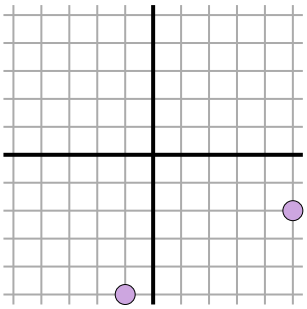

2)

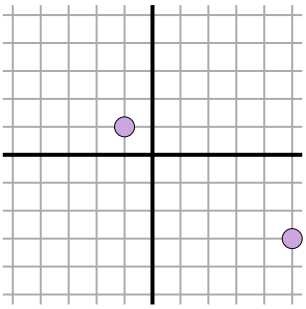

3)

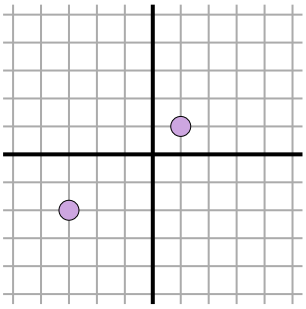

4)

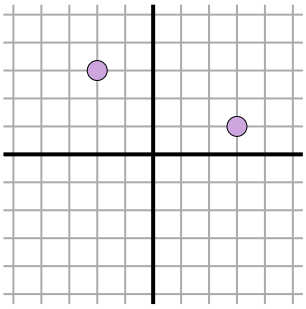

5)

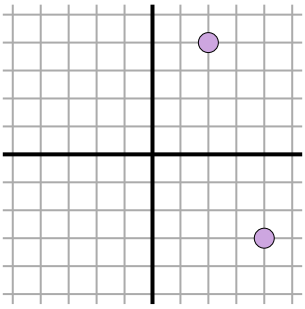

6)

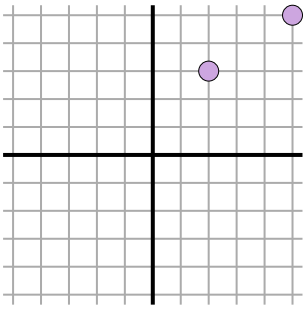

7)

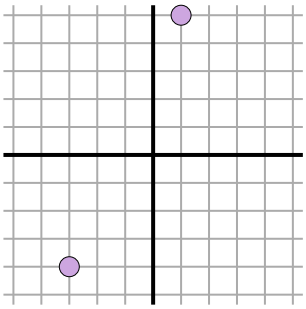

8)

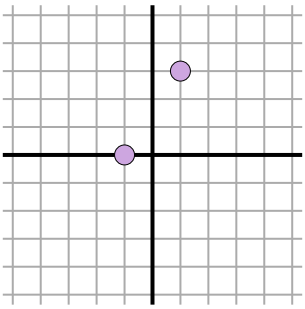

9)

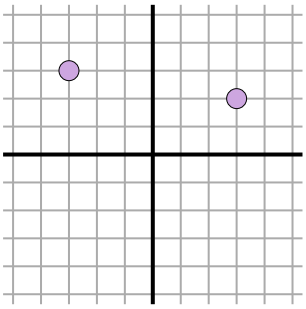

10)

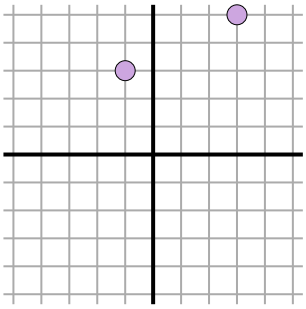

11)

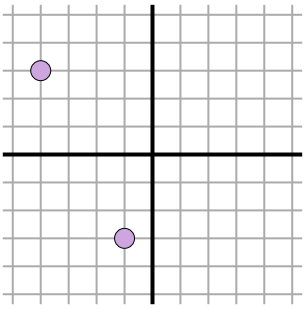

Risposte

Es. 7,3

1. _____
2. _____
3. _____
4. _____
5. _____
6. _____
7. _____
8. _____
9. _____
10. _____
11. _____

Trova la distante sulla griglia

Nome: **Soluzioni**

Trova la distanza tra i punti. Arrotonda il risultato alla decina più vicina.

Es)

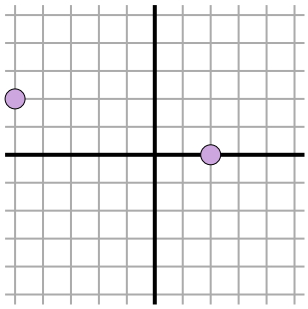

$\sqrt{(-5-2)^2 + (2-0)^2}$

$\sqrt{(49) + (4)}$

1)

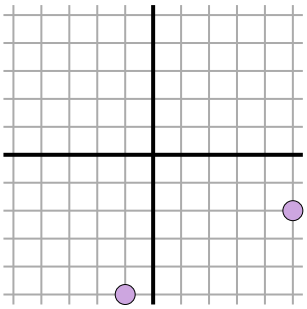

$\sqrt{(5--1)^2 + (-2--5)^2}$

$\sqrt{(36) + (9)}$

2)

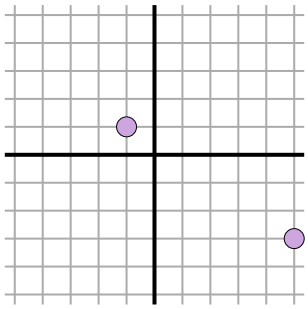

$\sqrt{(5--1)^2 + (-3-1)^2}$

$\sqrt{(36) + (16)}$

3)

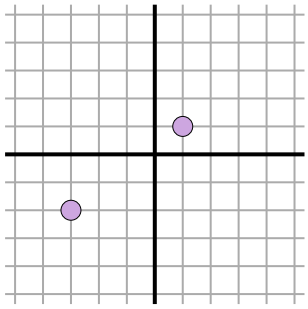

$\sqrt{(1--3)^2 + (1--2)^2}$

$\sqrt{(16) + (9)}$

4)

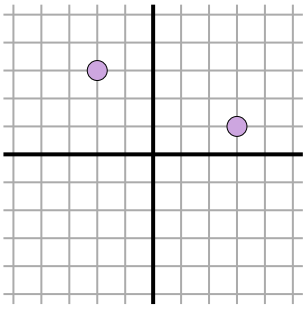

$\sqrt{(-2-3)^2 + (3-1)^2}$

$\sqrt{(25) + (4)}$

5)

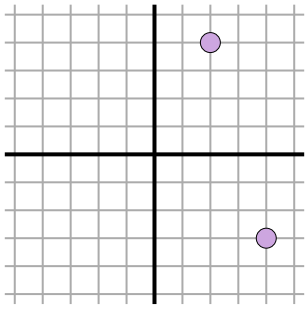

$\sqrt{(4-2)^2 + (-3-4)^2}$

$\sqrt{(4) + (49)}$

6)

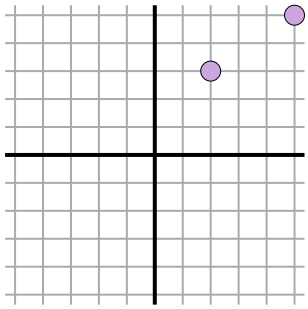

$\sqrt{(2-5)^2 + (3-5)^2}$

$\sqrt{(9) + (4)}$

7)

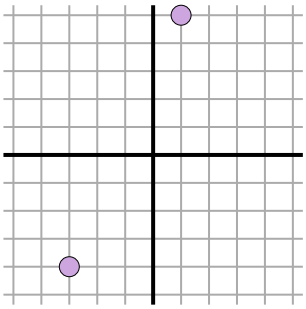

$\sqrt{(-3-1)^2 + (-4-5)^2}$

$\sqrt{(16) + (81)}$

8)

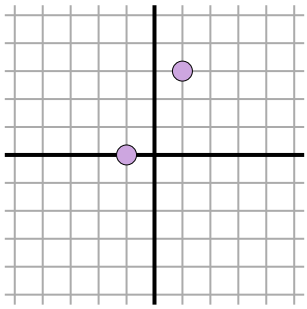

$\sqrt{(-1-1)^2 + (0-3)^2}$

$\sqrt{(4) + (9)}$

9)

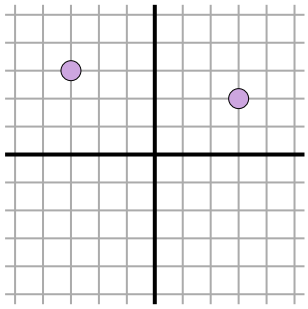

$\sqrt{(3--3)^2 + (2-3)^2}$

$\sqrt{(36) + (1)}$

10)

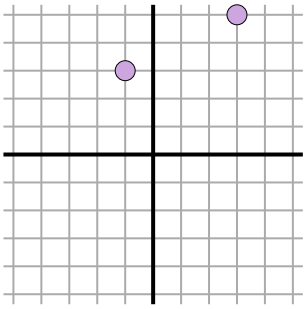

$\sqrt{(3--1)^2 + (5-3)^2}$

$\sqrt{(16) + (4)}$

11)

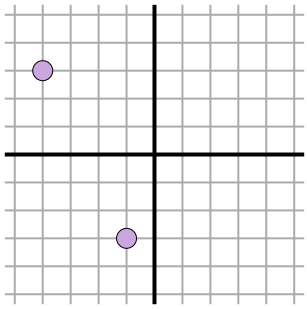

$\sqrt{(-4--1)^2 + (3--3)^2}$

$\sqrt{(9) + (36)}$

Risposte

Es.	7,3
1.	6,7
2.	7,2
3.	5
4.	5,4
5.	7,3
6.	3,6
7.	9,8
8.	3,6
9.	6,1
10.	4,5
11.	6,7