Trova la distante sulla griglia Nome:

Trova la distanza tra i punti. Arrotonda il risultato alla decina più vicina.

Es)

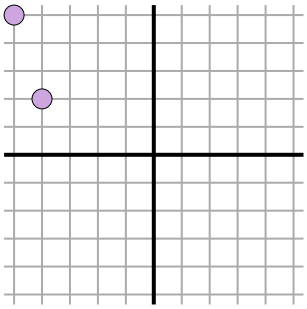

1)

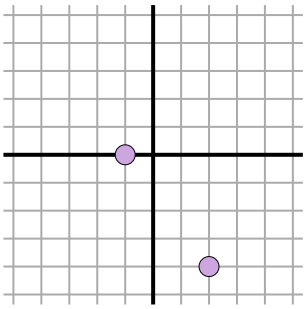

2)

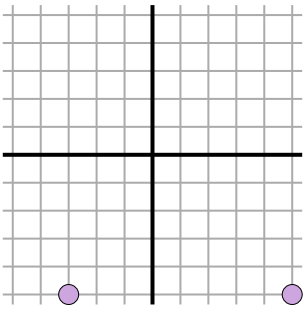

3)

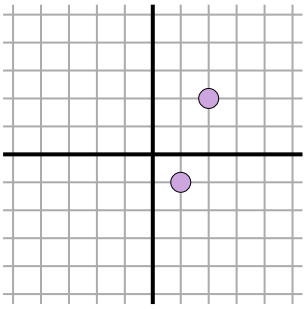

4)

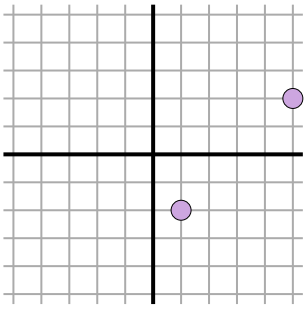

5)

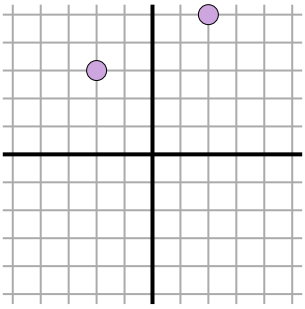

6)

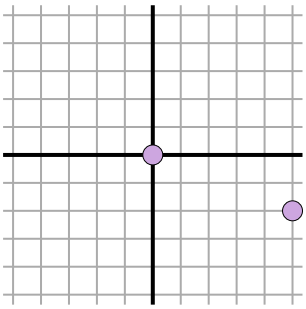

7)

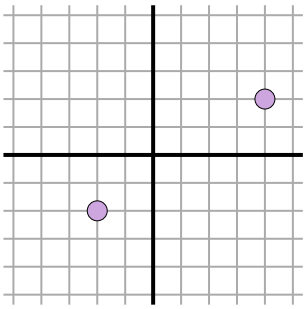

8)

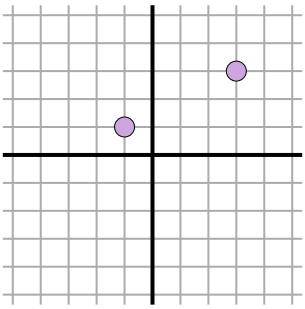

9)

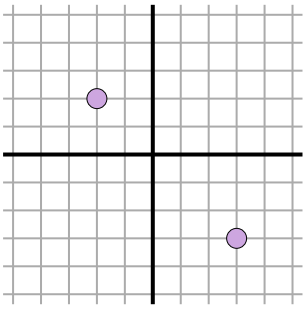

10)

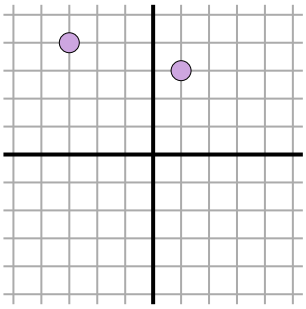

11)

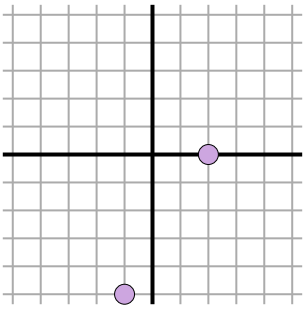

Risposte

Es. 3,2

1. _____
2. _____
3. _____
4. _____
5. _____
6. _____
7. _____
8. _____
9. _____
10. _____
11. _____

1-10	91	82	73	64	55	45	36	27	18	9
11	0									

Trova la distante sulla griglia

Nome: **Soluzioni**

Trova la distanza tra i punti. Arrotonda il risultato alla decina più vicina.

Es)

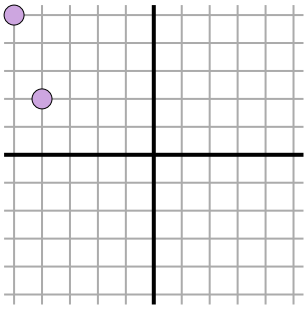

$\sqrt{(-5--4)^2 + (5-2)^2}$

$\sqrt{(1) + (9)}$

1)

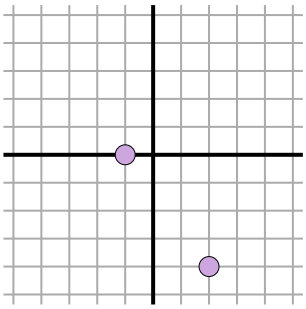

$\sqrt{(2--1)^2 + (-4-0)^2}$

$\sqrt{(9) + (16)}$

2)

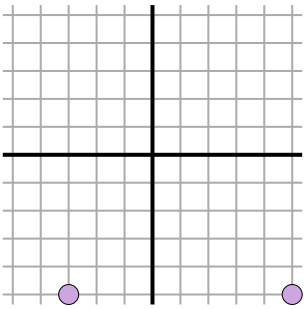

$\sqrt{(5--3)^2 + (-5--5)^2}$

$\sqrt{(64) + (0)}$

3)

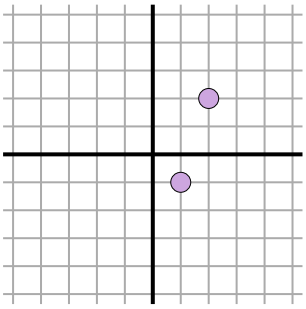

$\sqrt{(2-1)^2 + (2--1)^2}$

$\sqrt{(1) + (9)}$

4)

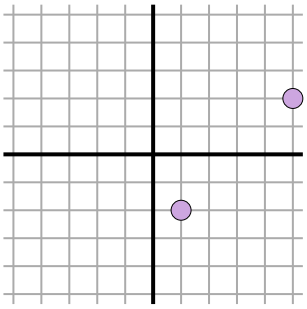

$\sqrt{(5-1)^2 + (2--2)^2}$

$\sqrt{(16) + (16)}$

5)

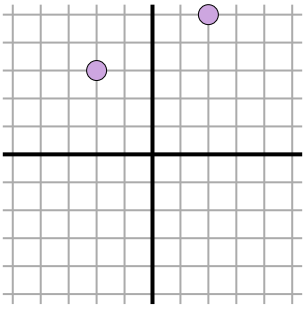

$\sqrt{(-2-2)^2 + (3-5)^2}$

$\sqrt{(16) + (4)}$

6)

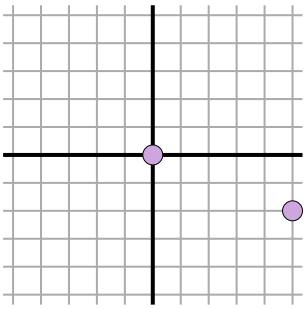

$\sqrt{(5-0)^2 + (-2-0)^2}$

$\sqrt{(25) + (4)}$

7)

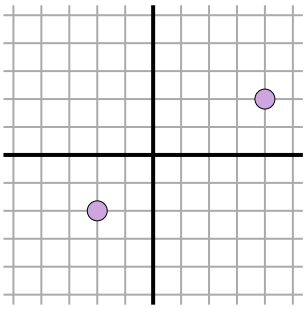

$\sqrt{(4--2)^2 + (2--2)^2}$

$\sqrt{(36) + (16)}$

8)

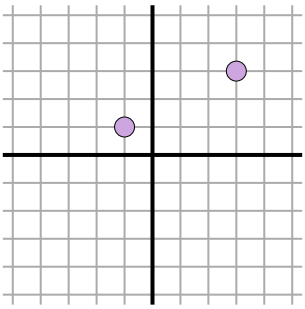

$\sqrt{(3--1)^2 + (3-1)^2}$

$\sqrt{(16) + (4)}$

9)

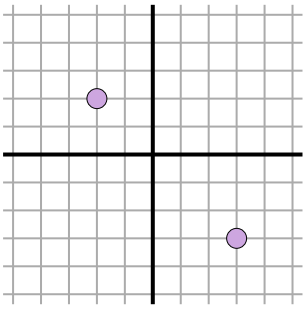

$\sqrt{(-2-3)^2 + (2--3)^2}$

$\sqrt{(25) + (25)}$

10)

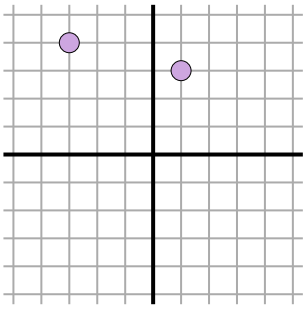

$\sqrt{(1--3)^2 + (3-4)^2}$

$\sqrt{(16) + (1)}$

11)

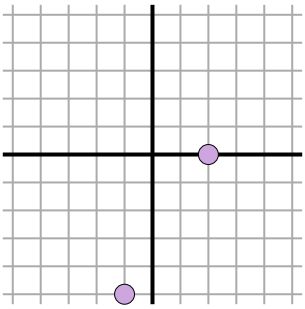

$\sqrt{(-1-2)^2 + (-5-0)^2}$

$\sqrt{(9) + (25)}$

Risposte

Es.	3,2
1.	5
2.	8
3.	3,2
4.	5,7
5.	4,5
6.	5,4
7.	7,2
8.	4,5
9.	7,1
10.	4,1
11.	5,8

1-10	91	82	73	64	55	45	36	27	18	9
11	0									