Creazione di rettangoli con una griglia di coordinate Nome:

Trova le coordinate del punto D per creare un rettangolo.

Es)

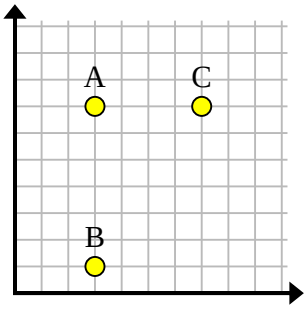

1)

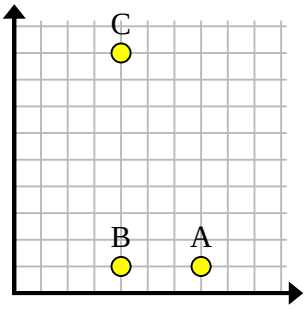

2)

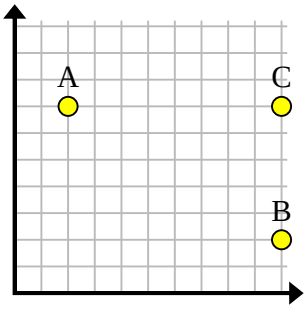

3)

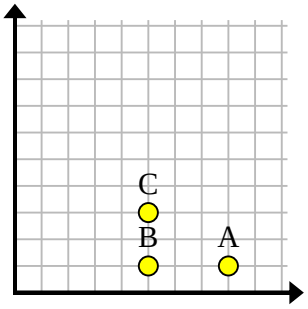

4)

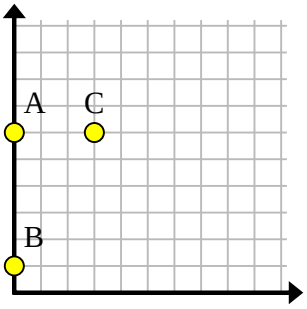

5)

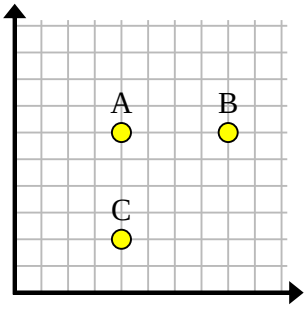

6)

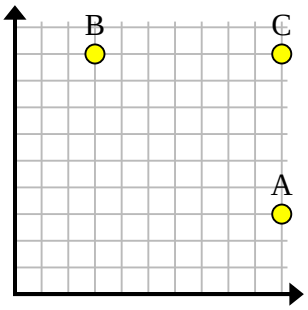

7)

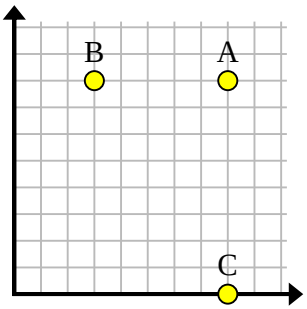

8)

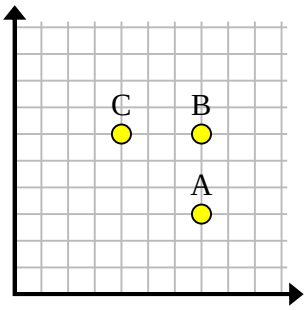

9)

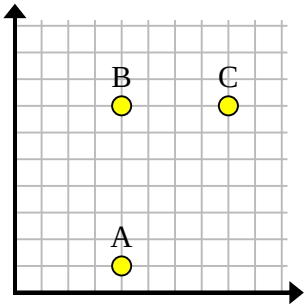

10)

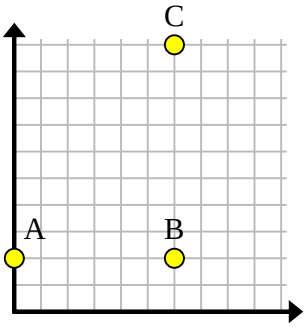

11)

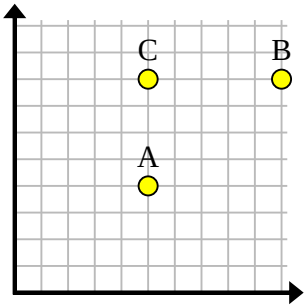

Risposte

Es. (7,1)

1. _____

2. _____

3. _____

4. _____

5. _____

6. _____

7. _____

8. _____

9. _____

10. _____

11. _____

Creazione di rettangoli con una griglia di coordinate Nome: **Soluzioni**

Trova le coordinate del punto D per creare un rettangolo.

Es)

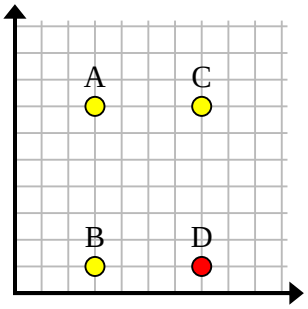

1)

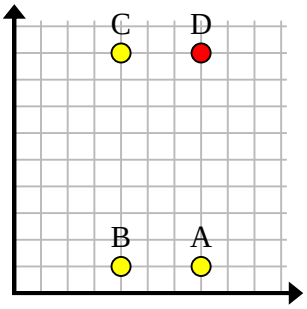

2)

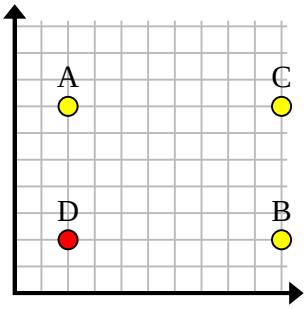

3)

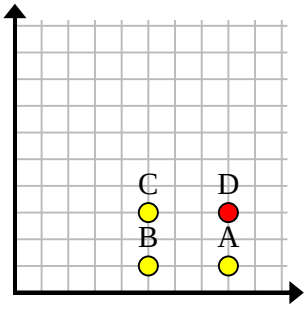

4)

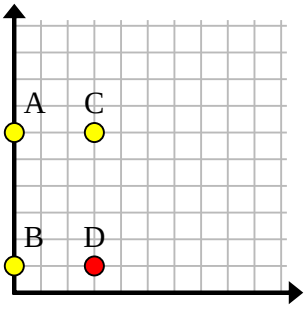

5)

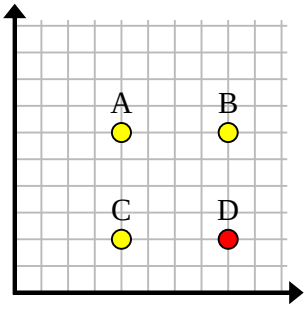

6)

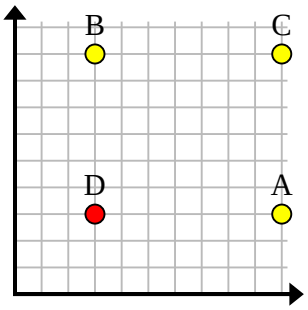

7)

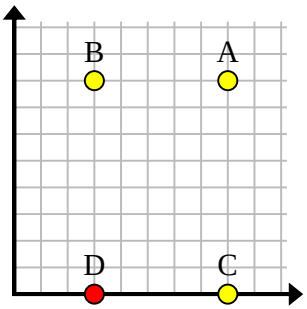

8)

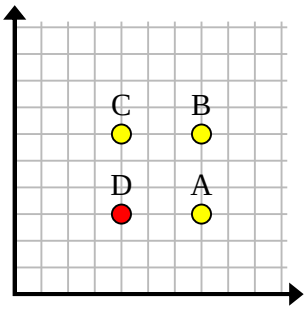

9)

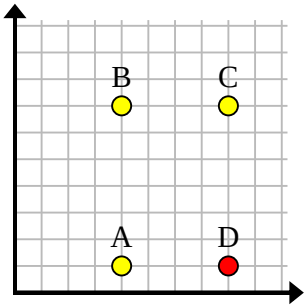

10)

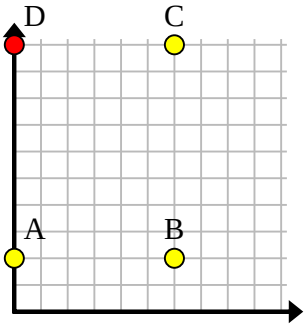

11)

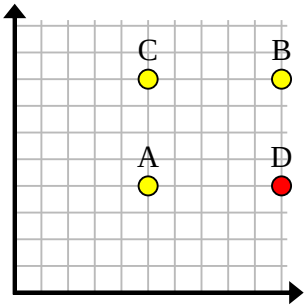

Risposte

Es.	(7 , 1)
1.	(7 , 9)
2.	(2 , 2)
3.	(8 , 3)
4.	(3 , 1)
5.	(8 , 2)
6.	(3 , 3)
7.	(3 , 0)
8.	(4 , 3)
9.	(8 , 1)
10.	(0 , 10)
11.	(10 , 4)