Creazione di rettangoli con una griglia di coordinate Nome:

Trova le coordinate del punto D per creare un rettangolo.

Es)

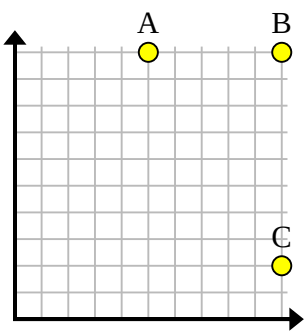

1)

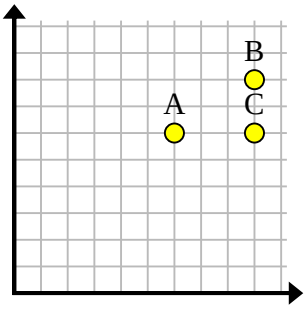

2)

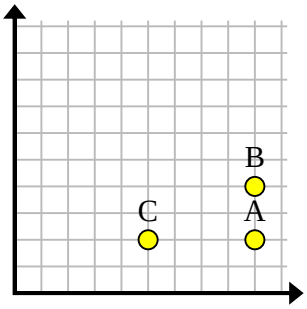

3)

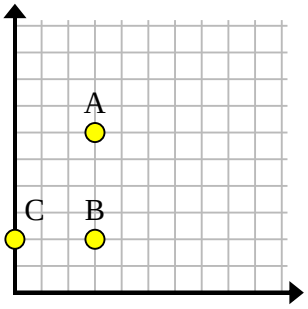

4)

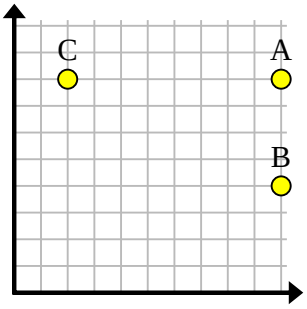

5)

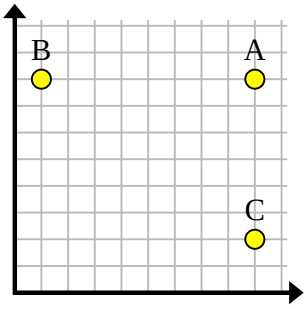

6)

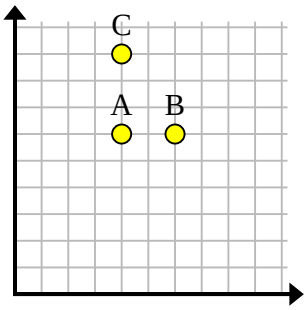

7)

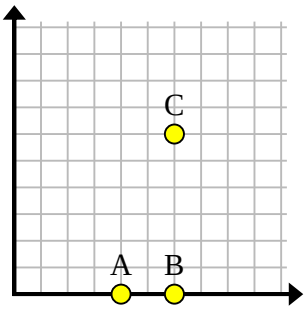

8)

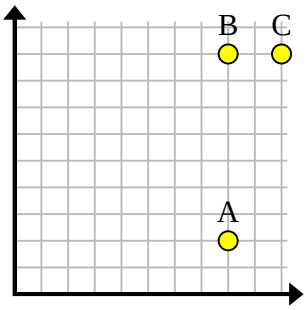

9)

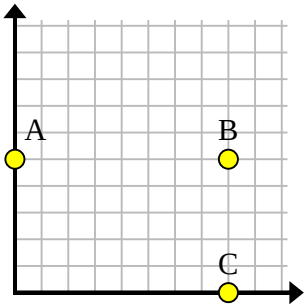

10)

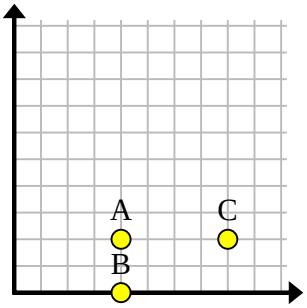

11)

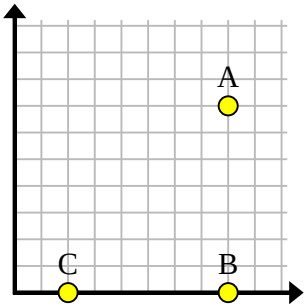

Risposte

Es. (5,2)

1. _____
2. _____
3. _____
4. _____
5. _____
6. _____
7. _____
8. _____
9. _____
10. _____
11. _____

1-10	91	82	73	64	55	45	36	27	18	9
11	0									

Creazione di rettangoli con una griglia di coordinate Nome: **Soluzioni**

Trova le coordinate del punto D per creare un rettangolo.

Es)

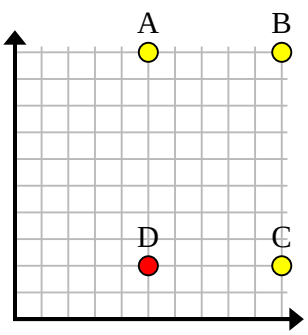

1)

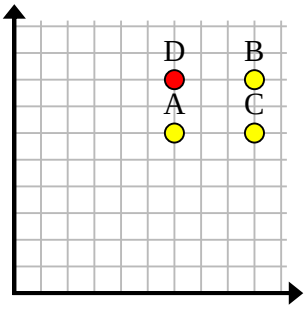

2)

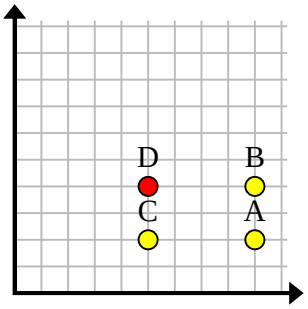

3)

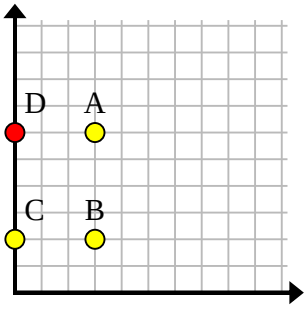

4)

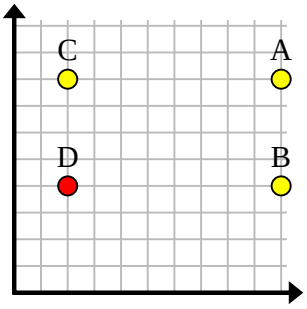

5)

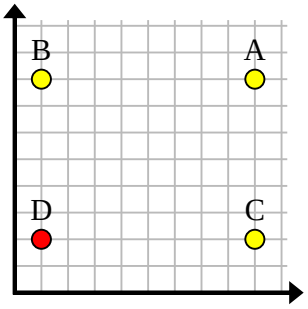

6)

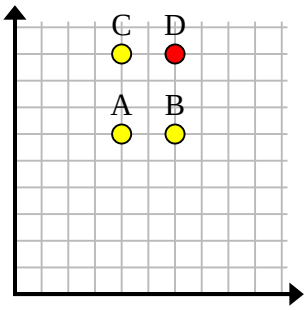

7)

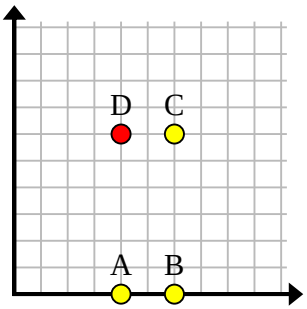

8)

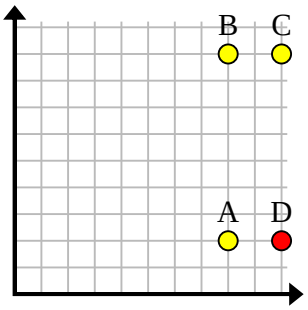

9)

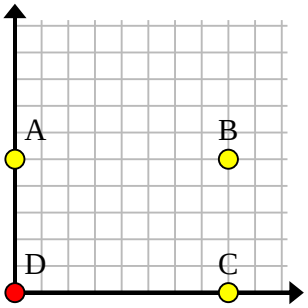

10)

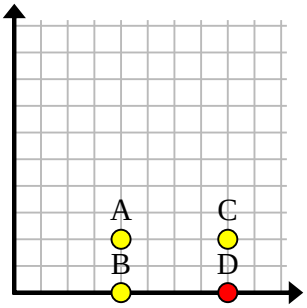

11)

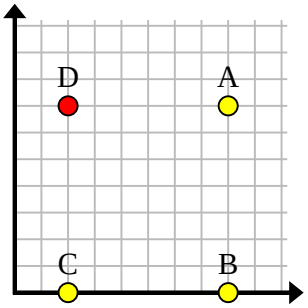

Risposte

Es.	(5,2)
1.	(6,8)
2.	(5,4)
3.	(0,6)
4.	(2,4)
5.	(1,2)
6.	(6,9)
7.	(4,6)
8.	(10,2)
9.	(0,0)
10.	(8,0)
11.	(2,7)

1-10	91	82	73	64	55	45	36	27	18	9
11	0									