Determina le frazioni relative alla metà Nome:

Determina se la parte colorata è 'più', 'meno' o 'uguale' alla metà.

1) 

2) 

3) 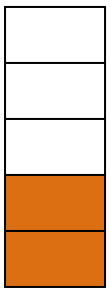

4)

5) 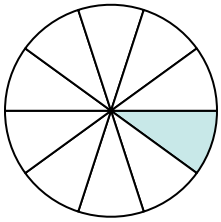

6) 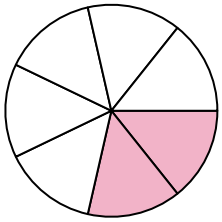

7) 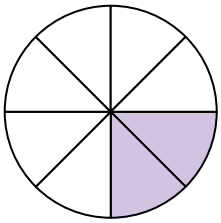

8)

9) 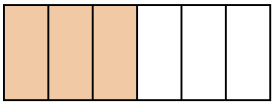

10) 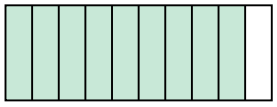

11)

12) 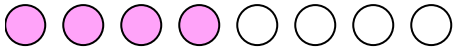

13) 

14) 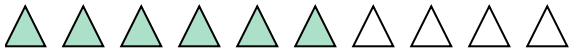

15)

16) 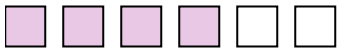

17)

18) 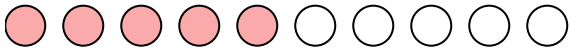

19) 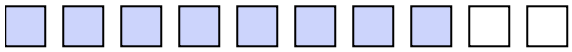

20)

Risposte

1. _____
2. _____
3. _____
4. _____
5. _____
6. _____
7. _____
8. _____
9. _____
10. _____
11. _____
12. _____
13. _____
14. _____
15. _____
16. _____
17. _____
18. _____
19. _____
20. _____

1-10	95	90	85	80	75	70	65	60	55	50
11-20	45	40	35	30	25	20	15	10	5	0

Determina le frazioni relative alla metà

Nome: **Soluzioni**

Determina se la parte colorata è 'più', 'meno' o 'uguale' alla metà.

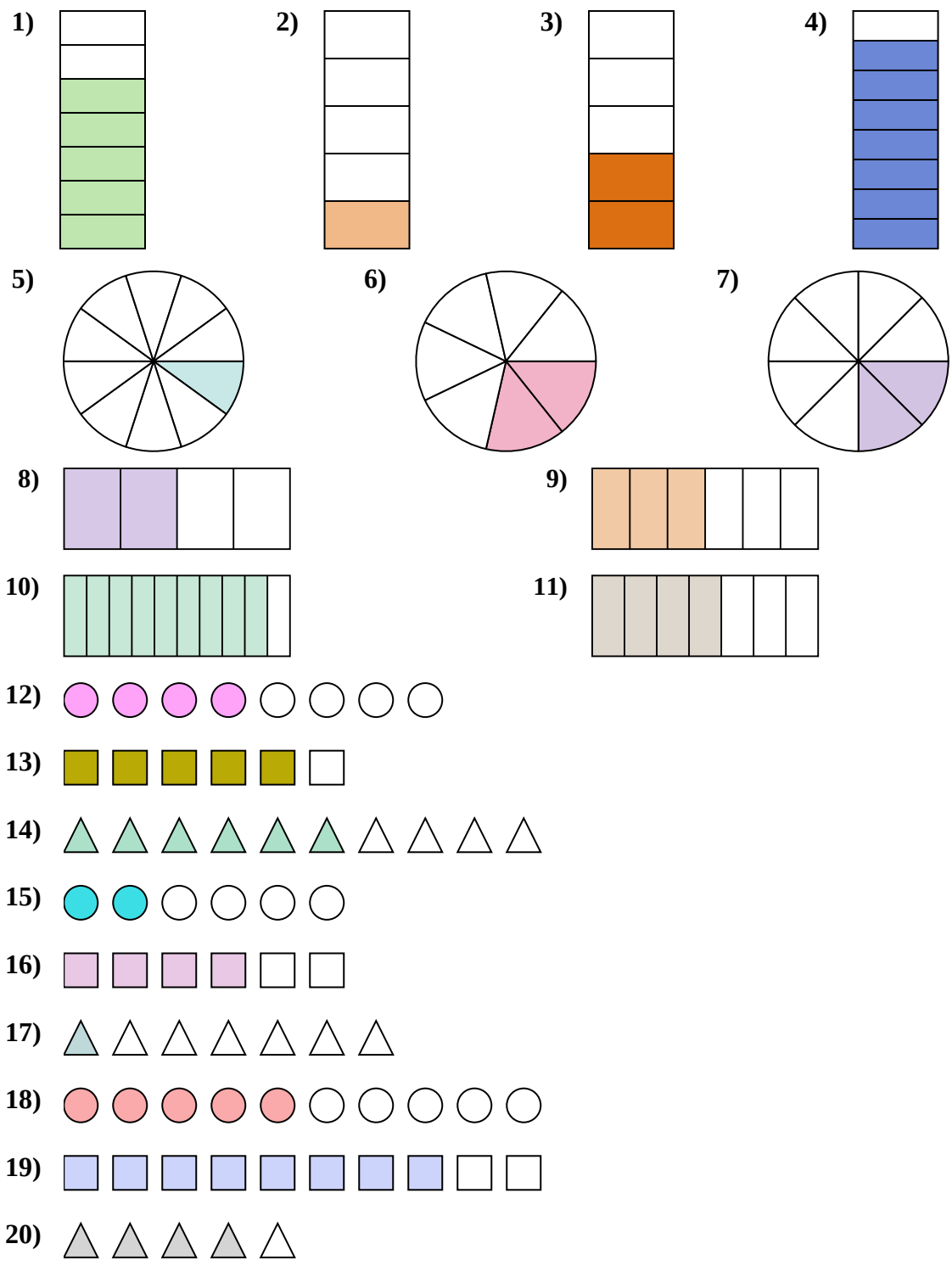

Risposte

1. maggiore
2. minore
3. minore
4. maggiore
5. minore
6. minore
7. minore
8. uguale
9. uguale
10. maggiore
11. maggiore
12. uguale
13. maggiore
14. maggiore
15. minore
16. maggiore
17. minore
18. uguale
19. maggiore
20. maggiore

1-10	95	90	85	80	75	70	65	60	55	50
11-20	45	40	35	30	25	20	15	10	5	0