Frazioni improprie e miste rappresentate Nome:

Scrivi ogni quantità come un numero misto.

1) 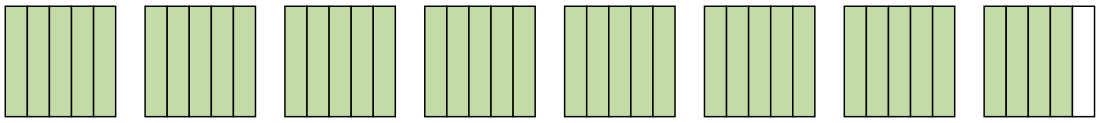

2) 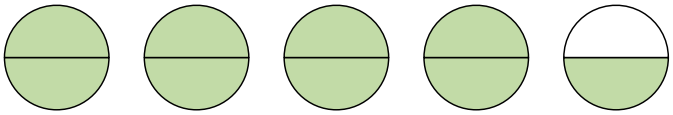

3) 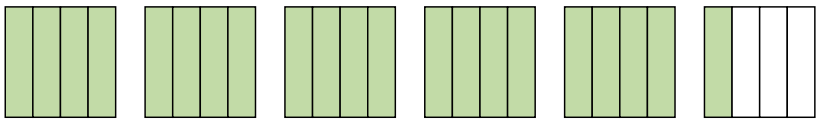

4) 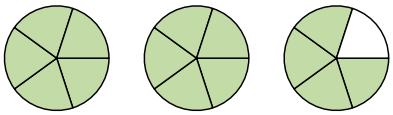

5) 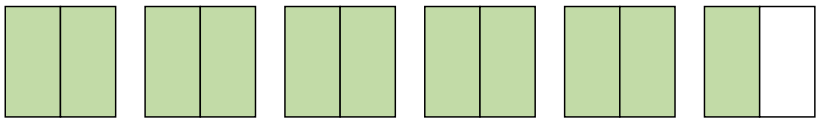

Scrivi ogni quantità come una frazione impropria.

6) 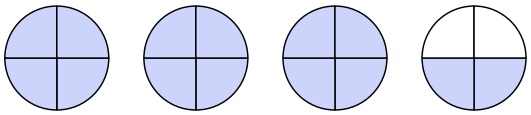

7) 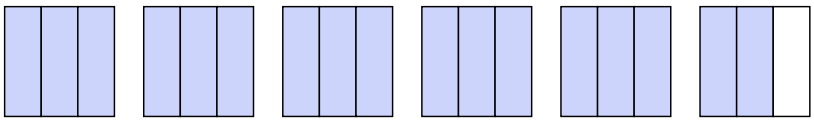

8) 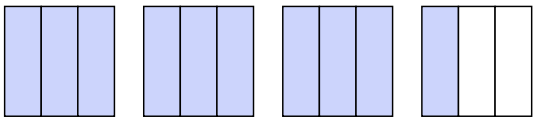

9) 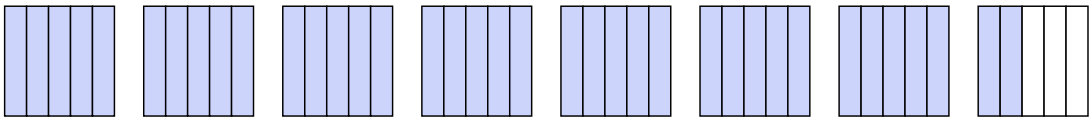

10) 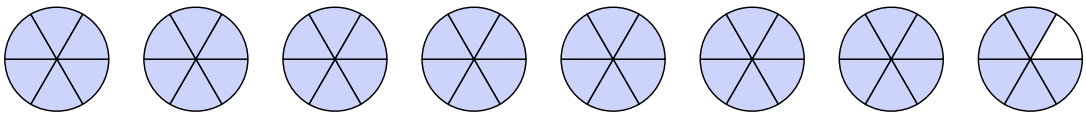

11) 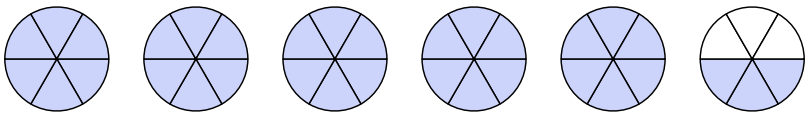

Risposte

1. _____
2. _____
3. _____
4. _____
5. _____
6. _____
7. _____
8. _____
9. _____
10. _____
11. _____

1-10	91	82	73	64	55	45	36	27	18	9
11	0									

Frazioni improprie e miste rappresentate

Nome: **Soluzioni**

Scrivi ogni quantità come un numero misto.

1) 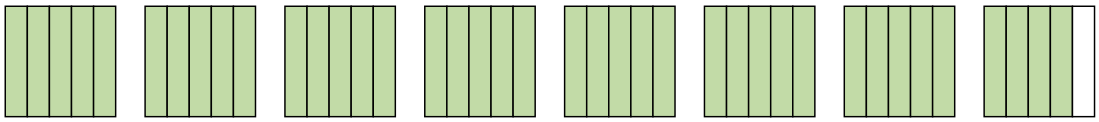

2) 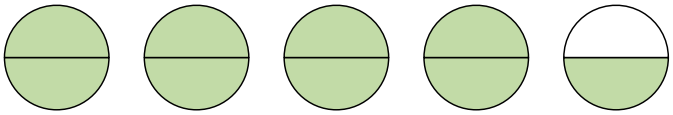

3) 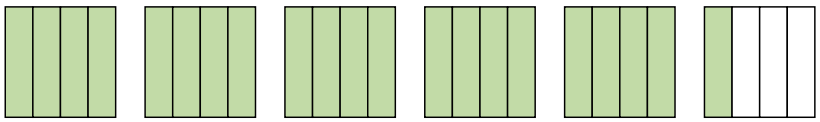

4) 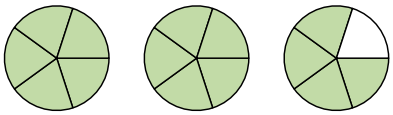

5) 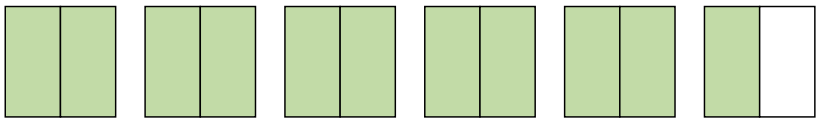

Scrivi ogni quantità come una frazione impropria.

6) 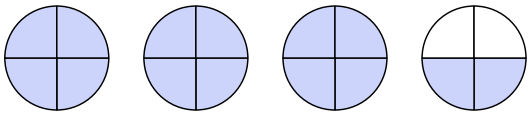

7) 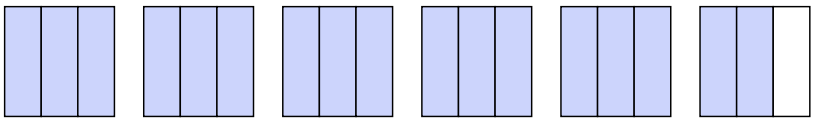

8) 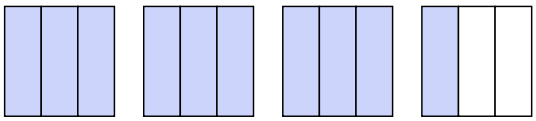

9) 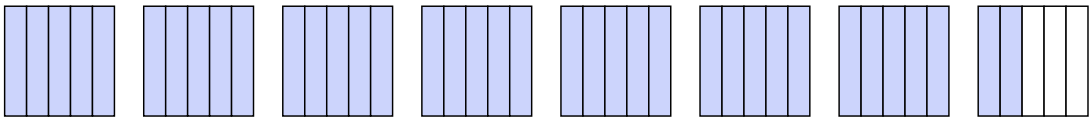

10) 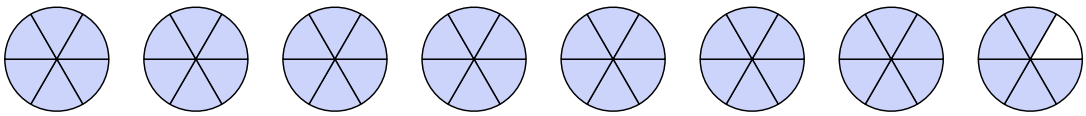

11) 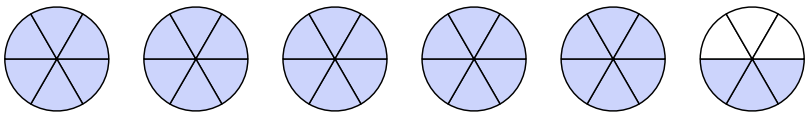

Risposte

1. $7\frac{4}{5}$
2. $4\frac{1}{2}$
3. $5\frac{1}{4}$
4. $2\frac{4}{5}$
5. $5\frac{1}{2}$
6. $\frac{14}{4}$
7. $\frac{17}{3}$
8. $\frac{10}{3}$
9. $\frac{37}{5}$
10. $\frac{47}{6}$
11. $\frac{33}{6}$

1-10	91	82	73	64	55	45	36	27	18	9
11	0									