# Identifica la suddivisione delle forme

Nome:

**Determina quale scelta (scelte) mostri la forma suddivisa in modo che ogni parte abbia la stessa area. Se nessuna, scrivi 'nessuna'.**

**1)** A.  B. 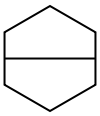 C.  D.

**2)** A. 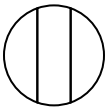 B. 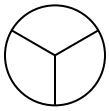 C. 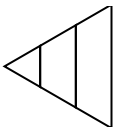 D.

**3)** A. 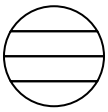 B.  C. 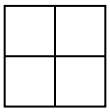 D. 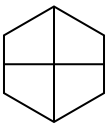

**4)** A. 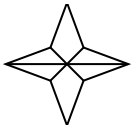 B. 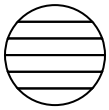 C. 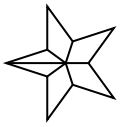 D. 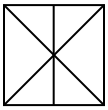

**5)** A. 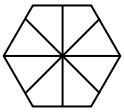 B. 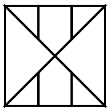 C. 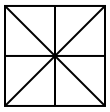 D. 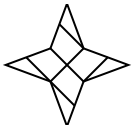

**6)** A. 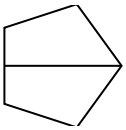 B. 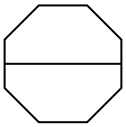 C.  D. 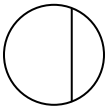

**7)** A.  B. 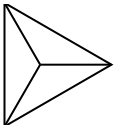 C. D. 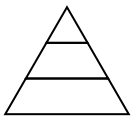

**8)** A. 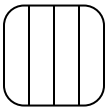 B. 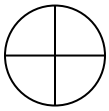 C. 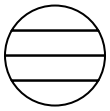 D.

**Risposte**

1. _____
2. _____
3. _____
4. _____
5. _____
6. _____
7. _____
8. _____



| 1-8 | 88 | 75 | 63 | 50 | 38 | 25 | 13 | 0 |
|---|---|---|---|---|---|---|---|---|

Identifica la suddivisione delle forme Nome: **Soluzioni**

**Determina quale scelta (scelte) mostri la forma suddivisa in modo che ogni parte abbia la stessa area. Se nessuna, scrivi 'nessuna'.**

**1)** A.  B. 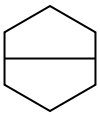 C.  D.

**2)** A. 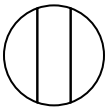 B. 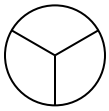 C. 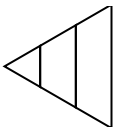 D.

**3)** A. 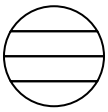 B.  C. 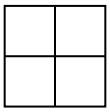 D. 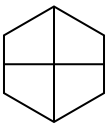

**4)** A. 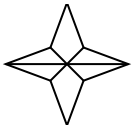 B. 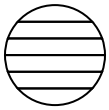 C. 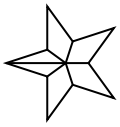 D. 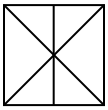

**5)** A. 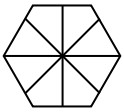 B. 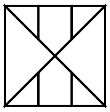 C. 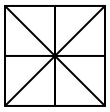 D. 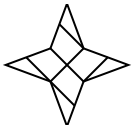

**6)** A. 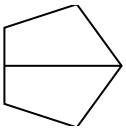 B. 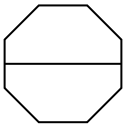 C.  D. 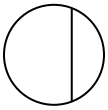

**7)** A.  B. 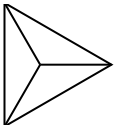 C. D. 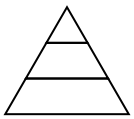

**8)** A. 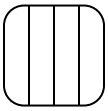 B. 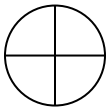 C. 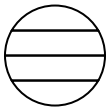 D.

**Risposte**

1. **A,B,C**
2. **B**
3. **B,C,D**
4. **nessuna**
5. **C**
6. **A,B,C**
7. **A,B**
8. **B,D**



| 1-8 | 88 | 75 | 63 | 50 | 38 | 25 | 13 | 0 |
|---|---|---|---|---|---|---|---|---|