Risolvi ogni problema.

1) Indica la posizione di $^{8}/_{5}$



2) Indica la posizione di $^{14}/_{7}$

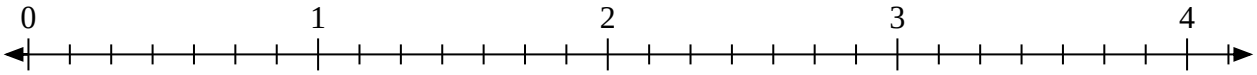

3) Indica la posizione di $^{10}/_{6}$

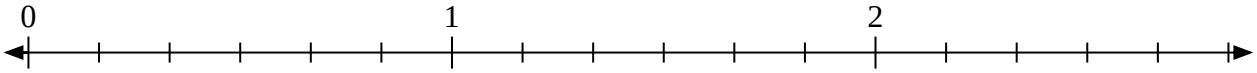

4) Indica la posizione di $^{7}/_{3}$

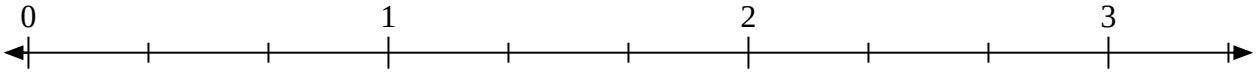

5) Indica la posizione di $^{3}/_{2}$



6) Indica la posizione di $^{11}/_{5}$

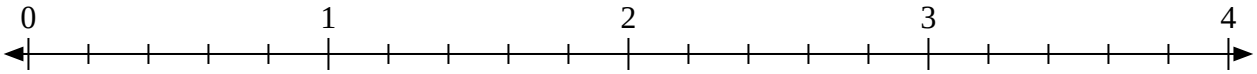

7) Indica la posizione di $^{15}/_{9}$

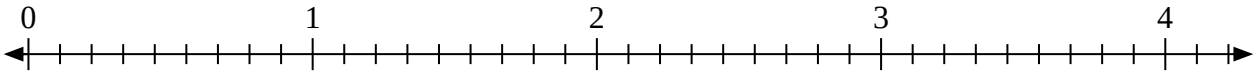

8) Indica la posizione di $^{21}/_{9}$

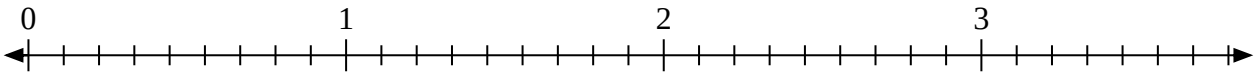

9) Indica la posizione di $^{8}/_{7}$

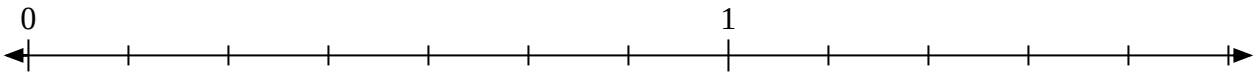

10) Indica la posizione di $^{6}/_{2}$



1-10	90	80	70	60	50	40	30	20	10	0

Identificazione di frazioni e decimali su una ruota numerica Nome: **Soluzioni**

Risolvi ogni problema.

1) Indica la posizione di $^{8}/_{5}$

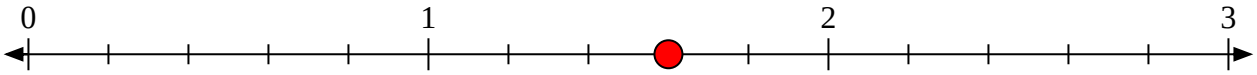

2) Indica la posizione di $^{14}/_{7}$

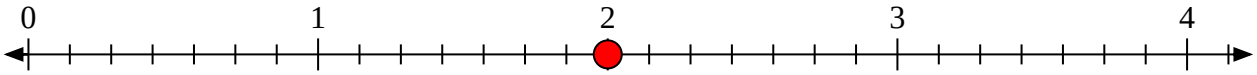

3) Indica la posizione di $^{10}/_{6}$

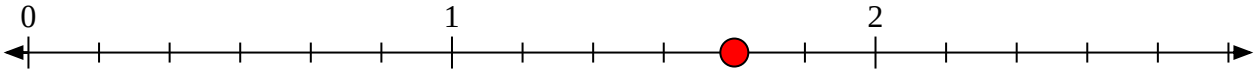

4) Indica la posizione di $^{7}/_{3}$

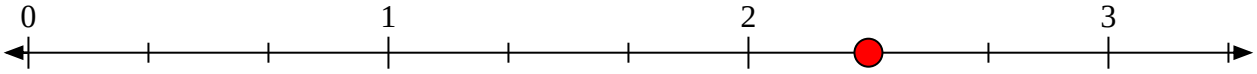

5) Indica la posizione di $^{3}/_{2}$



6) Indica la posizione di $^{11}/_{5}$

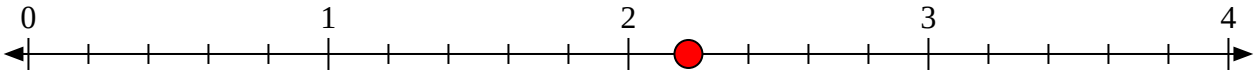

7) Indica la posizione di $^{15}/_{9}$

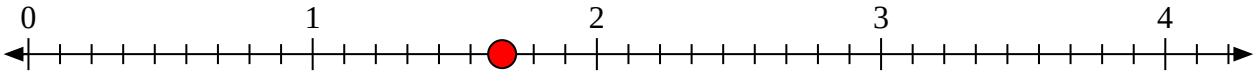

8) Indica la posizione di $^{21}/_{9}$

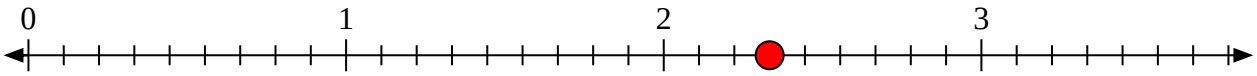

9) Indica la posizione di $^{8}/_{7}$

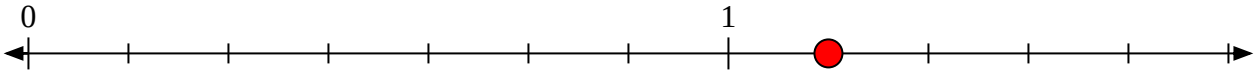

10) Indica la posizione di $^{6}/_{2}$



1-10	90	80	70	60	50	40	30	20	10	0