**Risolvi ogni problema.**

**1)** Indica la posizione di $^{11}/_{6}$




**2)** Indica la posizione di $^{14}/_{7}$

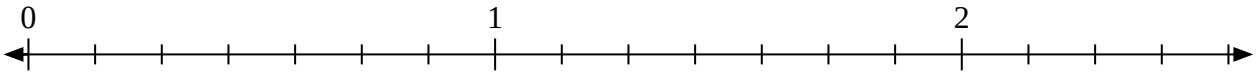


**3)** Indica la posizione di $^{6}/_{4}$




**4)** Indica la posizione di $^{11}/_{8}$

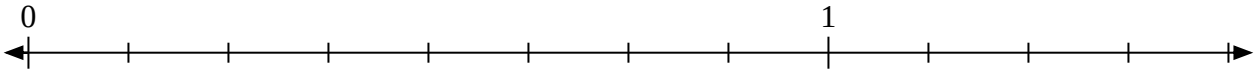


**5)** Indica la posizione di $^{8}/_{4}$

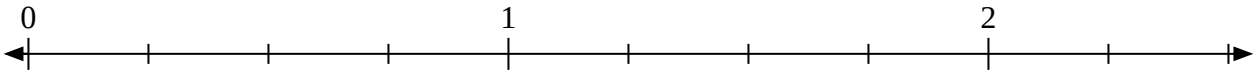


**6)** Indica la posizione di $^{15}/_{6}$

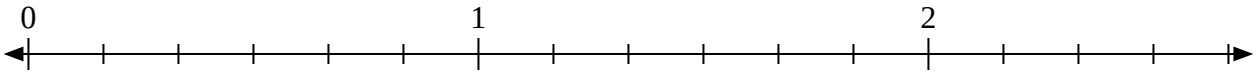


**7)** Indica la posizione di $^{12}/_{5}$

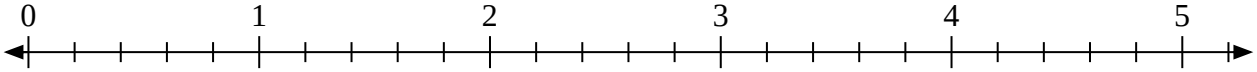


**8)** Indica la posizione di $^{11}/_{9}$

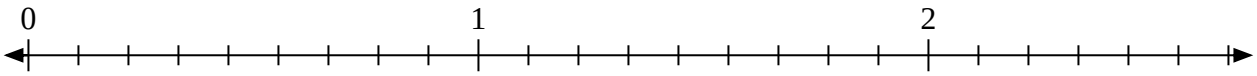


**9)** Indica la posizione di $^{14}/_{8}$

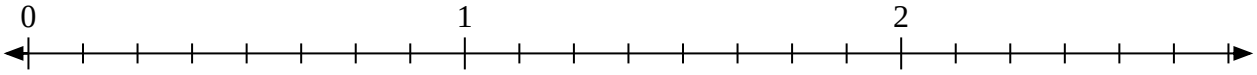


**10)** Indica la posizione di $^{9}/_{6}$

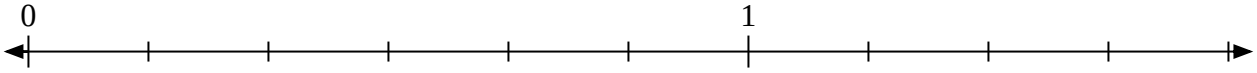




| 1-10 | 90 | 80 | 70 | 60 | 50 | 40 | 30 | 20 | 10 | 0 |
|---|---|---|---|---|---|---|---|---|---|---|

Identificazione di frazioni e decimali su una ruota numerica Nome: **Soluzioni**

**Risolvi ogni problema.**

**1)** Indica la posizione di $^{11}/_{6}$




**2)** Indica la posizione di $^{14}/_{7}$

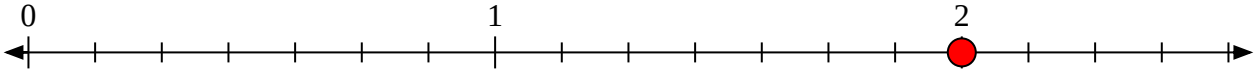


**3)** Indica la posizione di $^{6}/_{4}$

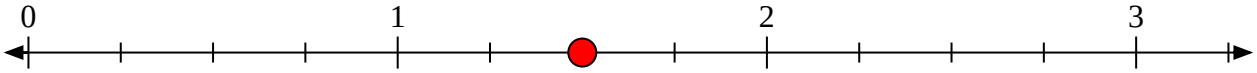


**4)** Indica la posizione di $^{11}/_{8}$

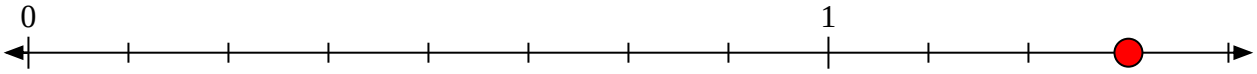


**5)** Indica la posizione di $^{8}/_{4}$

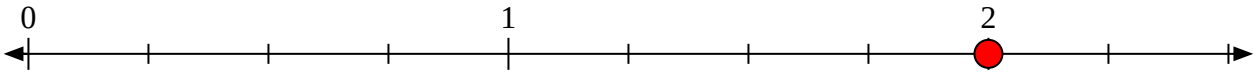


**6)** Indica la posizione di $^{15}/_{6}$

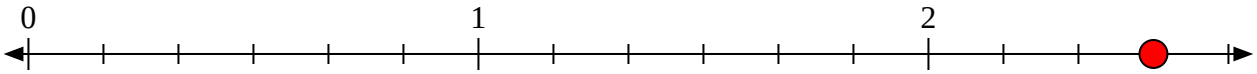


**7)** Indica la posizione di $^{12}/_{5}$

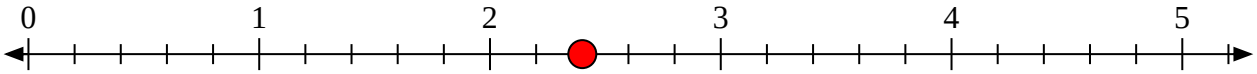


**8)** Indica la posizione di $^{11}/_{9}$

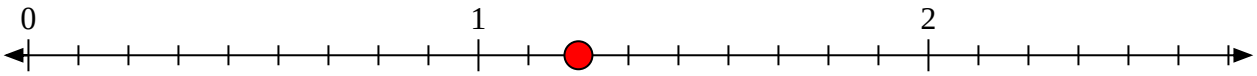


**9)** Indica la posizione di $^{14}/_{8}$

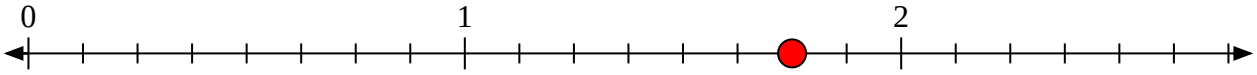


**10)** Indica la posizione di $^{9}/_{6}$

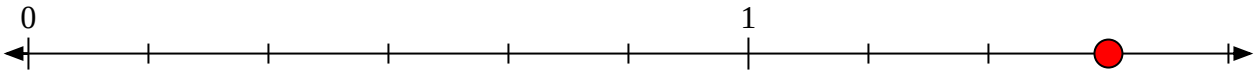




| 1-10 | 90 | 80 | 70 | 60 | 50 | 40 | 30 | 20 | 10 | 0 |
|---|---|---|---|---|---|---|---|---|---|---|