Trovare la posizione della frazione

Nome:

Scrivi la posizione di ogni frazione.

1) Indica la posizione di $1\frac{1}{4}$

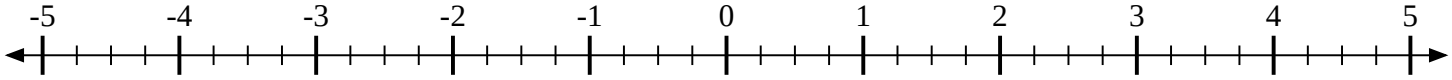

2) Indica la posizione di $-1\frac{7}{9}$

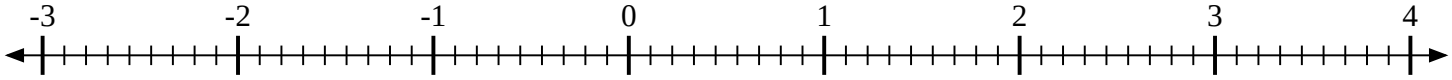

3) Indica la posizione di $1\frac{1}{9}$

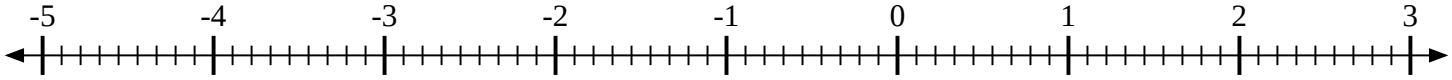

4) Indica la posizione di $-1\frac{1}{3}$

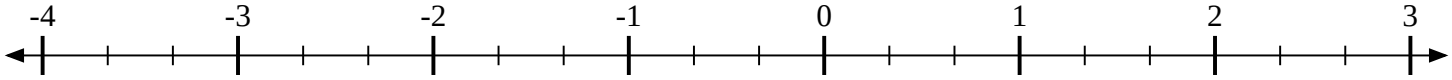

5) Indica la posizione di $1\frac{2}{3}$

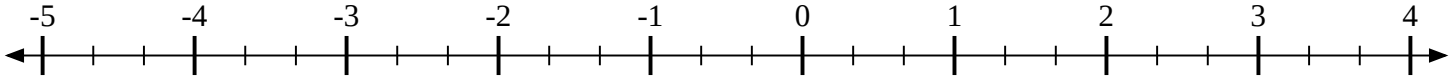

6) Indica la posizione di $\frac{2}{6}$

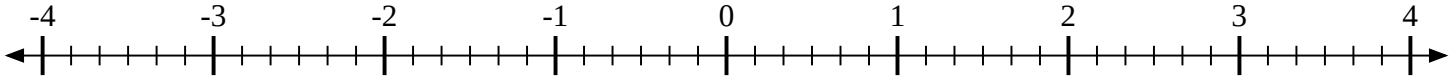

7) Indica la posizione di $1\frac{1}{8}$

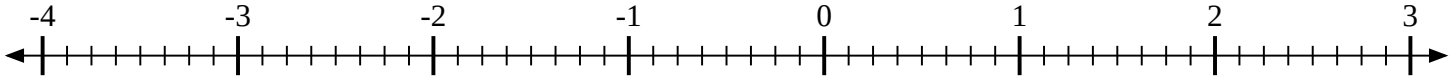

8) Indica la posizione di $-4\frac{5}{6}$

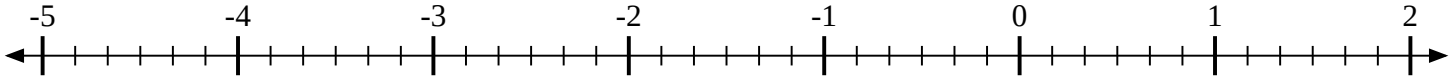

9) Indica la posizione di $-2\frac{2}{5}$

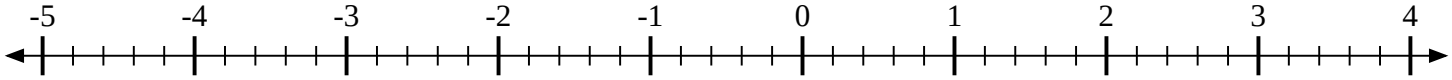

Trovare la posizione della frazione Nome: **Soluzioni**

Scrivi la posizione di ogni frazione.

1) Indica la posizione di $1\frac{1}{4}$

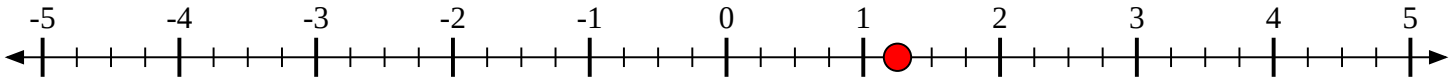

2) Indica la posizione di $-1\frac{7}{9}$

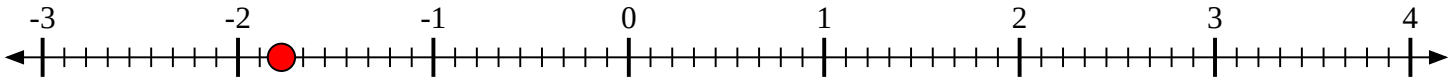

3) Indica la posizione di $1\frac{1}{9}$

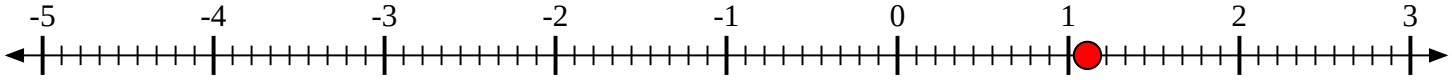

4) Indica la posizione di $-1\frac{1}{3}$

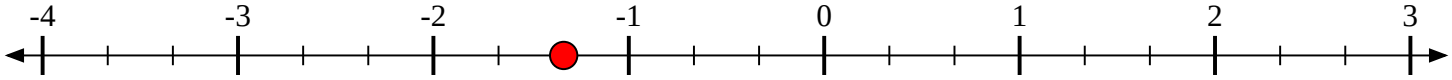

5) Indica la posizione di $1\frac{2}{3}$

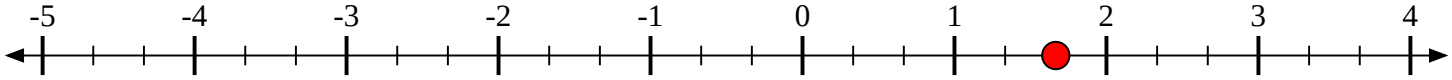

6) Indica la posizione di $\frac{2}{6}$

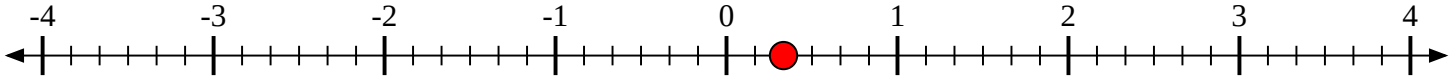

7) Indica la posizione di $1\frac{1}{8}$

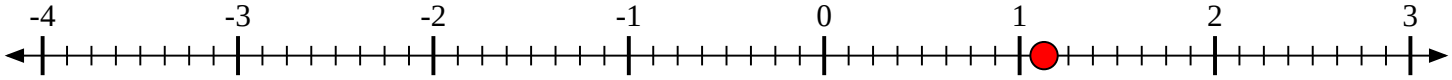

8) Indica la posizione di $-4\frac{5}{6}$

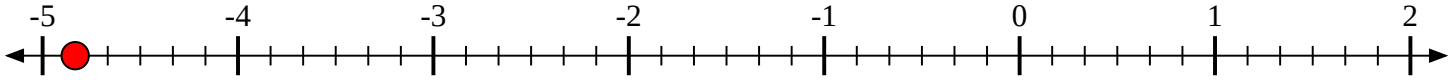
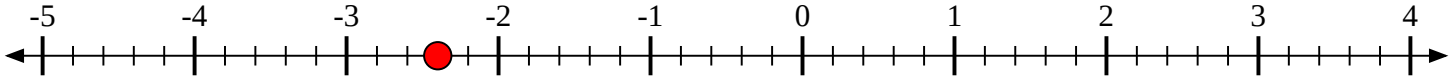
9) Indica la posizione di $-2\frac{2}{5}$