Trova le frazioni equivalenti - (graficamente) Nome:

Determina quale lettera rappresenta la frazione equivalente.

1) 

$\frac{6}{20}$

2) 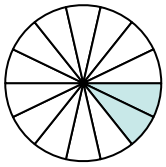

$\frac{2}{14}$

3) 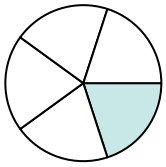

$\frac{1}{5}$

4) 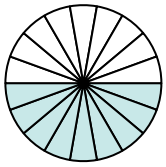

$\frac{9}{18}$

5) 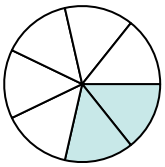

$\frac{2}{7}$

6) 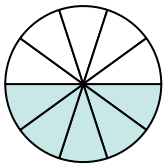

$\frac{5}{10}$

7) 

$\frac{12}{20}$

8) 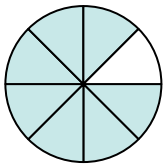

$\frac{7}{8}$

9) 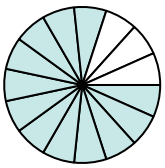

$\frac{12}{15}$

10) 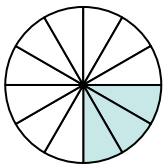

$\frac{3}{12}$

11) 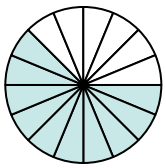

$\frac{10}{16}$

12) 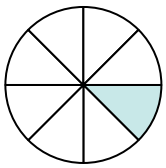

$\frac{1}{8}$

A. 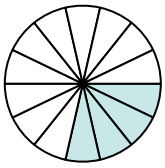

$\frac{4}{14}$

B. 

$\frac{10}{20}$

C. 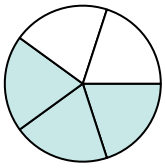

$\frac{3}{5}$

D. 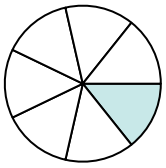

$\frac{1}{7}$

E. 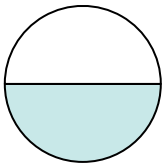

$\frac{1}{2}$

F. 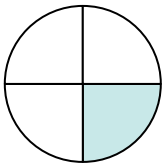

$\frac{1}{4}$

G. 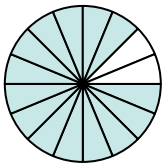

$\frac{14}{16}$

H. 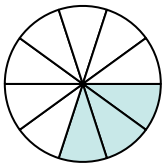

$\frac{3}{10}$

I. 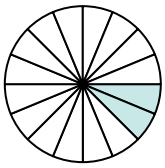

$\frac{2}{16}$

J. 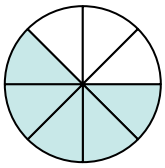

$\frac{5}{8}$

K. 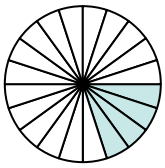

$\frac{4}{20}$

L. 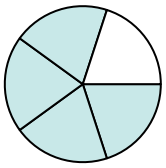

$\frac{4}{5}$

Risposte

1. _____
2. _____
3. _____
4. _____
5. _____
6. _____
7. _____
8. _____
9. _____
10. _____
11. _____
12. _____

1-10	92	83	75	67	58	50	42	33	25	17
11-12	8	0								

Trova le frazioni equivalenti - (graficamente) Nome: **Soluzioni**

Determina quale lettera rappresenta la frazione equivalente.

1)



$\frac{6}{20}$

2)

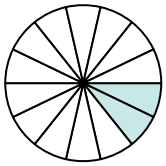

$\frac{2}{14}$

3)

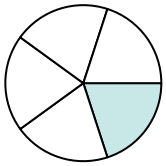

$\frac{1}{5}$

4)

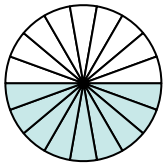

$\frac{9}{18}$

5)

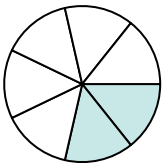

$\frac{2}{7}$

6)

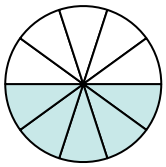

$\frac{5}{10}$

7)



$\frac{12}{20}$

8)

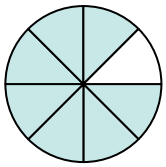

$\frac{7}{8}$

9)

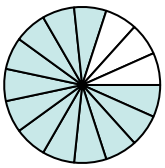

$\frac{12}{15}$

10)

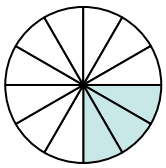

$\frac{3}{12}$

11)

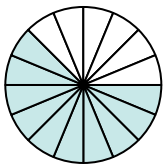

$\frac{10}{16}$

12)

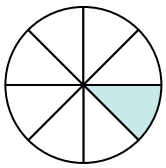

$\frac{1}{8}$

A.

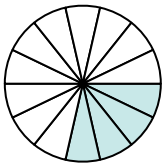

$\frac{4}{14}$

B.



$\frac{10}{20}$

C.

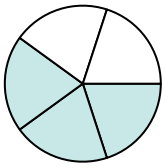

$\frac{3}{5}$

D.

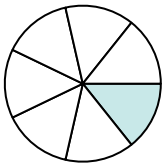

$\frac{1}{7}$

E.

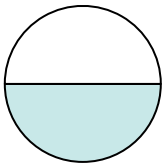

$\frac{1}{2}$

F.

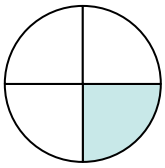

$\frac{1}{4}$

G.

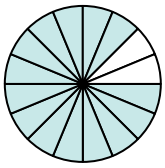

$\frac{14}{16}$

H.

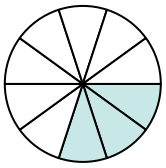

$\frac{3}{10}$

I.

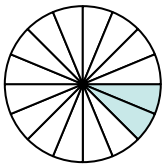

$\frac{2}{16}$

J.

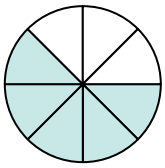

$\frac{5}{8}$

K.

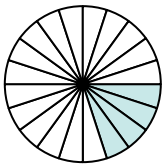

$\frac{4}{20}$

L.

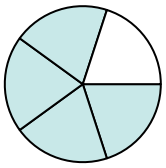

$\frac{4}{5}$

Risposte

1. H
2. D
3. K
4. E
5. A
6. B
7. C
8. G
9. L
10. F
11. J
12. I

1-10	92	83	75	67	58	50	42	33	25	17
11-12	8	0								