Esprimere le frazioni come parole

Nome:

Scrivi l'importo ombreggiato sotto forma di parole.

Es)



1)

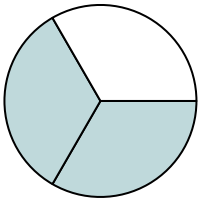

2)



3)

4)



5)

6)

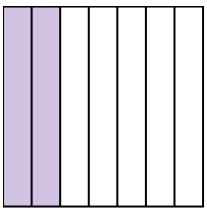

7)

8)

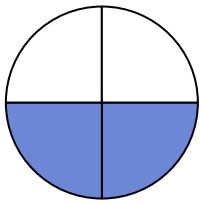

9)



10)



11)



12)

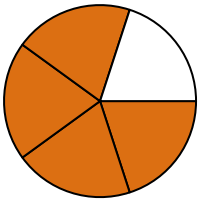

13)

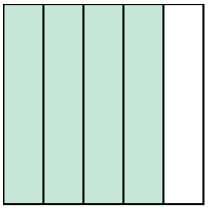

14)



Risposte

Es. metà

1. _____
2. _____
3. _____
4. _____
5. _____
6. _____
7. _____
8. _____
9. _____
10. _____
11. _____
12. _____
13. _____
14. _____

1-10	93	86	79	71	64	57	50	43	36	29
11-14	21	14	7	0						

Esprimere le frazioni come parole

Nome: **Soluzioni**

Scrivi l'importo ombreggiato sotto forma di parole.

Es)



1)

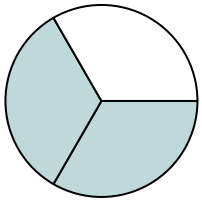

2)



3)

4)



5)

6)

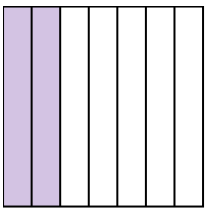

7)

8)

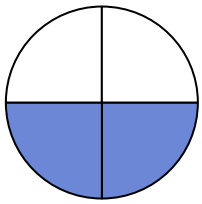

9)



10)



11)



12)

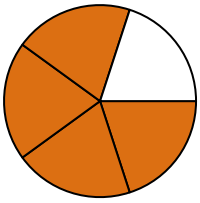

13)

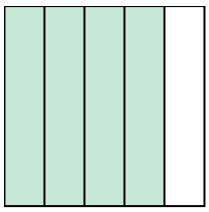

14)



Risposte

Es. metà

1. due terzi
2. nove decimi
3. tre sesti
4. un quarto
5. cinque sesti
6. due settimi
7. due decimi
8. due quarti
9. quattro ottavi
10. cinque noni
11. sette noni
12. quattro quinti
13. quattro quinti
14. un terzo

1-10	93	86	79	71	64	57	50	43	36	29
11-14	21	14	7	0						