Esprimere le frazioni come parole

Nome:

Scrivi l'importo ombreggiato sotto forma di parole.

Es)



1)

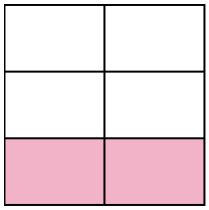

2)

3)

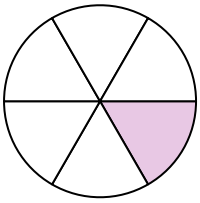

4)

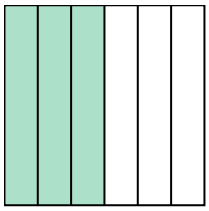

5)

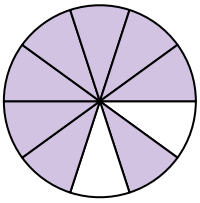

6)

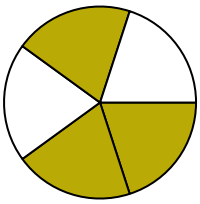

7)

8)

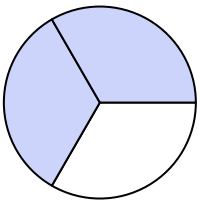

9)

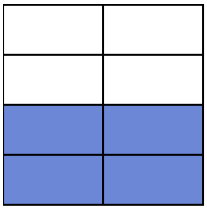

10)

11)



12)

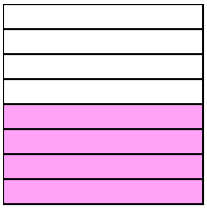

13)



14)

Risposte

Es. metà

1. _____
2. _____
3. _____
4. _____
5. _____
6. _____
7. _____
8. _____
9. _____
10. _____
11. _____
12. _____
13. _____
14. _____

1-10	93	86	79	71	64	57	50	43	36	29
11-14	21	14	7	0						

Esprimere le frazioni come parole

Nome: **Soluzioni**

Scrivi l'importo ombreggiato sotto forma di parole.

Es)



1)

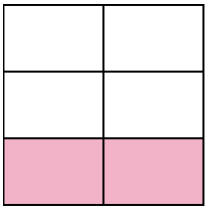

2)

3)

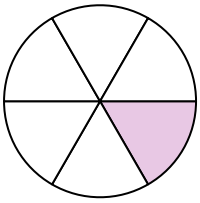

4)

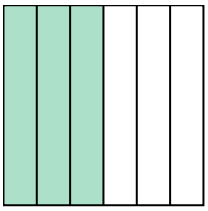

5)

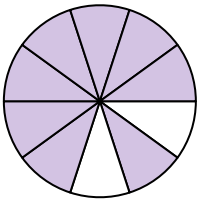

6)

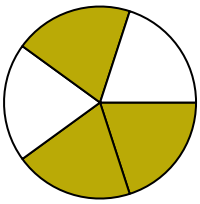

7)



8)

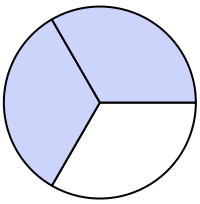

9)

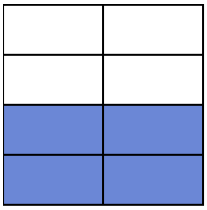

10)

11)



12)

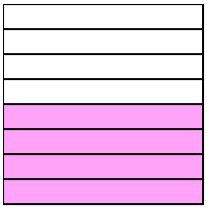

13)



14)

Risposte

Es. metà

1. due quinti
2. due noni
3. un sesto
4. tre sesti
5. otto decimi
6. tre quinti
7. tre quarti
8. due terzi
9. quattro settimi
10. un decimo
11. due terzi
12. quattro ottavi
13. metà
14. un quarto

1-10	93	86	79	71	64	57	50	43	36	29
11-14	21	14	7	0						