Divisione tra frazioni e numeri interi (graficamente)

Nome:

Usa lo schema per mostrare come si dividono una frazione e un numero intero.

$\frac{1}{3} \div 4 = ?$



Para resolverlo, comience con un todo.

Divida el conjunto en 3 piezas y complete 1 sección.

Ahora puedes ver el tamaño de $\frac{1}{3}$

Em seguida, divida a $\frac{1}{3}$ em 4 grupos.

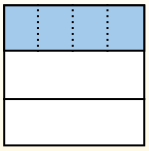

Esto muestra el tamaño de cada pieza.

Para calcular el tamaño de cada pieza en comparación con el conjunto, divida el conjunto en 4 grupos.

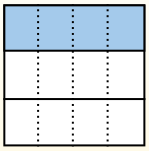

Each piece is $\frac{1}{12}$ of the whole.
Or:
$\frac{1}{3} \div 4 = \frac{1}{12}$

1) $\frac{1}{5}:2 =$

2) $\frac{1}{7}:3 =$

3) $\frac{1}{6}:7 =$

4) $\frac{1}{3}:4 =$

5) $\frac{1}{2}:6 =$

6) $\frac{1}{5}:4 =$

7) $\frac{1}{9}:8 =$

8) $\frac{1}{9}:7 =$

9) $\frac{1}{2}:9 =$

10) $\frac{1}{2}:3 =$

11) $\frac{1}{8}:3 =$

12) $\frac{1}{9}:3 =$

Risposte

1. _____
2. _____
3. _____
4. _____
5. _____
6. _____
7. _____
8. _____
9. _____
10. _____
11. _____
12. _____

1-10	92	83	75	67	58	50	42	33	25	17
11-12	8	0								

Divisione tra frazioni e numeri interi (graficamente) Nome: **Soluzioni**

Usa lo schema per mostrare come si dividono una frazione e un numero intero.

$\frac{1}{3} \div 4 = ?$



Para resolverlo, comience con un todo.

Divida el conjunto en 3 piezas y complete 1 sección.

Ahora puedes ver el tamaño de $\frac{1}{3}$

Em seguida, divida a $\frac{1}{3}$ em 4 grupos.

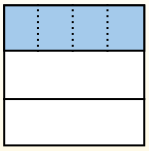

Esto muestra el tamaño de cada pieza.

Para calcular el tamaño de cada pieza en comparación con el conjunto, divida el conjunto en 4 grupos.

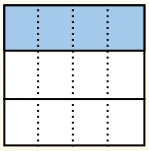

Each piece is $\frac{1}{12}$ of the whole.
Or:
$\frac{1}{3} \div 4 = \frac{1}{12}$

1) $\frac{1}{5}:2 =$

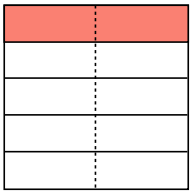

2) $\frac{1}{7}:3 =$

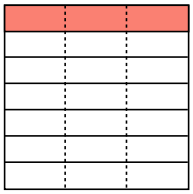

3) $\frac{1}{6}:7 =$

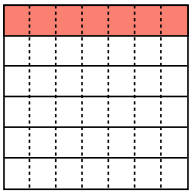

4) $\frac{1}{3}:4 =$

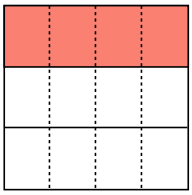

5) $\frac{1}{2}:6 =$

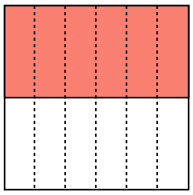

6) $\frac{1}{5}:4 =$

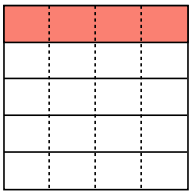

7) $\frac{1}{9}:8 =$

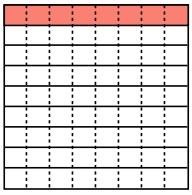

8) $\frac{1}{9}:7 =$

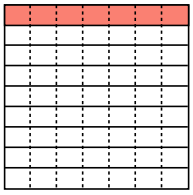

9) $\frac{1}{2}:9 =$

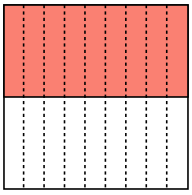

10) $\frac{1}{2}:3 =$

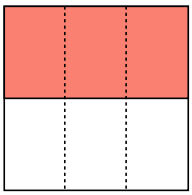

11) $\frac{1}{8}:3 =$

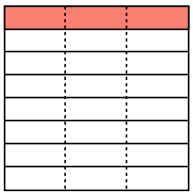

12) $\frac{1}{9}:3 =$

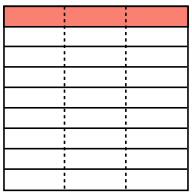

Risposte

1. $\frac{1}{10}$
2. $\frac{1}{21}$
3. $\frac{1}{42}$
4. $\frac{1}{12}$
5. $\frac{1}{12}$
6. $\frac{1}{20}$
7. $\frac{1}{72}$
8. $\frac{1}{63}$
9. $\frac{1}{18}$
10. $\frac{1}{6}$
11. $\frac{1}{24}$
12. $\frac{1}{27}$

1-10	92	83	75	67	58	50	42	33	25	17
11-12	8	0								