Divisioni tra frazioni con la linea numerata Nome:

Usa la linea numerata per risolvere ogni problema.

1) $4 : \frac{1}{5}$

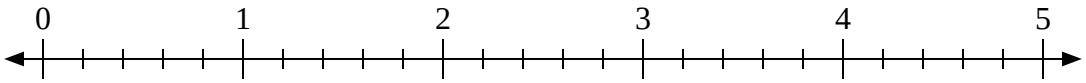

2) $2 : \frac{2}{3}$

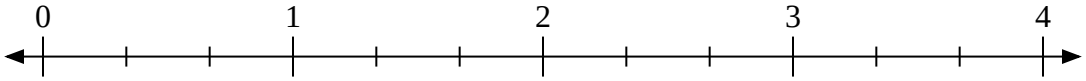

3) $2 : \frac{6}{7}$

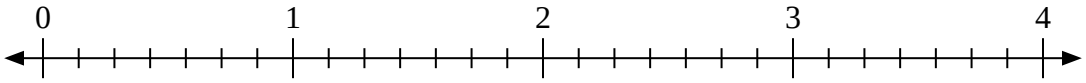

4) $5 : \frac{6}{9}$

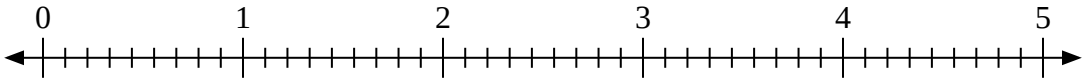

5) $3 : \frac{4}{5}$

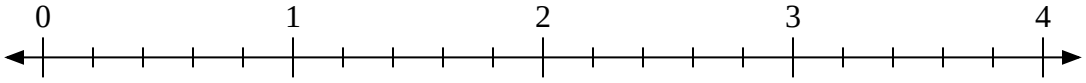

6) $4 : \frac{1}{3}$

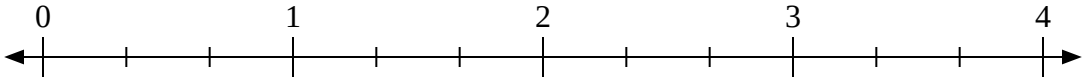

7) $3 : \frac{6}{9}$

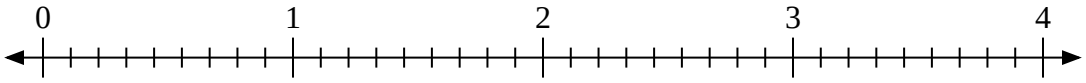

8) $3 : \frac{4}{9}$

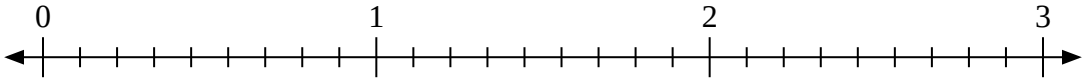

9) $3 : \frac{2}{9}$

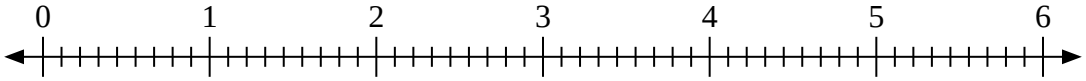

Risposte

1. _____
2. _____
3. _____
4. _____
5. _____
6. _____
7. _____
8. _____
9. _____

1-9	89	78	67	56	44	33	22	11	0

Divisioni tra frazioni con la linea numerata Nome: **Soluzioni**

Usa la linea numerata per risolvere ogni problema.

1) $4 : \frac{1}{5}$

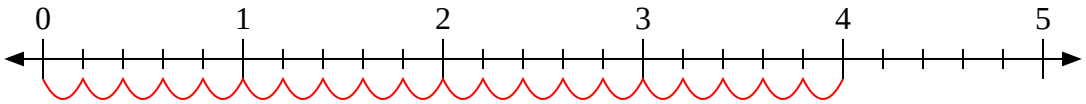

2) $2 : \frac{2}{3}$

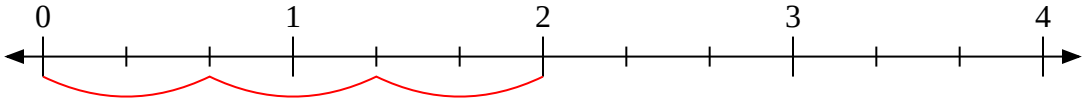

3) $2 : \frac{6}{7}$

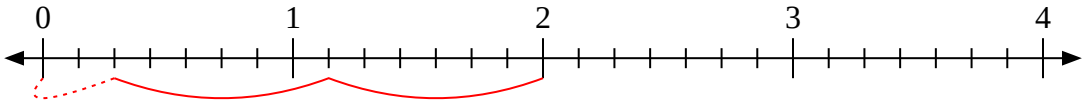

4) $5 : \frac{6}{9}$

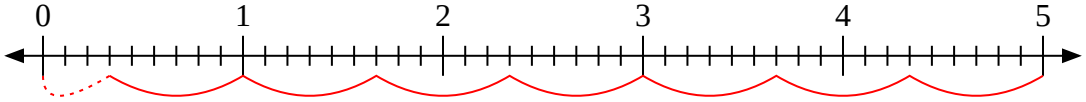

5) $3 : \frac{4}{5}$

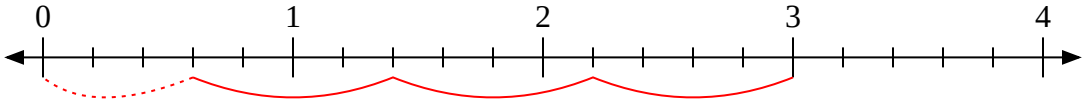

6) $4 : \frac{1}{3}$

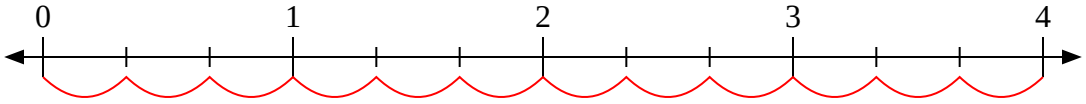

7) $3 : \frac{6}{9}$

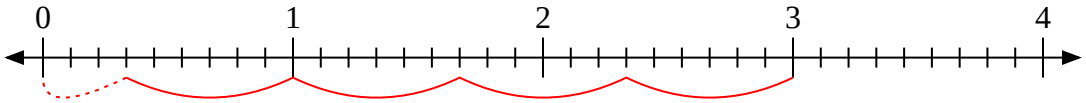

8) $3 : \frac{4}{9}$

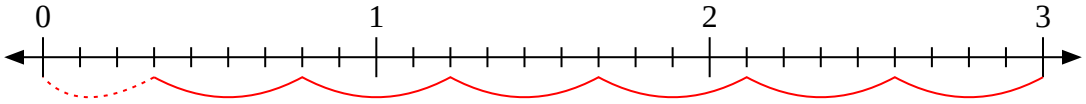

9) $3 : \frac{2}{9}$

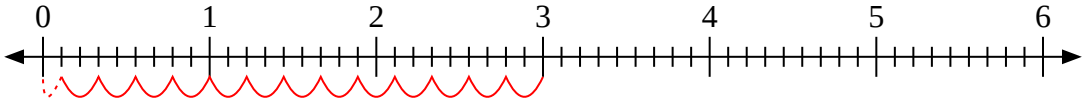

Risposte

1. **20**
2. **3**
3. **$2\frac{2}{6}$**
4. **$7\frac{3}{6}$**
5. **$3\frac{3}{4}$**
6. **12**
7. **$4\frac{3}{6}$**
8. **$6\frac{3}{4}$**
9. **$13\frac{1}{2}$**