# Divisioni con la linea numerata

Nome:

**Usa la linea numerata per resolvere ogni problema.**

**1)** 27:9=

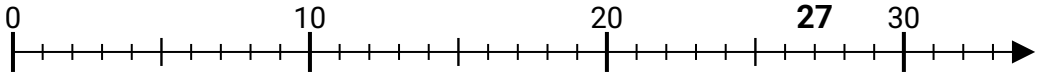


**2)** 28:7=

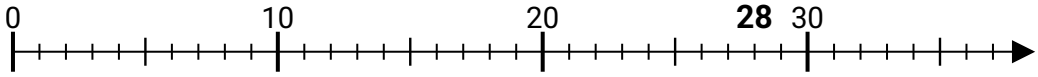


**3)** 9:3=

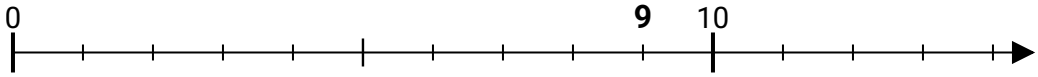


**4)** 20:4=

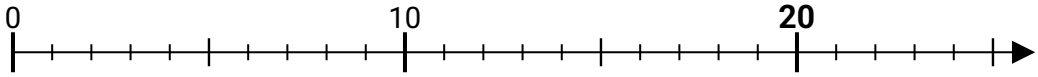


**5)** 14:7=

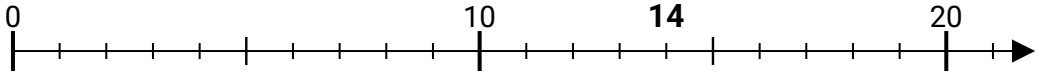


**6)** 15:3=

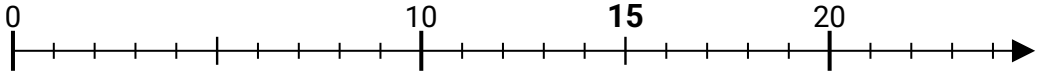


**7)** 30:6=

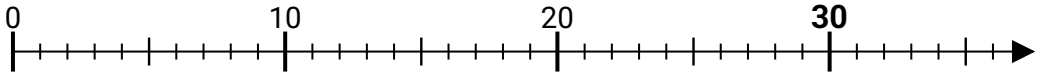


**8)** 20:5=

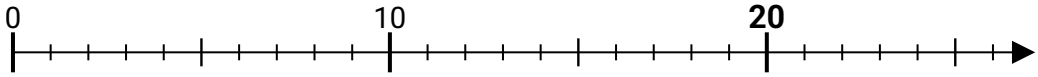


**9)** 25:5=

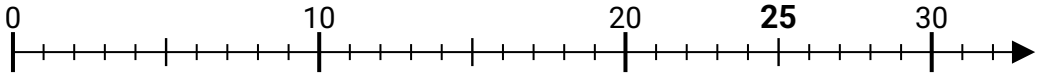


**10)** 18:9=

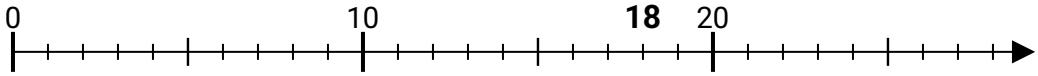


**11)** 50:10=

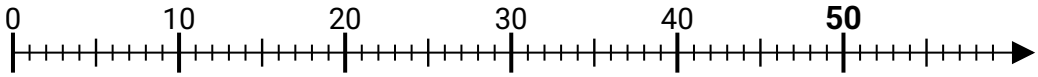


## Risposte

1. _____
2. _____
3. _____
4. _____
5. _____
6. _____
7. _____
8. _____
9. _____
10. _____
11. _____

Divisioni con la linea numerata

Nome: **Soluzioni**

**Usa la linea numerata per risolvere ogni problema.**

**1)** 27:9=

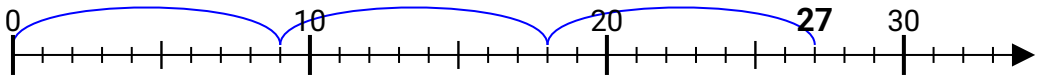


**2)** 28:7=

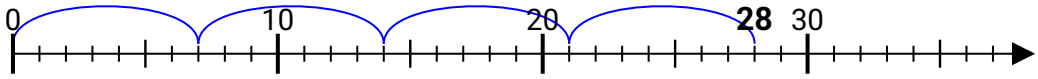


**3)** 9:3=

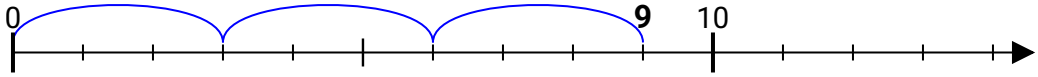


**4)** 20:4=

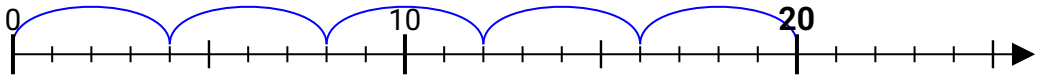


**5)** 14:7=

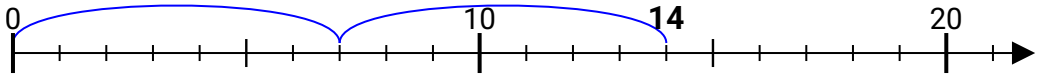


**6)** 15:3=

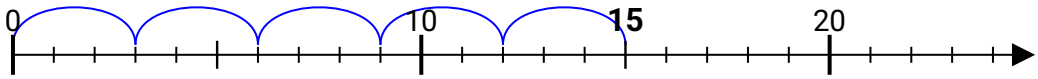


**7)** 30:6=

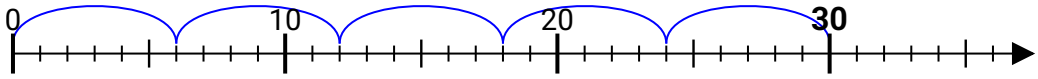


**8)** 20:5=

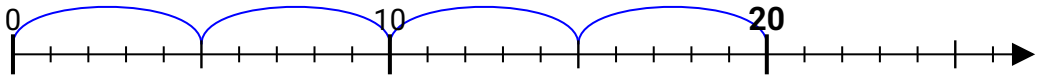


**9)** 25:5=

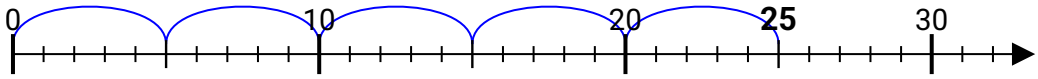


**10)** 18:9=

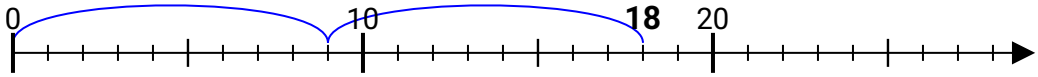


**11)** 50:10=

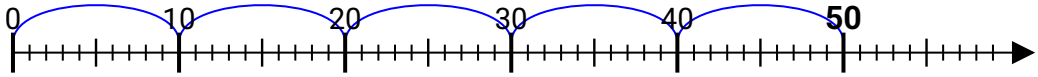


**Risposte**

1. 3
2. 4
3. 3
4. 5
5. 2
6. 5
7. 5
8. 4
9. 5
10. 2
11. 5