Moltiplicare i decimali (Visivamente) Nome:

Metti in ordine i seguenti schemi dal più piccolo al più grande, in base alle parti colorate

Es) A B C D

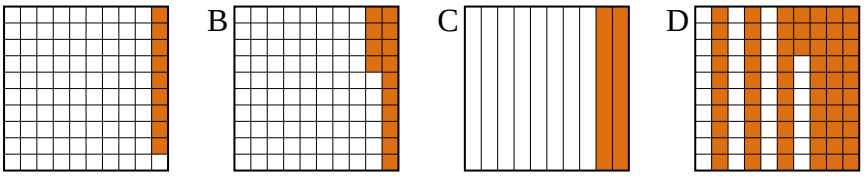

piccolo 0.09 - A
0.14 - B
0.2 - C
grande 0.63 - D

1) A B C D

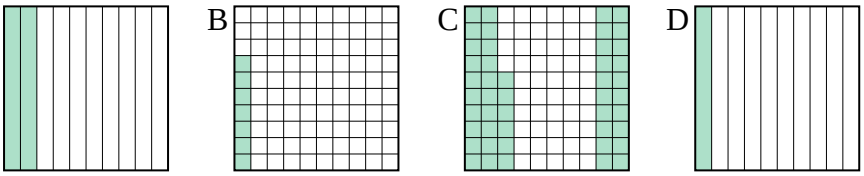

piccolo _____
_____
_____
grande _____

2) A B C D

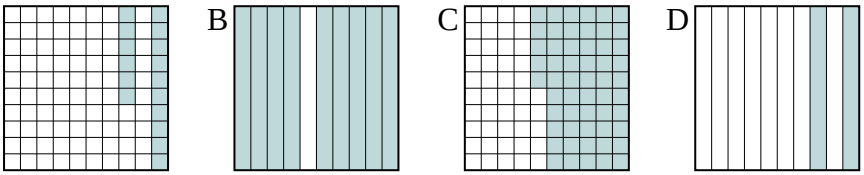

piccolo _____
_____
_____
grande _____

3) A B C D

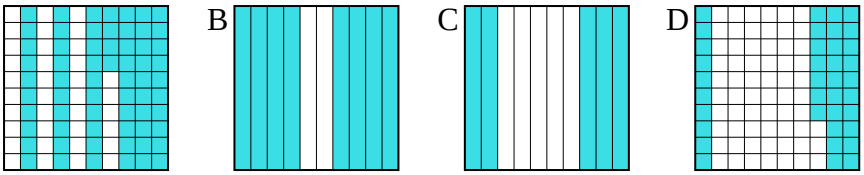

piccolo _____
_____
_____
grande _____

4) A B C D

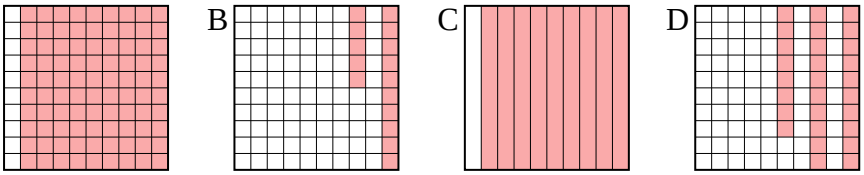

piccolo _____
_____
_____
grande _____

5) A B C D

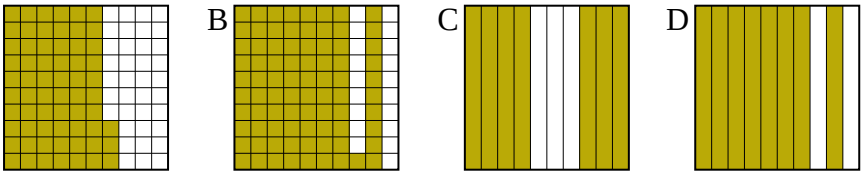

piccolo _____
_____
_____
grande _____

6) A B C D

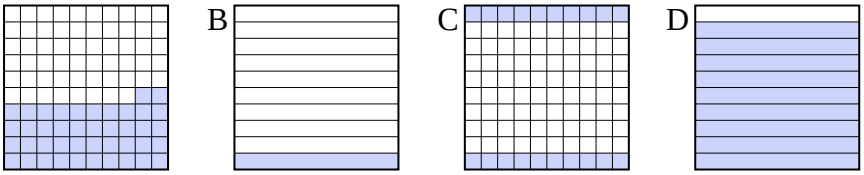

piccolo _____
_____
_____
grande _____

7) A B C D

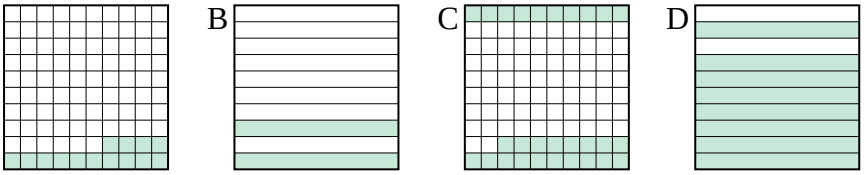

piccolo _____
_____
_____
grande _____

8) A B C D

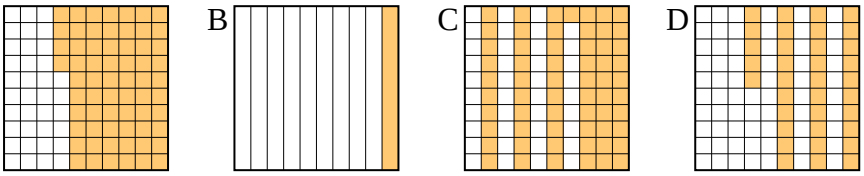

piccolo _____
_____
_____
grande _____

Risposte

Es. **A,B,C,D**

1. _____
2. _____
3. _____
4. _____
5. _____
6. _____
7. _____
8. _____

1-8	88	75	63	50	38	25	13	0

Moltiplicare i decimali (Visivamente) Nome: **Soluzioni**

Metti in ordine i seguenti schemi dal più piccolo al più grande, in base alle parti colorate

Es)

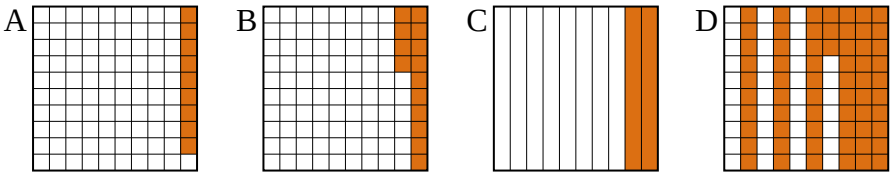

piccolo 0.09 - A
0.14 - B
0.2 - C
grande 0.63 - D

1)

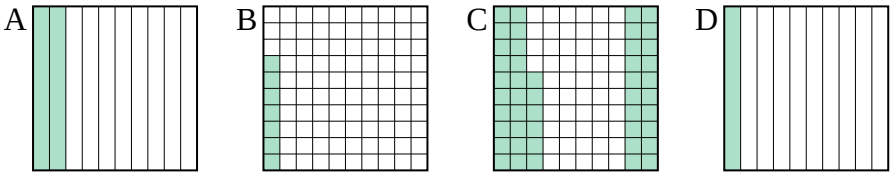

piccolo 0.07 - B
0.1 - D
0.2 - A
grande 0.46 - C

2)

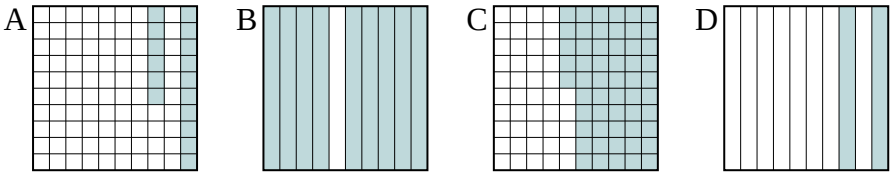

piccolo 0.16 - A
0.2 - D
0.55 - C
grande 0.9 - B

3)

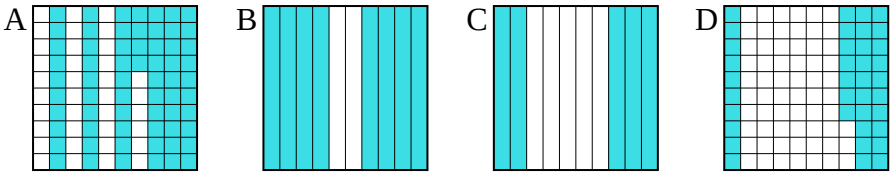

piccolo 0.37 - D
0.5 - C
0.64 - A
grande 0.8 - B

4)

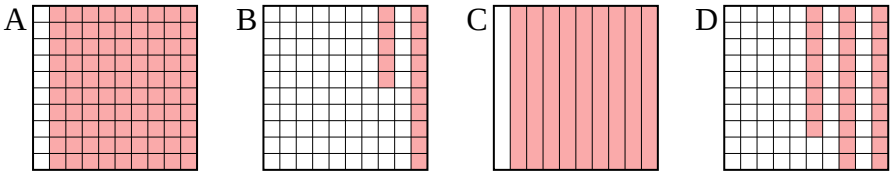

piccolo 0.15 - B
0.28 - D
0.9 - A
grande 0.9 - A

5)

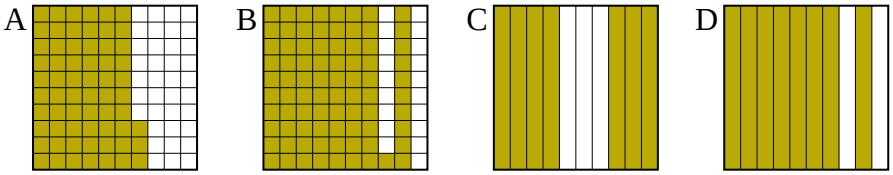

piccolo 0.63 - A
0.7 - C
0.8 - D
grande 0.81 - B

6)

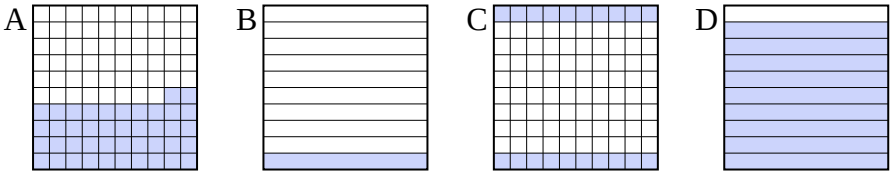

piccolo 0.1 - B
0.2 - C
0.42 - A
grande 0.9 - D

7)

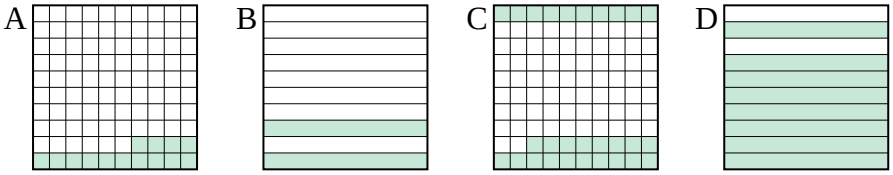

piccolo 0.14 - A
0.2 - B
0.28 - C
grande 0.8 - D

8)

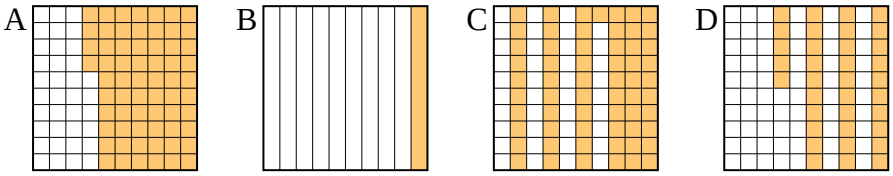

piccolo 0.1 - B
0.35 - D
0.61 - C
grande 0.64 - A

Risposte

Es.	A,B,C,D
1.	B,D,A,C
2.	A,D,C,B
3.	D,C,A,B
4.	B,D,A,A
5.	A,C,D,B
6.	B,C,A,D
7.	A,B,C,D
8.	B,D,C,A

1-8	88	75	63	50	38	25	13	0