Moltiplicare i decimali (Visivamente)

Nome:

Usa il modello visivo per risolvere ogni problema.

1) 0,6 × 0,9 =

2) 0,6 × 0,3 =

3) 0,5 × 0,9 =

4) 0,1 × 0,7 =

5) 0,5 × 0,2 =

6) 0,1 × 0,5 =

7) 0,1 × 0,4 =

8) 0,6 × 0,4 =

9) 0,4 × 0,4 =

10) 0,8 × 0,8 =

11) 0,7 × 0,2 =

12) 0,9 × 0,4 =

13) 0,2 × 0,9 =

14) 0,6 × 0,6 =

15) 0,5 × 0,4 =

Risposte

1. _____
2. _____
3. _____
4. _____
5. _____
6. _____
7. _____
8. _____
9. _____
10. _____
11. _____
12. _____
13. _____
14. _____
15. _____

1-10	93	87	80	73	67	60	53	47	40	33
11-15	27	20	13	7	0					

Moltiplicare i decimali (Visivamente) Nome: **Soluzioni**

Usa il modello visivo per risolvere ogni problema.

1) 0,6 × 0,9 =

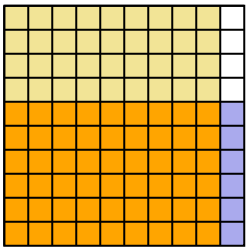

2) 0,6 × 0,3 =

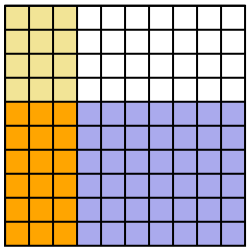

3) 0,5 × 0,9 =

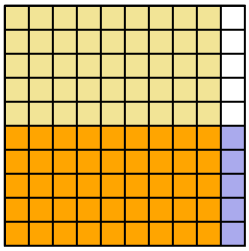

4) 0,1 × 0,7 =

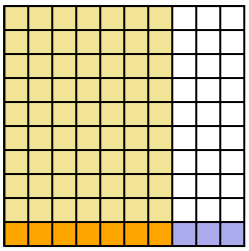

5) 0,5 × 0,2 =

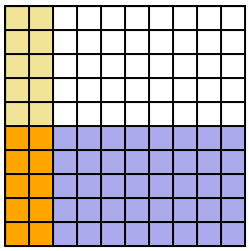

6) 0,1 × 0,5 =

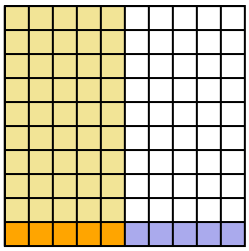

7) 0,1 × 0,4 =

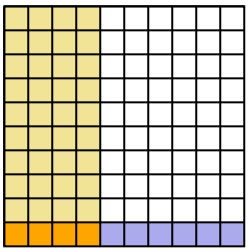

8) 0,6 × 0,4 =

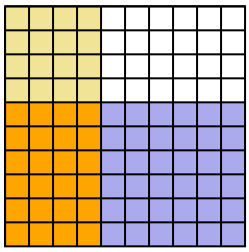

9) 0,4 × 0,4 =

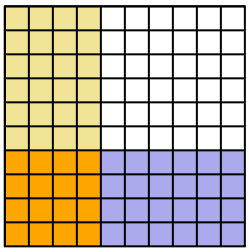

10) 0,8 × 0,8 =

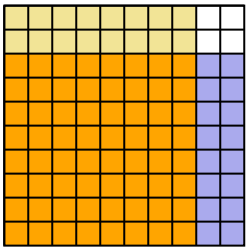

11) 0,7 × 0,2 =

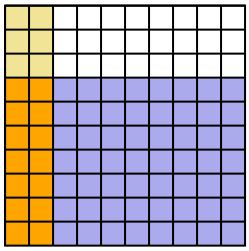

12) 0,9 × 0,4 =

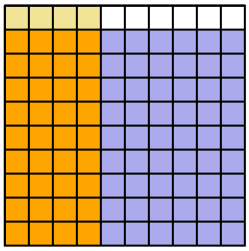

13) 0,2 × 0,9 =

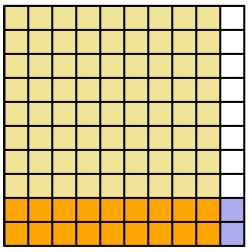

14) 0,6 × 0,6 =

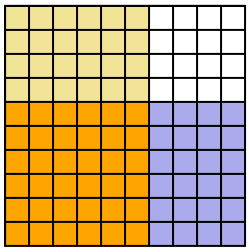

15) 0,5 × 0,4 =

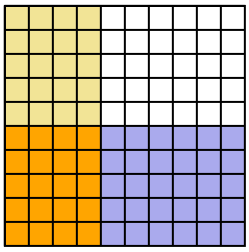

Risposte

1. $^{54}/_{100}$ = 0,54
2. $^{18}/_{100}$ = 0,18
3. $^{45}/_{100}$ = 0,45
4. $^{7}/_{100}$ = 0,07
5. $^{10}/_{100}$ = 0,1
6. $^{5}/_{100}$ = 0,05
7. $^{4}/_{100}$ = 0,04
8. $^{24}/_{100}$ = 0,24
9. $^{16}/_{100}$ = 0,16
10. $^{64}/_{100}$ = 0,64
11. $^{14}/_{100}$ = 0,14
12. $^{36}/_{100}$ = 0,36
13. $^{18}/_{100}$ = 0,18
14. $^{36}/_{100}$ = 0,36
15. $^{20}/_{100}$ = 0,2

1-10	93	87	80	73	67	60	53	47	40	33
11-15	27	20	13	7	0					