Determinazione del valore decimale con i blocchi Nome:

Usa il blocco a sinistra per trovare il valore dell'insieme di blocchi a destra.

1)  = 1 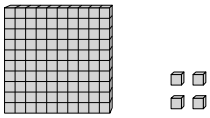

2)  = 1 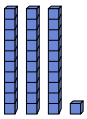

3) 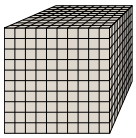 = 1 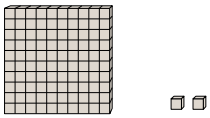

4) 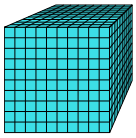 = 1 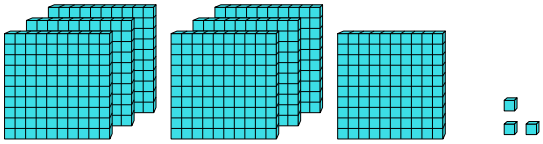

5) 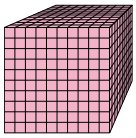 = 1 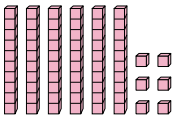

6) 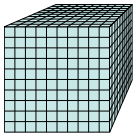 = 1 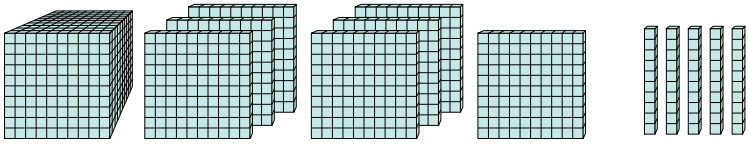

7) 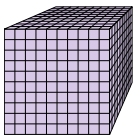 = 1 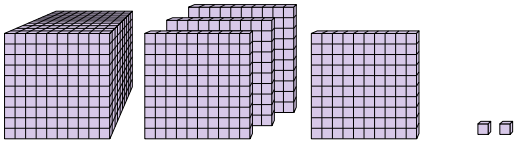

8)  = 1 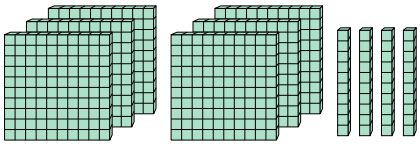

9) 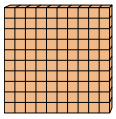 = 1 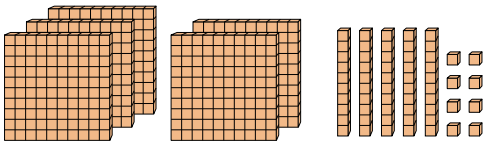

10) 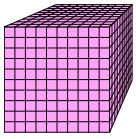 = 1 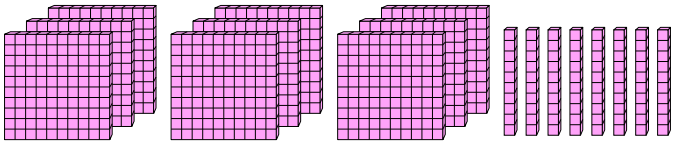

Risposte

1. _____
2. _____
3. _____
4. _____
5. _____
6. _____
7. _____
8. _____
9. _____
10. _____

1-10	90	80	70	60	50	40	30	20	10	0

Determinazione del valore decimale con i blocchi Nome: **Soluzioni**

Usa il blocco a sinistra per trovare il valore dell'insieme di blocchi a destra.

1)  = 1 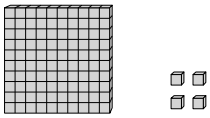

2)  = 1 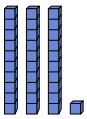

3) 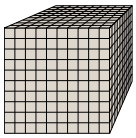 = 1 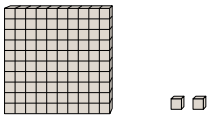

4) 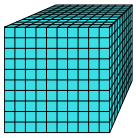 = 1 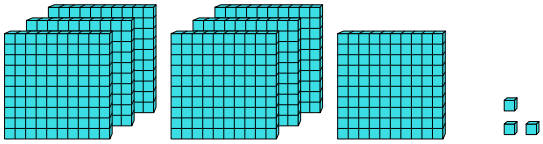

5) 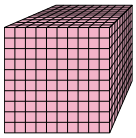 = 1 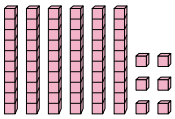

6) 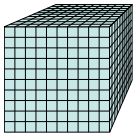 = 1 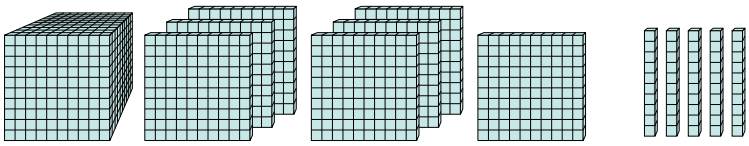

7) 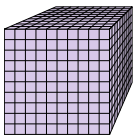 = 1 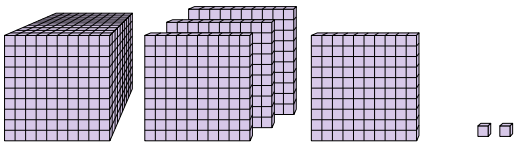

8)  = 1 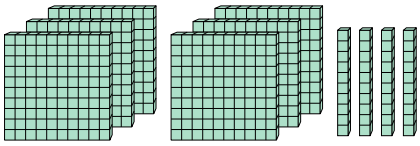

9) 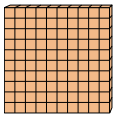 = 1 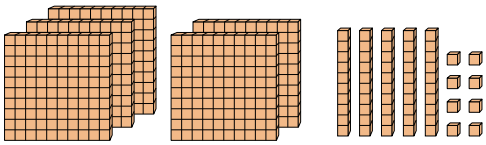

10) 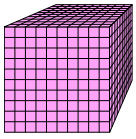 = 1 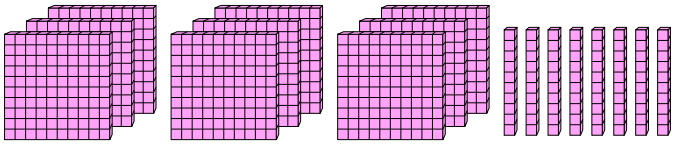

Risposte

1. **1,04**
2. **0,031**
3. **0,102**
4. **0,703**
5. **0,066**
6. **1,75**
7. **1,402**
8. **6,4**
9. **5,58**
10. **0,98**

1-10	90	80	70	60	50	40	30	20	10	0