Aggiunta di decimali con una linea numerica Nome:

Usa la linea dei numeri per risolvere ogni problema.

1) 6.1 + 1.7 =

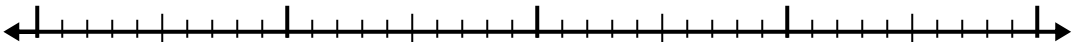

2) 2.8 + 1.3 =

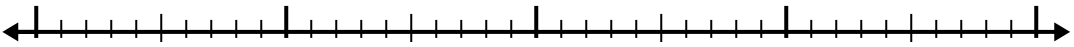

3) 5.6 + 1.3 =

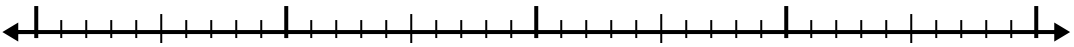

4) 7.5 + 3.7 =

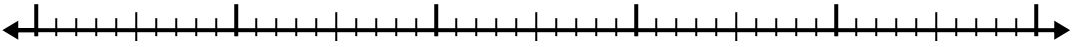

5) 7.8 + 2.9 =

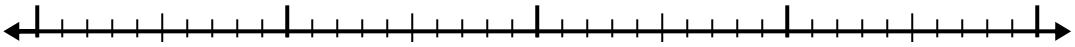

6) 3.4 + 2.5 =

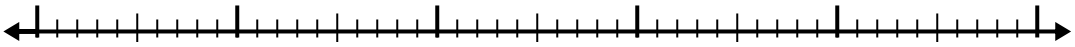

7) 6.7 + 2.7 =

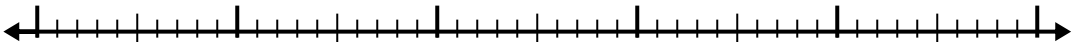

8) 2.1 + 3.3 =

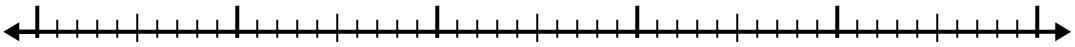

9) 1 + 1.7 =

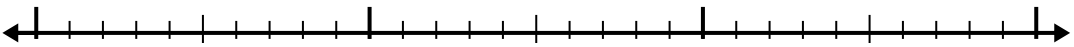

10) 3 + 3.1 =

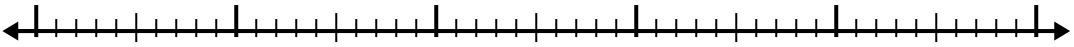

Risposte

1. _____
2. _____
3. _____
4. _____
5. _____
6. _____
7. _____
8. _____
9. _____
10. _____

1-10	90	80	70	60	50	40	30	20	10	0

Aggiunta di decimali con una linea numerica Nome: **Soluzioni**

Usa la linea dei numeri per risolvere ogni problema.

1) 6.1 + 1.7 =

2) 2.8 + 1.3 =

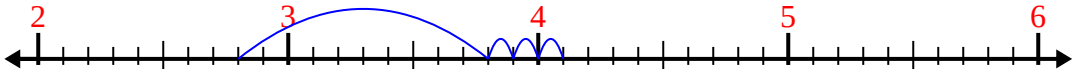

3) 5.6 + 1.3 =

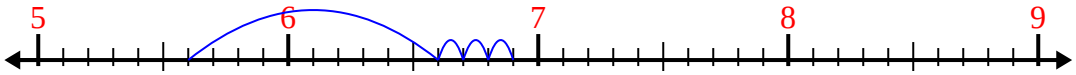

4) 7.5 + 3.7 =

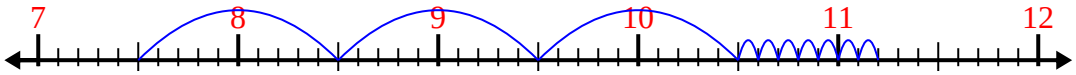

5) 7.8 + 2.9 =

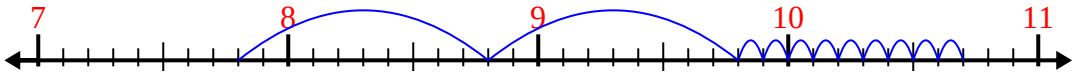

6) 3.4 + 2.5 =

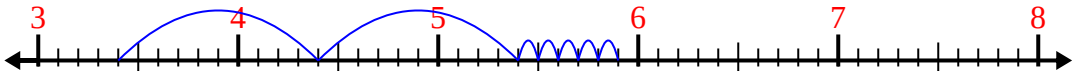

7) 6.7 + 2.7 =

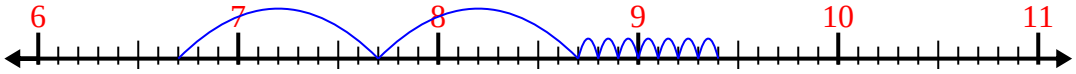

8) 2.1 + 3.3 =

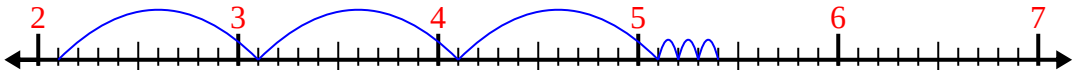

9) 1 + 1.7 =

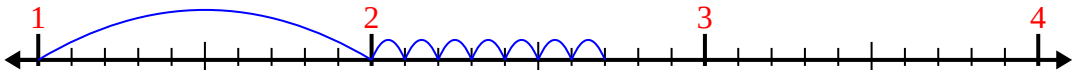

10) 3 + 3.1 =

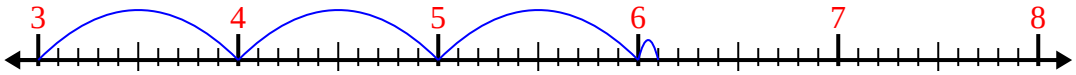

Risposte

1. **7,8**
2. **4,1**
3. **6,9**
4. **11,2**
5. **10,7**
6. **5,9**
7. **9,4**
8. **5,4**
9. **2,7**
10. **6,1**

1-10	90	80	70	60	50	40	30	20	10	0