Trovare larghezza, altezza e area di rettangoli di scala

Nome:

Determinare la larghezza, l'altezza e l'area effettive di ciascun rettangolo di scala. Arrotonda l'area al numero intero più vicino.

1)

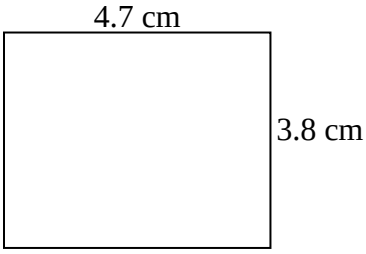

1 cm = 8 ft

2)

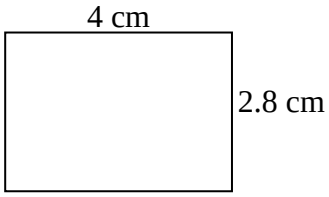

1 cm = 10 ft

3)

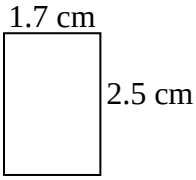

1 cm = 4 ft

4)

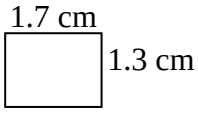

1 cm = 8 ft

5)

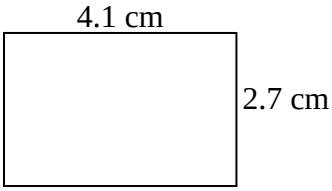

1 cm = 6 ft

6)

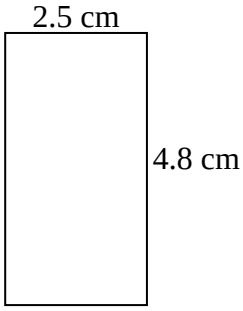

1 cm = 4 ft

7)

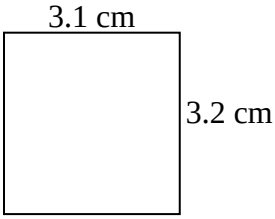

1 cm = 7 ft

8)

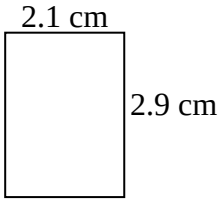

1 cm = 10 ft

Risposte

1. _____ _____ _____
2. _____ _____ _____
3. _____ _____ _____
4. _____ _____ _____
5. _____ _____ _____
6. _____ _____ _____
7. _____ _____ _____
8. _____ _____ _____

Trovare larghezza, altezza e area di rettangoli di scala Nome: **Soluzioni**

Determinare la larghezza, l'altezza e l'area effettive di ciascun rettangolo di scala. Arrotonda l'area al numero intero più vicino.

1)

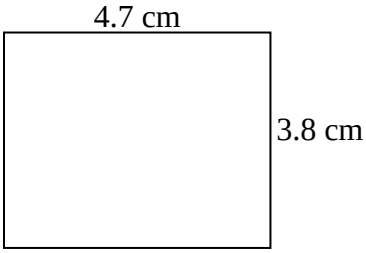

1 cm = 8 ft

2)

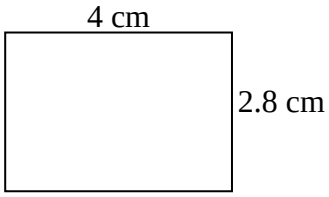

1 cm = 10 ft

3)

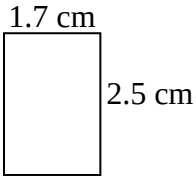

1 cm = 4 ft

4)

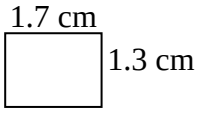

1 cm = 8 ft

5)

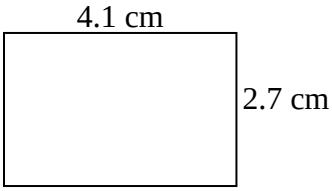

1 cm = 6 ft

6)

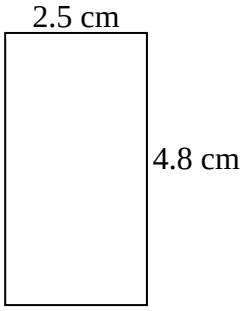

1 cm = 4 ft

7)

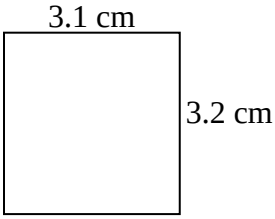

1 cm = 7 ft

8)

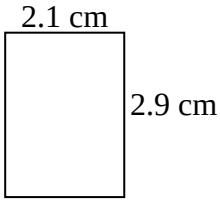

1 cm = 10 ft

Risposte

1.	37.6	30.4	1.143
2.	40	28	1.120
3.	6.8	10	68
4.	13.6	10.4	141
5.	24.6	16.2	399
6.	10	19.2	192
7.	21.7	22.4	486
8.	21	29	609