Trova l'area

Nome:

Trova l'area dei seguenti rettangoli.

1)

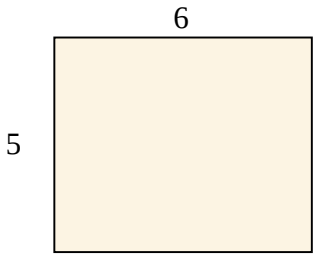

2)

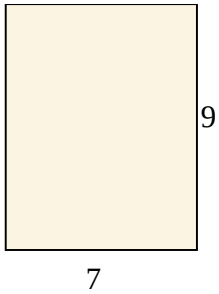

3)

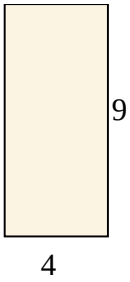

4)

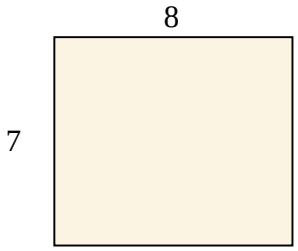

5)

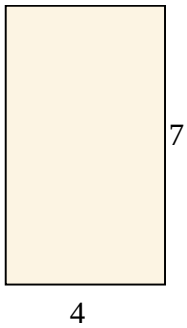

6)

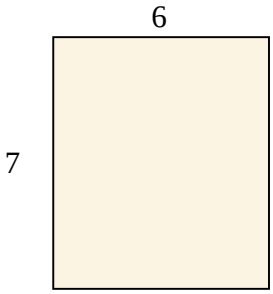

7)

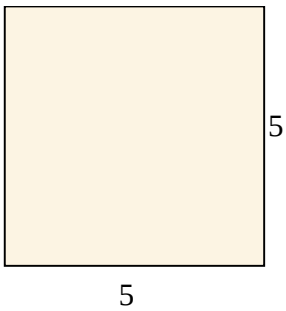

8)

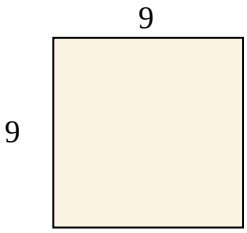

9)

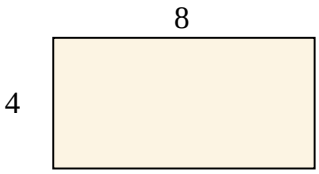

10)

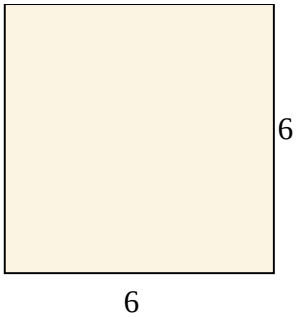

11)

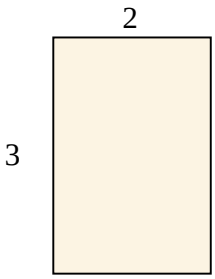

12)

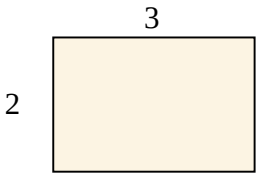

Risposte

1. _____
2. _____
3. _____
4. _____
5. _____
6. _____
7. _____
8. _____
9. _____
10. _____
11. _____
12. _____

1-10	92	83	75	67	58	50	42	33	25	17
11-12	8	0								

Trova l'area

Nome: **Soluzioni**

Trova l'area dei seguenti rettangoli.

1)

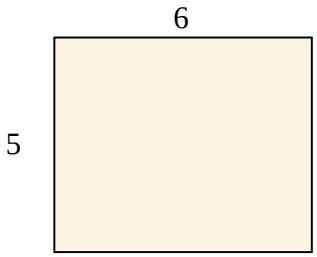

2)

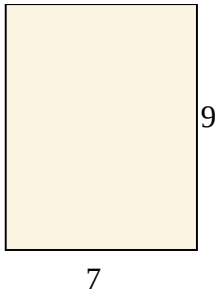

3)

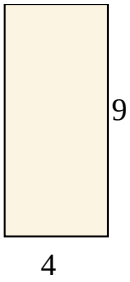

4)

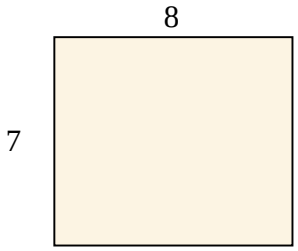

5)

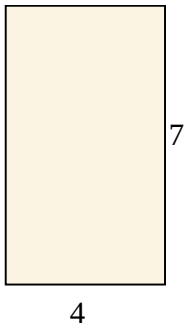

6)

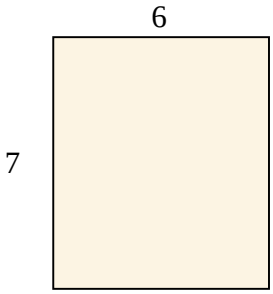

7)

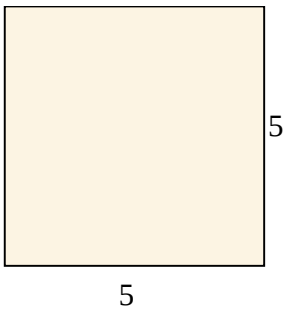

8)

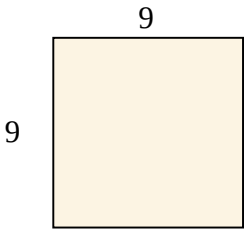

9)

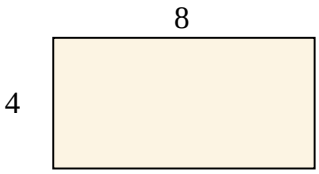

10)

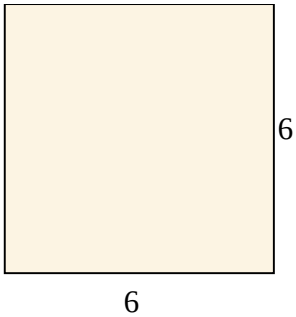

11)

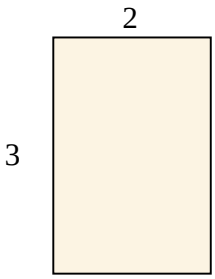

12)

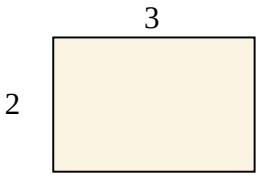

Risposte

1. **30**
2. **63**
3. **36**
4. **56**
5. **28**
6. **42**
7. **25**
8. **81**
9. **32**
10. **36**
11. **6**
12. **6**

1-10	92	83	75	67	58	50	42	33	25	17
11-12	8	0								