Creazione di rettangoli di area e perimetro Nome:

**Utilizzare i diagrammi seguenti per creare un rettangolo con l'area/perimetro mostrato. Ogni SVGREPLACE = 1 unità(u). Rispondi con la lunghezza e l'altezza. Le risposte varieranno.**

**1)** Area di 36 unità quadrate.



**2)** Perimetro di 38 unità.



**3)** Area di 7 unità quadrate.



**4)** Area di 16 unità quadrate.



**5)** Perimetro di 28 unità.



**6)** Perimetro di 40 unità.



**7)** Perimetro di 22 unità.



**8)** Area di 21 unità quadrate.



**9)** Area di 12 unità quadrate.



**10)** Area di 3 unità quadrate.



**11)** Area di 9 unità quadrate.



**12)** Perimetro di 18 unità.



## Risposte

1. ___ ___ $=36u^2$
2. ___ ___ $=38u$
3. ___ ___ $=7u^2$
4. ___ ___ $=16u^2$
5. ___ ___ $=28u$
6. ___ ___ $=40u$
7. ___ ___ $=22u$
8. ___ ___ $=21u^2$
9. ___ ___ $=12u^2$
10. ___ ___ $=3u^2$
11. ___ ___ $=9u^2$
12. ___ ___ $=18u$



| | | | | | | | | | | |
|---|---|---|---|---|---|---|---|---|---|---|
| 1-10 | 92 | 83 | 75 | 67 | 58 | 50 | 42 | 33 | 25 | 17 |
| 11-12 | 8 | 0 | | | | | | | | |

Creazione di rettangoli di area e perimetro Nome: **Soluzioni**

**Utilizzare i diagrammi seguenti per creare un rettangolo con l'area/perimetro mostrato. Ogni SVGREPLACE = 1 unità(u). Rispondi con la lunghezza e l'altezza. Le risposte varieranno.**

**1)** Area di 36 unità quadrate.



**2)** Perimetro di 38 unità.



**3)** Area di 7 unità quadrate.



**4)** Area di 16 unità quadrate.



**5)** Perimetro di 28 unità.



**6)** Perimetro di 40 unità.



**7)** Perimetro di 22 unità.



**8)** Area di 21 unità quadrate.



**9)** Area di 12 unità quadrate.



**10)** Area di 3 unità quadrate.



**11)** Area di 9 unità quadrate.



**12)** Perimetro di 18 unità.



## Risposte

1. ___ ___ $=36u^2$
2. ___ ___ $=38u$
3. ___ ___ $=7u^2$
4. ___ ___ $=16u^2$
5. ___ ___ $=28u$
6. ___ ___ $=40u$
7. ___ ___ $=22u$
8. ___ ___ $=21u^2$
9. ___ ___ $=12u^2$
10. ___ ___ $=3u^2$
11. ___ ___ $=9u^2$
12. ___ ___ $=18u$



| | | | | | | | | | | |
|---|---|---|---|---|---|---|---|---|---|---|
| 1-10 | 92 | 83 | 75 | 67 | 58 | 50 | 42 | 33 | 25 | 17 |
| 11-12 | 8 | 0 | | | | | | | | |